Visual Place Value (Less than 20) Name:

**Fill in the blanks to find the amounts.**

**Ex)**

0 4

tens ones

**1)**

tens ones

**2)**

tens ones

**3)**

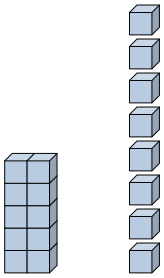

tens ones

**4)**

tens ones

**5)**

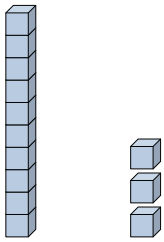

tens ones

**6)**

tens ones

**7)**

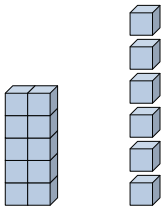

tens ones

**8)**

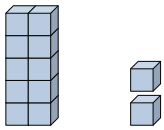

tens ones

**9)**

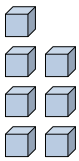

tens ones

**10)**

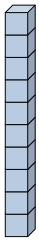

tens ones

**11)**

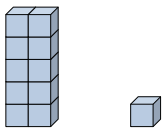

tens ones

## Answers

Ex. 4

1. _____
2. _____
3. _____
4. _____
5. _____
6. _____
7. _____
8. _____
9. _____
10. _____
11. _____



| | | | | | | | | | | |
|---|---|---|---|---|---|---|---|---|---|---|
| 1-10 | 91 | 82 | 73 | 64 | 55 | 45 | 36 | 27 | 18 | 9 |
| 11 | 0 | | | | | | | | | |

Visual Place Value (Less than 20) Name: **Answer Key**

**Fill in the blanks to find the amounts.**

**Ex)**

0 tens 4 ones

**1)**

0 tens 2 ones

**2)**

0 tens 1 ones

**3)**

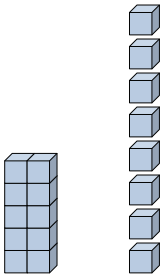

1 tens 8 ones

**4)**

0 tens 9 ones

**5)**

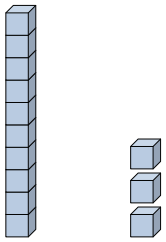

1 tens 3 ones

**6)**

0 tens 3 ones

**7)**

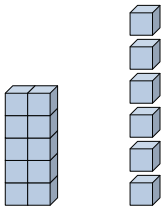

1 tens 6 ones

**8)**

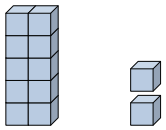

1 tens 2 ones

**9)**

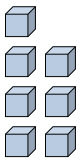

0 tens 7 ones

**10)**

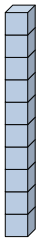

1 tens 0 ones

**11)**

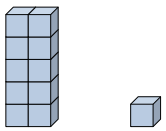

1 tens 1 ones

## Answers

Ex. 4

1. 2
2. 1
3. 18
4. 9
5. 13
6. 3
7. 16
8. 12
9. 7
10. 10
11. 11



| | | | | | | | | | | |
|---|---|---|---|---|---|---|---|---|---|---|
| 1-10 | 91 | 82 | 73 | 64 | 55 | 45 | 36 | 27 | 18 | 9 |
| 11 | 0 | | | | | | | | | |