Determining Value with Blocks Name:

Find the value each set of blocks represents.

1) 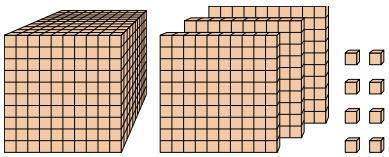

2) 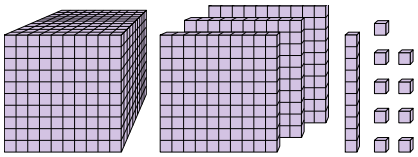

3) 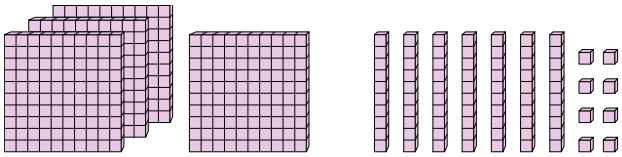

4) 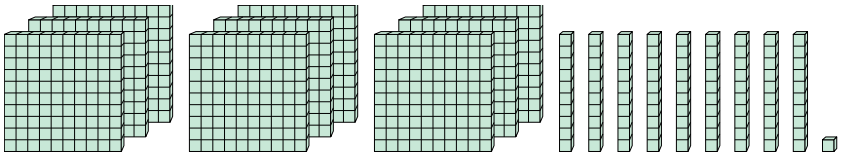

5) 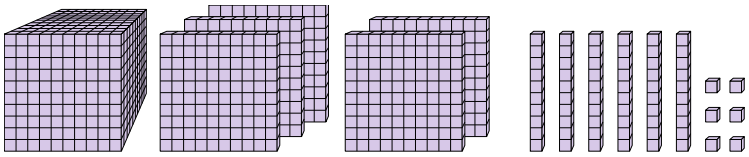

6) 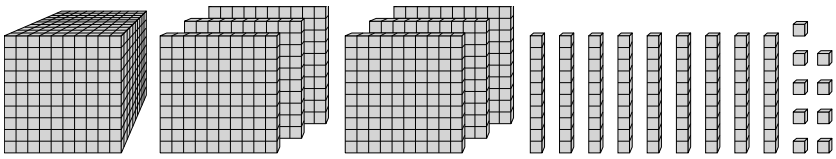

7) 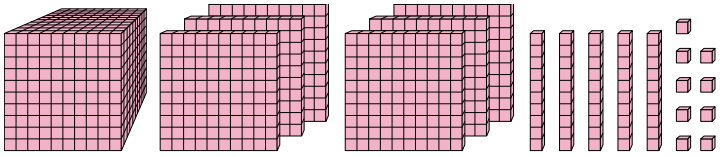

8) 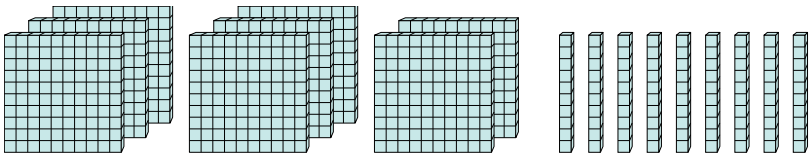

9) 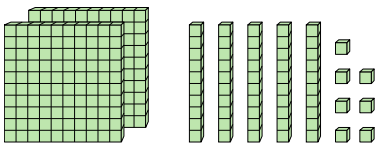

10) 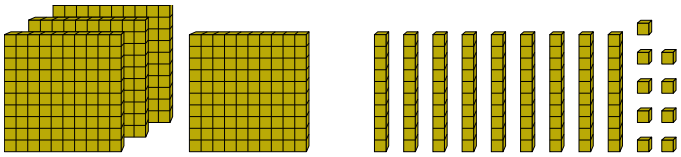

Answers

1. _____
2. _____
3. _____
4. _____
5. _____
6. _____
7. _____
8. _____
9. _____
10. _____

1-10	90	80	70	60	50	40	30	20	10	0

Determining Value with Blocks

Name: **Answer Key**

Find the value each set of blocks represents.

1) 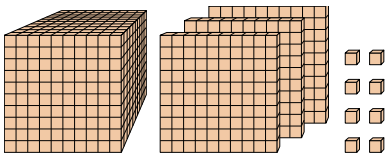

2) 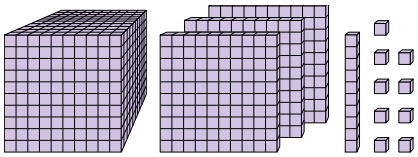

3) 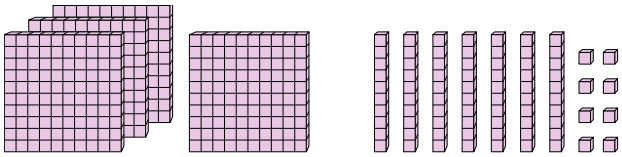

4) 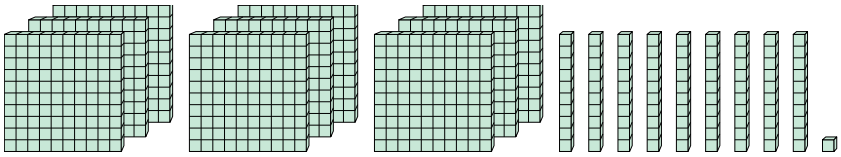

5) 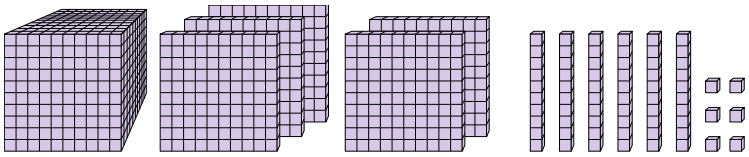

6) 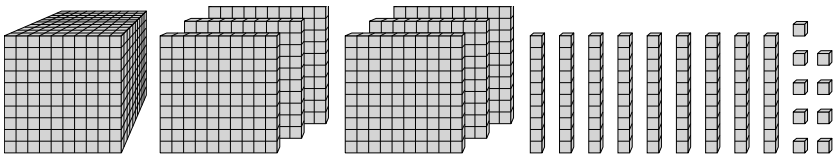

7) 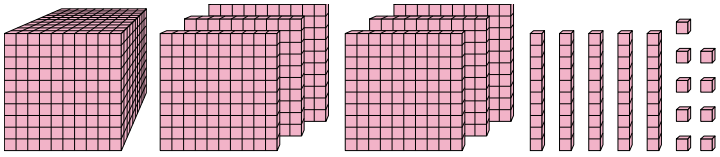

8) 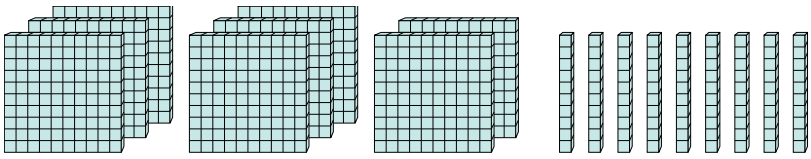

9) 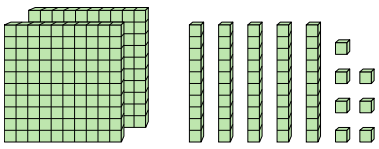

10) 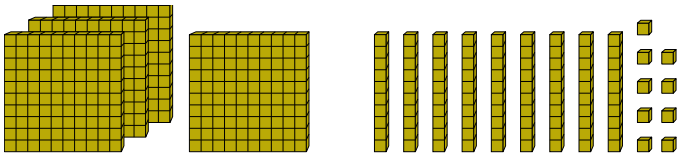

Answers

1. **1,308**
2. **1,319**
3. **478**
4. **991**
5. **1,566**
6. **1,699**
7. **1,659**
8. **890**
9. **257**
10. **499**

1-10	90	80	70	60	50	40	30	20	10	0