Find the length of the side listed.

1) Find the length of side B.

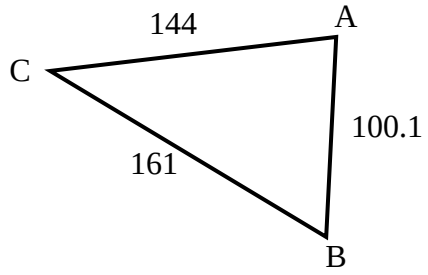

2) Find the length of side C.

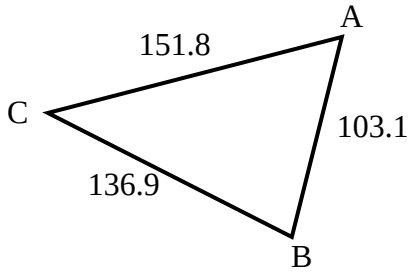

3) Find the length of side B.

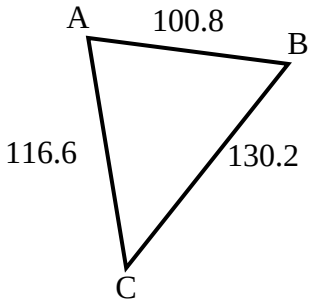

4) Find the length of side C.

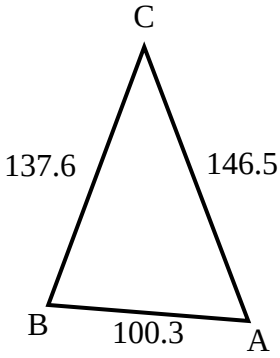

5) Find the length of side C.

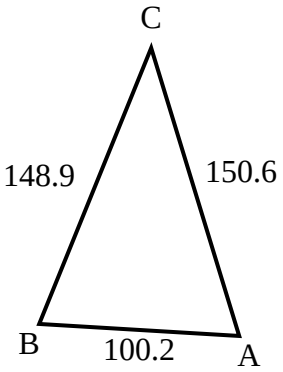

6) Find the length of side A.

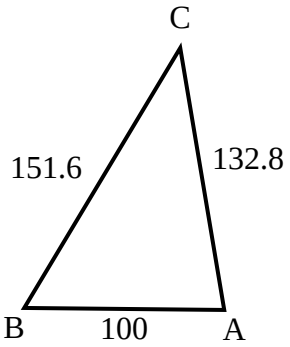

7) Find the length of side B.

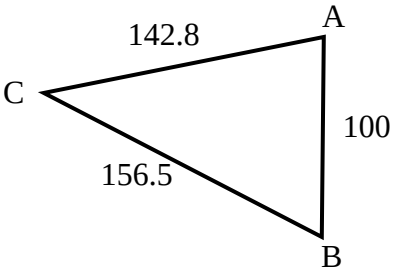

8) Find the length of side B.

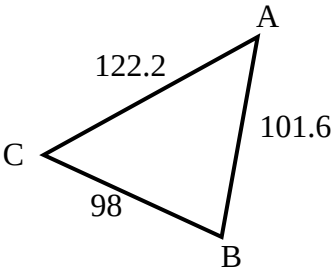

Answers

1. _____
2. _____
3. _____
4. _____
5. _____
6. _____
7. _____
8. _____

1-8	88	75	63	50	38	25	13	0

Identifying Triangle Sides

Name: **Answer Key**

Find the length of the side listed.

1) Find the length of side B.

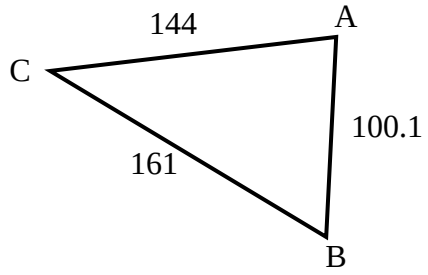

2) Find the length of side C.

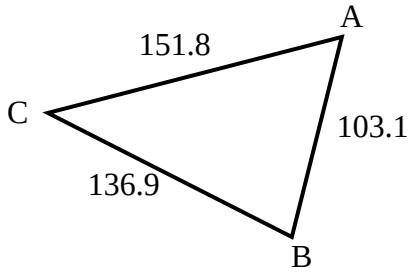

3) Find the length of side B.

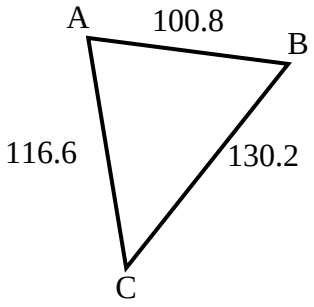

4) Find the length of side C.

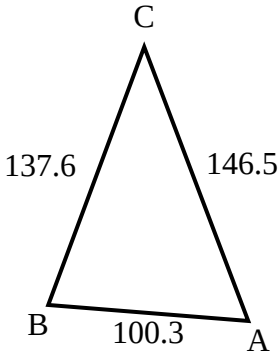

5) Find the length of side C.

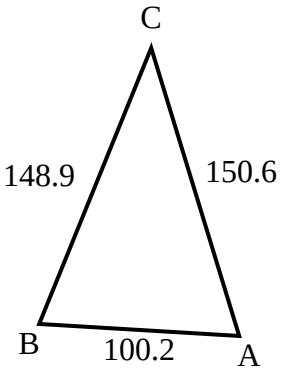

6) Find the length of side A.

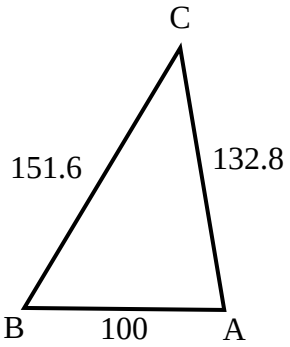

7) Find the length of side B.

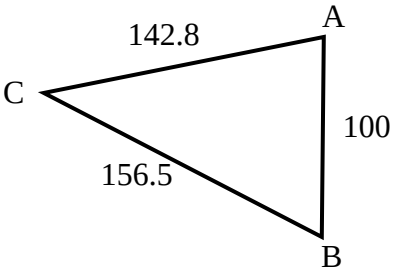

8) Find the length of side B.

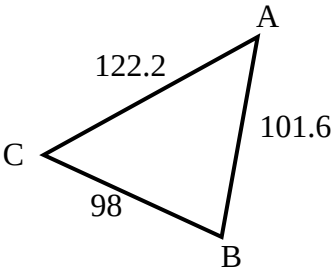

Answers

1. 144
2. 103.1
3. 116.6
4. 100.3
5. 100.2
6. 151.6
7. 142.8
8. 122.2

1-8	88	75	63	50	38	25	13	0