Finding Ending Time with a Numberline

Name:

Solve each problem.

1) Start: 2:15
Elapsed: 1 hr & 40 mins
End: _____

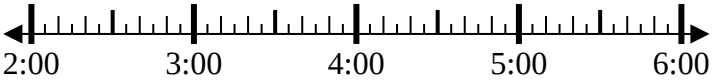

2) Start: 2:10
Elapsed: 2 hrs & 45 mins
End: _____

3) Start: 2:45
Elapsed: 2 hrs & 10 mins
End: _____

4) Start: 2:20
Elapsed: 1 hr & 20 mins
End: _____

5) Start: 11:05
Elapsed: 2 hrs & 25 mins
End: _____

6) Start: 11:05
Elapsed: 2 hrs & 20 mins
End: _____

7) Start: 3:45
Elapsed: 2 hrs & 20 mins
End: _____

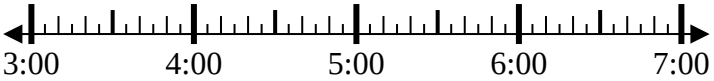

8) Start: 6:20
Elapsed: 1 hr & 30 mins
End: _____

Answers

1. _____
2. _____
3. _____
4. _____
5. _____
6. _____
7. _____
8. _____

1-8	88	75	63	50	38	25	13	0

Finding Ending Time with a Numberline

Name: **Answer Key**

Solve each problem.

1) Start: 2:15
Elapsed: 1 hr & 40 mins
End: 3:55

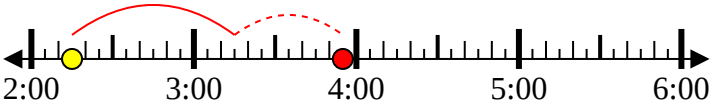

2) Start: 2:10
Elapsed: 2 hrs & 45 mins
End: 4:55

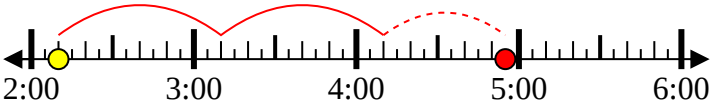

3) Start: 2:45
Elapsed: 2 hrs & 10 mins
End: 4:55

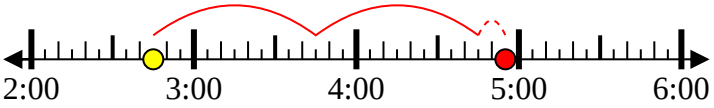

4) Start: 2:20
Elapsed: 1 hr & 20 mins
End: 3:40

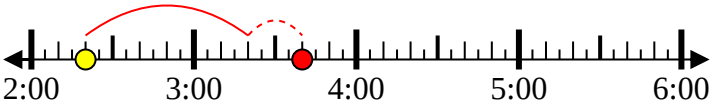

5) Start: 11:05
Elapsed: 2 hrs & 25 mins
End: 1:30

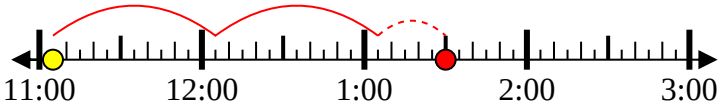

6) Start: 11:05
Elapsed: 2 hrs & 20 mins
End: 1:25

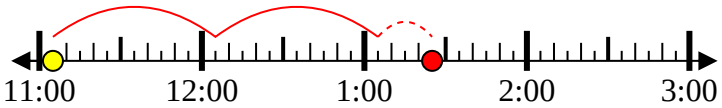

7) Start: 3:45
Elapsed: 2 hrs & 20 mins
End: 6:05

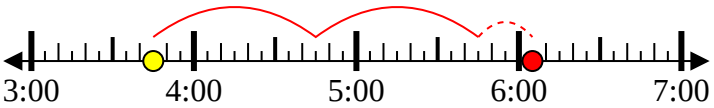

8) Start: 6:20
Elapsed: 1 hr & 30 mins
End: 7:50

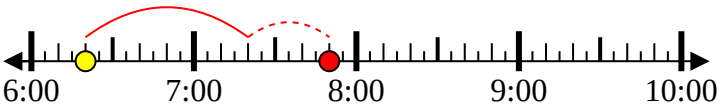

Answers

1. 3:55
2. 4:55
3. 4:55
4. 3:40
5. 1:30
6. 1:25
7. 6:05
8. 7:50

1-8	88	75	63	50	38	25	13	0

Finding Ending Time with a Numberline

Name:

Solve each problem.

1) Start: 6:45
Elapsed: 1 hr & 10 mins
End: _____

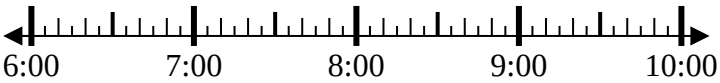

2) Start: 6:25
Elapsed: 2 hrs & 40 mins
End: _____

3) Start: 1:10
Elapsed: 1 hr & 50 mins
End: _____

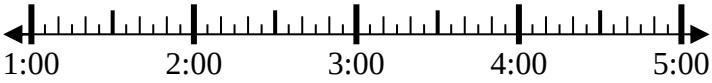

4) Start: 11:15
Elapsed: 1 hr & 45 mins
End: _____

5) Start: 3:25
Elapsed: 2 hrs & 10 mins
End: _____

6) Start: 3:20
Elapsed: 2 hrs & 35 mins
End: _____

7) Start: 10:35
Elapsed: 1 hr & 50 mins
End: _____

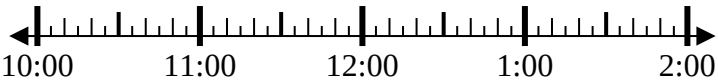

8) Start: 10:00
Elapsed: 1 hr & 30 mins
End: _____

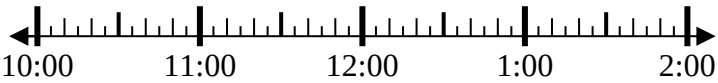

Answers

1. _____
2. _____
3. _____
4. _____
5. _____
6. _____
7. _____
8. _____

1-8	88	75	63	50	38	25	13	0

Finding Ending Time with a Numberline

Name: **Answer Key**

Solve each problem.

1) Start: 6:45
Elapsed: 1 hr & 10 mins
End: 7:55

2) Start: 6:25
Elapsed: 2 hrs & 40 mins
End: 9:05

3) Start: 1:10
Elapsed: 1 hr & 50 mins
End: 3:00

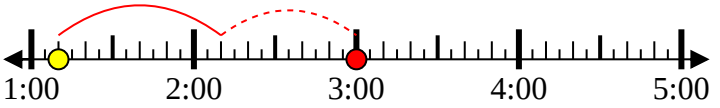

4) Start: 11:15
Elapsed: 1 hr & 45 mins
End: 1:00

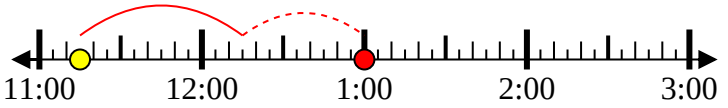

5) Start: 3:25
Elapsed: 2 hrs & 10 mins
End: 5:35

6) Start: 3:20
Elapsed: 2 hrs & 35 mins
End: 5:55

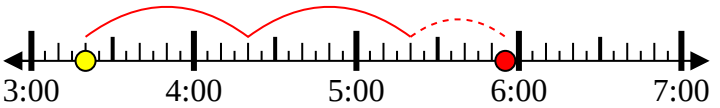

7) Start: 10:35
Elapsed: 1 hr & 50 mins
End: 12:25

8) Start: 10:00
Elapsed: 1 hr & 30 mins
End: 11:30

Answers

1. **7:55**
2. **9:05**
3. **3:00**
4. **1:00**
5. **5:35**
6. **5:55**
7. **12:25**
8. **11:30**

1-8	88	75	63	50	38	25	13	0

Finding Ending Time with a Numberline

Name:

Solve each problem.

1) Start: 2:00
Elapsed: 1 hr & 45 mins
End: _____

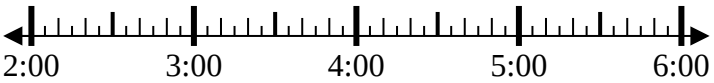

2) Start: 11:35
Elapsed: 2 hrs & 45 mins
End: _____

3) Start: 9:00
Elapsed: 1 hr & 10 mins
End: _____

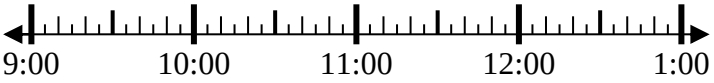

4) Start: 11:45
Elapsed: 1 hr & 20 mins
End: _____

5) Start: 12:20
Elapsed: 1 hr & 15 mins
End: _____

6) Start: 5:25
Elapsed: 1 hr & 10 mins
End: _____

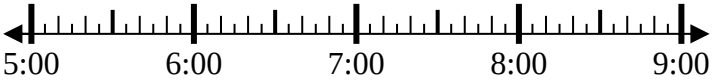

7) Start: 2:35
Elapsed: 1 hr & 45 mins
End: _____

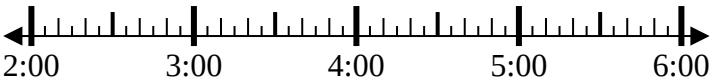

8) Start: 9:35
Elapsed: 2 hrs & 45 mins
End: _____

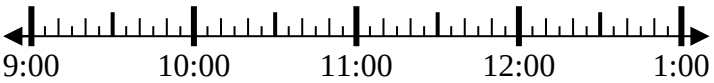

Answers

1. _____
2. _____
3. _____
4. _____
5. _____
6. _____
7. _____
8. _____

1-8	88	75	63	50	38	25	13	0

Finding Ending Time with a Numberline

Name: **Answer Key**

Solve each problem.

1) Start: 2:00
Elapsed: 1 hr & 45 mins
End: 3:45

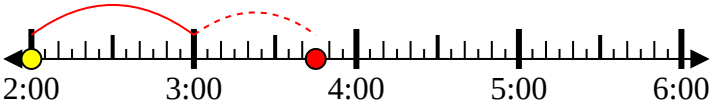

2) Start: 11:35
Elapsed: 2 hrs & 45 mins
End: 2:20

3) Start: 9:00
Elapsed: 1 hr & 10 mins
End: 10:10

4) Start: 11:45
Elapsed: 1 hr & 20 mins
End: 1:05

5) Start: 12:20
Elapsed: 1 hr & 15 mins
End: 1:35

6) Start: 5:25
Elapsed: 1 hr & 10 mins
End: 6:35

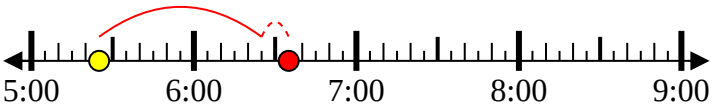

7) Start: 2:35
Elapsed: 1 hr & 45 mins
End: 4:20

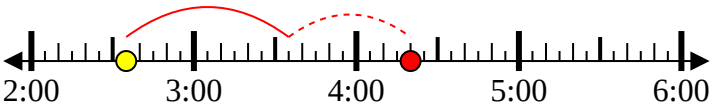

8) Start: 9:35
Elapsed: 2 hrs & 45 mins
End: 12:20

Answers

1. 3:45
2. 2:20
3. 10:10
4. 1:05
5. 1:35
6. 6:35
7. 4:20
8. 12:20

1-8	88	75	63	50	38	25	13	0

Finding Ending Time with a Numberline

Name:

Solve each problem.

1) Start: 2:50
Elapsed: 2 hrs & 50 mins
End: _____

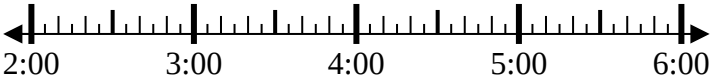

2) Start: 9:10
Elapsed: 1 hr & 10 mins
End: _____

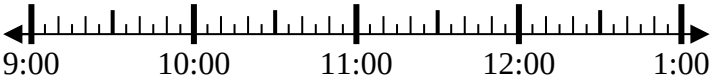

3) Start: 7:05
Elapsed: 1 hr & 15 mins
End: _____

4) Start: 3:00
Elapsed: 1 hr & 15 mins
End: _____

5) Start: 7:15
Elapsed: 1 hr & 40 mins
End: _____

6) Start: 5:00
Elapsed: 2 hrs & 15 mins
End: _____

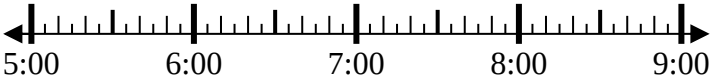

7) Start: 1:00
Elapsed: 2 hrs & 45 mins
End: _____

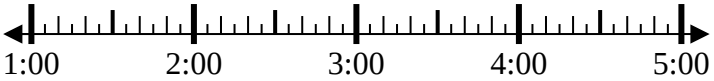

8) Start: 4:35
Elapsed: 1 hr & 20 mins
End: _____

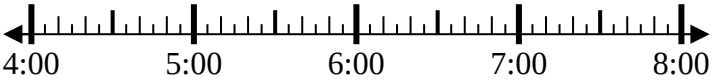

Answers

1. _____
2. _____
3. _____
4. _____
5. _____
6. _____
7. _____
8. _____

1-8	88	75	63	50	38	25	13	0

Finding Ending Time with a Numberline

Name: **Answer Key**

Solve each problem.

1) Start: 2:50
Elapsed: 2 hrs & 50 mins
End: 5:40

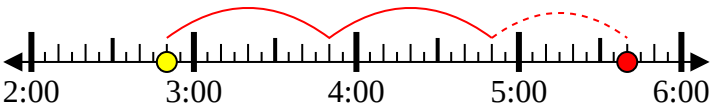

2) Start: 9:10
Elapsed: 1 hr & 10 mins
End: 10:20

3) Start: 7:05
Elapsed: 1 hr & 15 mins
End: 8:20

4) Start: 3:00
Elapsed: 1 hr & 15 mins
End: 4:15

5) Start: 7:15
Elapsed: 1 hr & 40 mins
End: 8:55

6) Start: 5:00
Elapsed: 2 hrs & 15 mins
End: 7:15

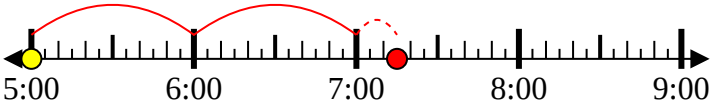

7) Start: 1:00
Elapsed: 2 hrs & 45 mins
End: 3:45

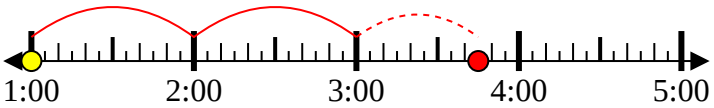

8) Start: 4:35
Elapsed: 1 hr & 20 mins
End: 5:55

Answers

1. 5:40
2. 10:20
3. 8:20
4. 4:15
5. 8:55
6. 7:15
7. 3:45
8. 5:55

1-8	88	75	63	50	38	25	13	0

Finding Ending Time with a Numberline

Name:

Solve each problem.

1) Start: 12:10
Elapsed: 1 hr & 25 mins
End: _____

2) Start: 6:40
Elapsed: 2 hrs & 10 mins
End: _____

3) Start: 9:05
Elapsed: 2 hrs & 50 mins
End: _____

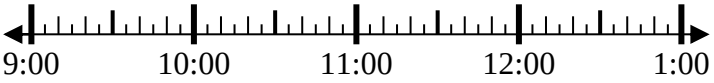

4) Start: 10:45
Elapsed: 2 hrs & 40 mins
End: _____

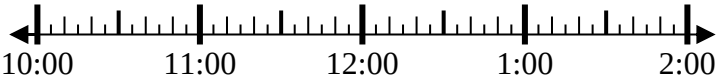

5) Start: 5:35
Elapsed: 1 hr & 30 mins
End: _____

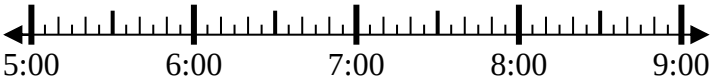

6) Start: 8:15
Elapsed: 2 hrs & 25 mins
End: _____

7) Start: 4:10
Elapsed: 2 hrs & 55 mins
End: _____

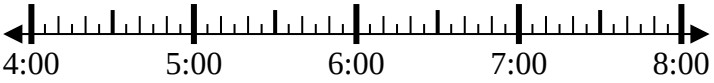

8) Start: 4:00
Elapsed: 2 hrs & 20 mins
End: _____

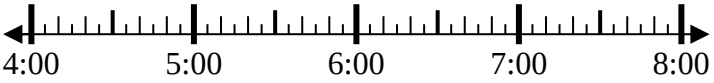

Answers

1. _____
2. _____
3. _____
4. _____
5. _____
6. _____
7. _____
8. _____

1-8	88	75	63	50	38	25	13	0

Finding Ending Time with a Numberline

Name: **Answer Key**

Solve each problem.

1) Start: 12:10
Elapsed: 1 hr & 25 mins
End: 1:35

2) Start: 6:40
Elapsed: 2 hrs & 10 mins
End: 8:50

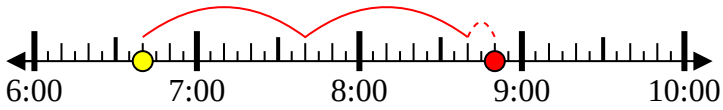

3) Start: 9:05
Elapsed: 2 hrs & 50 mins
End: 11:55

4) Start: 10:45
Elapsed: 2 hrs & 40 mins
End: 1:25

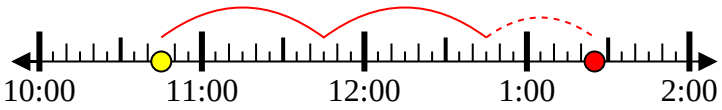

5) Start: 5:35
Elapsed: 1 hr & 30 mins
End: 7:05

6) Start: 8:15
Elapsed: 2 hrs & 25 mins
End: 10:40

7) Start: 4:10
Elapsed: 2 hrs & 55 mins
End: 7:05

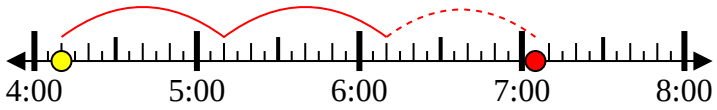

8) Start: 4:00
Elapsed: 2 hrs & 20 mins
End: 6:20

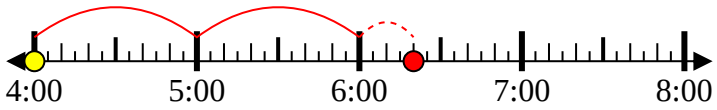

Answers

1. 1:35
2. 8:50
3. 11:55
4. 1:25
5. 7:05
6. 10:40
7. 7:05
8. 6:20

1-8	88	75	63	50	38	25	13	0

Finding Ending Time with a Numberline

Name:

Solve each problem.

1) Start: 9:35
Elapsed: 2 hrs & 30 mins
End: _____

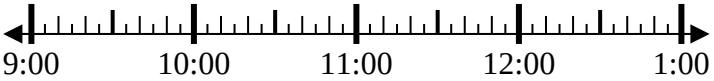

2) Start: 12:50
Elapsed: 1 hr & 45 mins
End: _____

3) Start: 10:15
Elapsed: 1 hr & 25 mins
End: _____

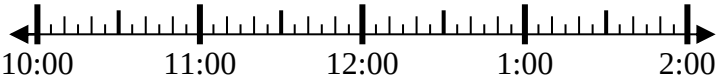

4) Start: 6:25
Elapsed: 1 hr & 45 mins
End: _____

5) Start: 9:10
Elapsed: 1 hr & 15 mins
End: _____

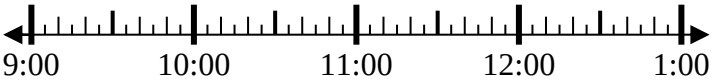

6) Start: 11:45
Elapsed: 2 hrs & 15 mins
End: _____

7) Start: 12:20
Elapsed: 1 hr & 40 mins
End: _____

8) Start: 3:35
Elapsed: 1 hr & 40 mins
End: _____

Answers

1. _____
2. _____
3. _____
4. _____
5. _____
6. _____
7. _____
8. _____

1-8	88	75	63	50	38	25	13	0

Finding Ending Time with a Numberline

Name: **Answer Key**

Solve each problem.

1) Start: 9:35
Elapsed: 2 hrs & 30 mins
End: 12:05

2) Start: 12:50
Elapsed: 1 hr & 45 mins
End: 2:35

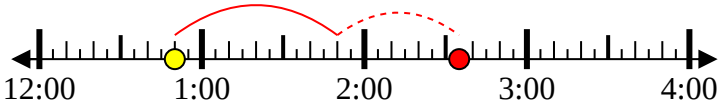

3) Start: 10:15
Elapsed: 1 hr & 25 mins
End: 11:40

4) Start: 6:25
Elapsed: 1 hr & 45 mins
End: 8:10

5) Start: 9:10
Elapsed: 1 hr & 15 mins
End: 10:25

6) Start: 11:45
Elapsed: 2 hrs & 15 mins
End: 2:00

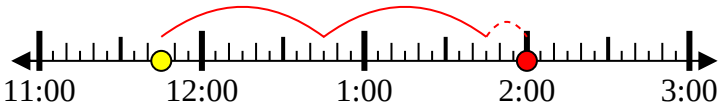

7) Start: 12:20
Elapsed: 1 hr & 40 mins
End: 2:00

8) Start: 3:35
Elapsed: 1 hr & 40 mins
End: 5:15

Answers

1. 12:05
2. 2:35
3. 11:40
4. 8:10
5. 10:25
6. 2:00
7. 2:00
8. 5:15

1-8	88	75	63	50	38	25	13	0

Finding Ending Time with a Numberline

Name:

Solve each problem.

1) Start: 7:05
Elapsed: 2 hrs & 20 mins
End: _____

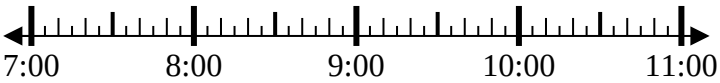

2) Start: 5:25
Elapsed: 2 hrs & 20 mins
End: _____

3) Start: 4:15
Elapsed: 1 hr & 35 mins
End: _____

4) Start: 12:05
Elapsed: 2 hrs & 40 mins
End: _____

5) Start: 10:05
Elapsed: 1 hr & 45 mins
End: _____

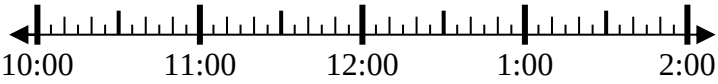

6) Start: 11:45
Elapsed: 2 hrs & 15 mins
End: _____

7) Start: 5:25
Elapsed: 1 hr & 40 mins
End: _____

8) Start: 1:25
Elapsed: 1 hr & 15 mins
End: _____

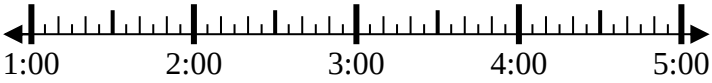

Answers

1. _____
2. _____
3. _____
4. _____
5. _____
6. _____
7. _____
8. _____

1-8	88	75	63	50	38	25	13	0

Finding Ending Time with a Numberline

Name: **Answer Key**

Solve each problem.

1) Start: 7:05
Elapsed: 2 hrs & 20 mins
End: 9:25

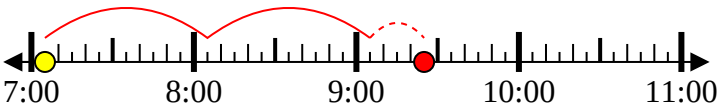

2) Start: 5:25
Elapsed: 2 hrs & 20 mins
End: 7:45

3) Start: 4:15
Elapsed: 1 hr & 35 mins
End: 5:50

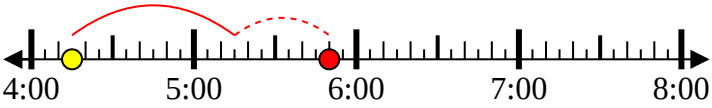

4) Start: 12:05
Elapsed: 2 hrs & 40 mins
End: 2:45

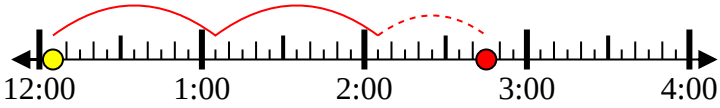

5) Start: 10:05
Elapsed: 1 hr & 45 mins
End: 11:50

6) Start: 11:45
Elapsed: 2 hrs & 15 mins
End: 2:00

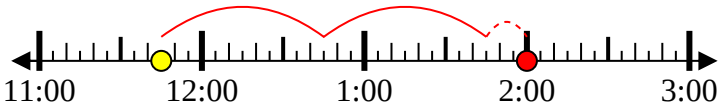

7) Start: 5:25
Elapsed: 1 hr & 40 mins
End: 7:05

8) Start: 1:25
Elapsed: 1 hr & 15 mins
End: 2:40

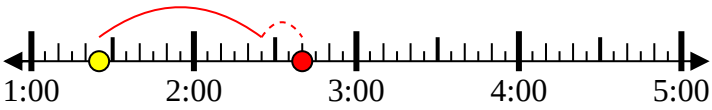

Answers

1. 9:25
2. 7:45
3. 5:50
4. 2:45
5. 11:50
6. 2:00
7. 7:05
8. 2:40

1-8	88	75	63	50	38	25	13	0

Finding Ending Time with a Numberline

Name:

Solve each problem.

1) Start: 12:15
Elapsed: 1 hr & 35 mins
End: _____

2) Start: 11:30
Elapsed: 1 hr & 25 mins
End: _____

3) Start: 5:10
Elapsed: 1 hr & 35 mins
End: _____

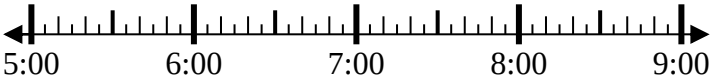

4) Start: 11:00
Elapsed: 1 hr & 10 mins
End: _____

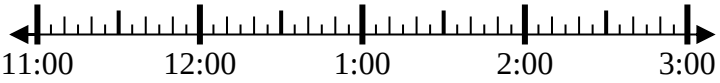

5) Start: 12:30
Elapsed: 1 hr & 10 mins
End: _____

6) Start: 12:40
Elapsed: 1 hr & 25 mins
End: _____

7) Start: 9:40
Elapsed: 1 hr & 50 mins
End: _____

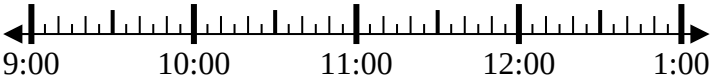

8) Start: 1:35
Elapsed: 2 hrs & 45 mins
End: _____

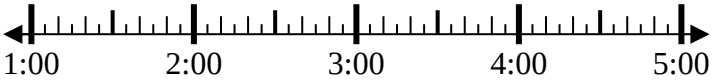

Answers

1. _____
2. _____
3. _____
4. _____
5. _____
6. _____
7. _____
8. _____

1-8	88	75	63	50	38	25	13	0

Finding Ending Time with a Numberline

Name: **Answer Key**

Solve each problem.

1) Start: 12:15
Elapsed: 1 hr & 35 mins
End: 1:50

2) Start: 11:30
Elapsed: 1 hr & 25 mins
End: 12:55

3) Start: 5:10
Elapsed: 1 hr & 35 mins
End: 6:45

4) Start: 11:00
Elapsed: 1 hr & 10 mins
End: 12:10

5) Start: 12:30
Elapsed: 1 hr & 10 mins
End: 1:40

6) Start: 12:40
Elapsed: 1 hr & 25 mins
End: 2:05

7) Start: 9:40
Elapsed: 1 hr & 50 mins
End: 11:30

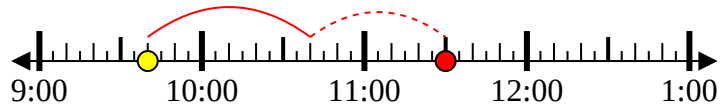

8) Start: 1:35
Elapsed: 2 hrs & 45 mins
End: 4:20

Answers

1. 1:50
2. 12:55
3. 6:45
4. 12:10
5. 1:40
6. 2:05
7. 11:30
8. 4:20

1-8	88	75	63	50	38	25	13	0

Finding Ending Time with a Numberline

Name:

Solve each problem.

1) Start: 10:50
Elapsed: 2 hrs & 30 mins
End: _____

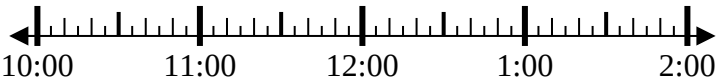

2) Start: 5:10
Elapsed: 1 hr & 25 mins
End: _____

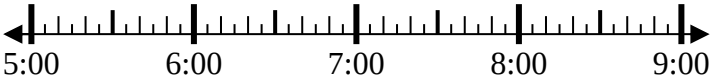

3) Start: 11:40
Elapsed: 1 hr & 35 mins
End: _____

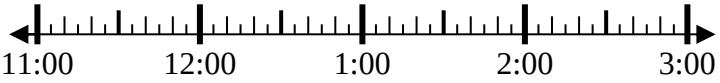

4) Start: 4:20
Elapsed: 2 hrs & 15 mins
End: _____

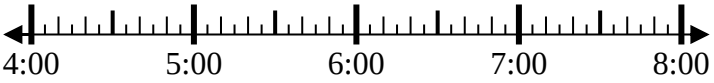

5) Start: 5:15
Elapsed: 2 hrs & 25 mins
End: _____

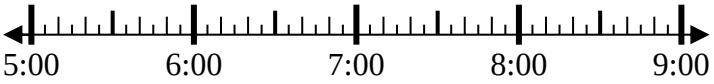

6) Start: 10:20
Elapsed: 2 hrs & 35 mins
End: _____

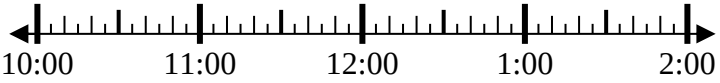

7) Start: 12:45
Elapsed: 2 hrs & 50 mins
End: _____

8) Start: 10:40
Elapsed: 1 hr & 30 mins
End: _____

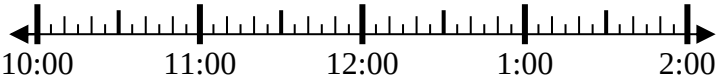

Answers

1. _____
2. _____
3. _____
4. _____
5. _____
6. _____
7. _____
8. _____

1-8	88	75	63	50	38	25	13	0

Finding Ending Time with a Numberline

Name: **Answer Key**

Solve each problem.

1) Start: 10:50
Elapsed: 2 hrs & 30 mins
End: 1:20

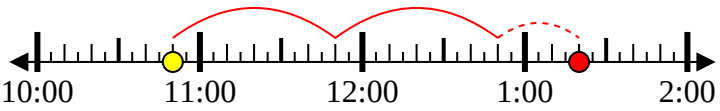

2) Start: 5:10
Elapsed: 1 hr & 25 mins
End: 6:35

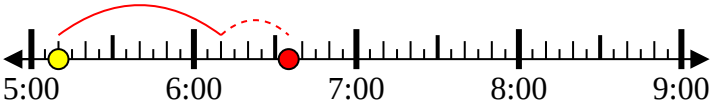

3) Start: 11:40
Elapsed: 1 hr & 35 mins
End: 1:15

4) Start: 4:20
Elapsed: 2 hrs & 15 mins
End: 6:35

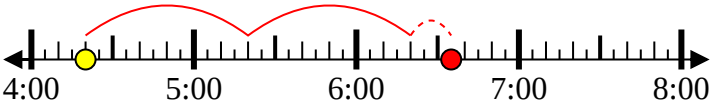

5) Start: 5:15
Elapsed: 2 hrs & 25 mins
End: 7:40

6) Start: 10:20
Elapsed: 2 hrs & 35 mins
End: 12:55

7) Start: 12:45
Elapsed: 2 hrs & 50 mins
End: 3:35

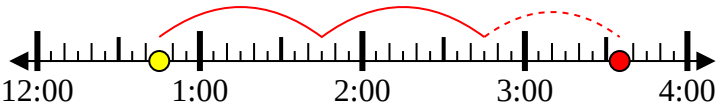

8) Start: 10:40
Elapsed: 1 hr & 30 mins
End: 12:10

Answers

1. **1:20**
2. **6:35**
3. **1:15**
4. **6:35**
5. **7:40**
6. **12:55**
7. **3:35**
8. **12:10**

1-8	88	75	63	50	38	25	13	0

Finding Ending Time with a Numberline

Name:

Solve each problem.

1) Start: 9:20
Elapsed: 1 hr & 25 mins
End: _____

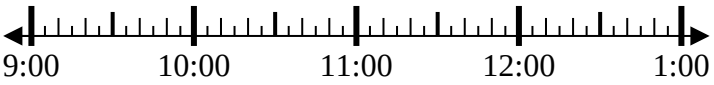

2) Start: 2:00
Elapsed: 2 hrs & 55 mins
End: _____

3) Start: 7:40
Elapsed: 2 hrs & 15 mins
End: _____

4) Start: 7:15
Elapsed: 1 hr & 10 mins
End: _____

5) Start: 11:15
Elapsed: 2 hrs & 25 mins
End: _____

6) Start: 5:30
Elapsed: 1 hr & 25 mins
End: _____

7) Start: 12:00
Elapsed: 2 hrs & 40 mins
End: _____

8) Start: 12:15
Elapsed: 1 hr & 20 mins
End: _____

Answers

1. _____
2. _____
3. _____
4. _____
5. _____
6. _____
7. _____
8. _____

1-8	88	75	63	50	38	25	13	0

Finding Ending Time with a Numberline

Name: **Answer Key**

Solve each problem.

1) Start: 9:20
Elapsed: 1 hr & 25 mins
End: 10:45

2) Start: 2:00
Elapsed: 2 hrs & 55 mins
End: 4:55

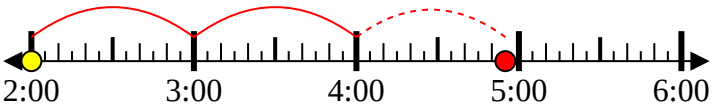

3) Start: 7:40
Elapsed: 2 hrs & 15 mins
End: 9:55

4) Start: 7:15
Elapsed: 1 hr & 10 mins
End: 8:25

5) Start: 11:15
Elapsed: 2 hrs & 25 mins
End: 1:40

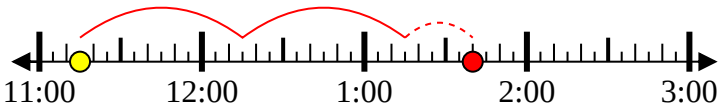

6) Start: 5:30
Elapsed: 1 hr & 25 mins
End: 6:55

7) Start: 12:00
Elapsed: 2 hrs & 40 mins
End: 2:40

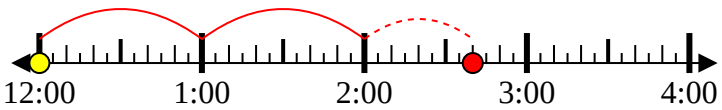

8) Start: 12:15
Elapsed: 1 hr & 20 mins
End: 1:35

Answers

1. 10:45
2. 4:55
3. 9:55
4. 8:25
5. 1:40
6. 6:55
7. 2:40
8. 1:35

1-8	88	75	63	50	38	25	13	0