Finding Ending Time with a Numberline

Name:

Solve each problem.

1) Start: 9:20
Elapsed: 1 hr & 25 mins
End: _____

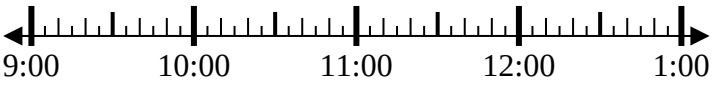

2) Start: 2:00
Elapsed: 2 hrs & 55 mins
End: _____

3) Start: 7:40
Elapsed: 2 hrs & 15 mins
End: _____

4) Start: 7:15
Elapsed: 1 hr & 10 mins
End: _____

5) Start: 11:15
Elapsed: 2 hrs & 25 mins
End: _____

6) Start: 5:30
Elapsed: 1 hr & 25 mins
End: _____

7) Start: 12:00
Elapsed: 2 hrs & 40 mins
End: _____

8) Start: 12:15
Elapsed: 1 hr & 20 mins
End: _____

Answers

1. _____
2. _____
3. _____
4. _____
5. _____
6. _____
7. _____
8. _____

1-8	88	75	63	50	38	25	13	0

Finding Ending Time with a Numberline

Name: **Answer Key**

Solve each problem.

1) Start: 9:20
Elapsed: 1 hr & 25 mins
End: 10:45

2) Start: 2:00
Elapsed: 2 hrs & 55 mins
End: 4:55

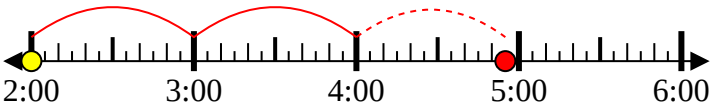

3) Start: 7:40
Elapsed: 2 hrs & 15 mins
End: 9:55

4) Start: 7:15
Elapsed: 1 hr & 10 mins
End: 8:25

5) Start: 11:15
Elapsed: 2 hrs & 25 mins
End: 1:40

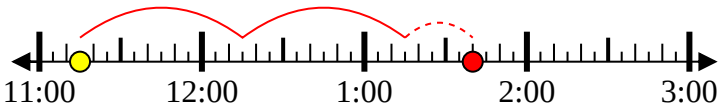

6) Start: 5:30
Elapsed: 1 hr & 25 mins
End: 6:55

7) Start: 12:00
Elapsed: 2 hrs & 40 mins
End: 2:40

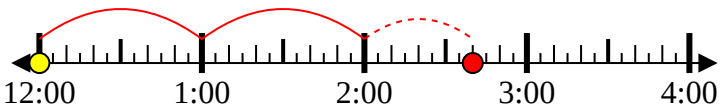

8) Start: 12:15
Elapsed: 1 hr & 20 mins
End: 1:35

Answers

1. 10:45
2. 4:55
3. 9:55
4. 8:25
5. 1:40
6. 6:55
7. 2:40
8. 1:35

1-8	88	75	63	50	38	25	13	0