Creating Clocks Name:

**Draw the hour and minute hand on the clock so it represents the time shown.**

**1)** 6:08

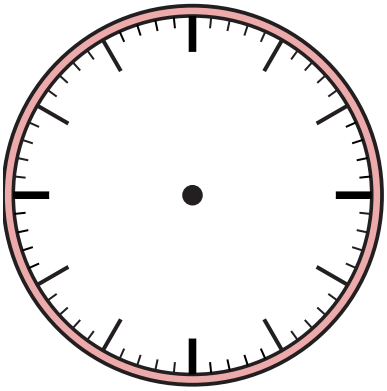

**2)** 11:41

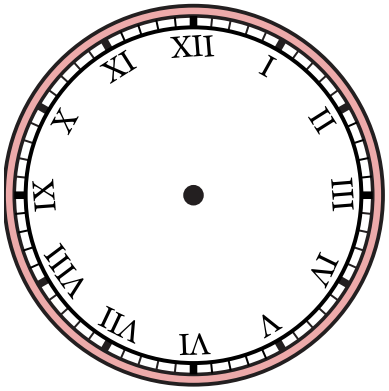


**3)** 12:25

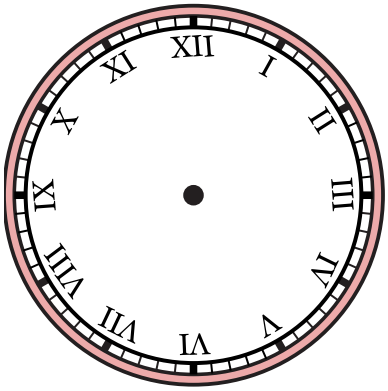


**4)** 9:18

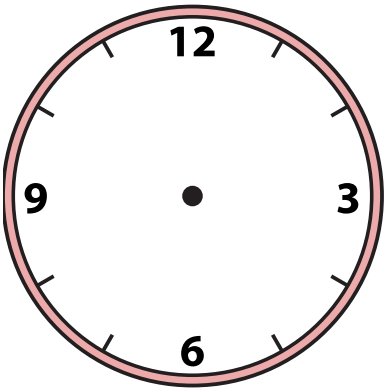


**5)** 12:04

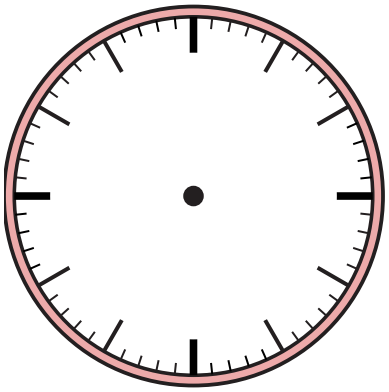

**6)** 6:06

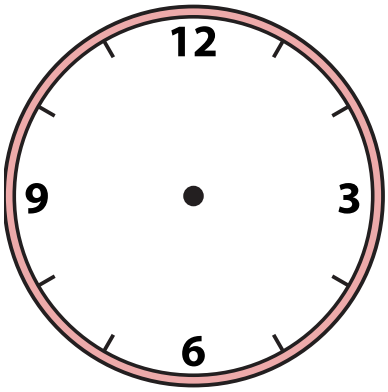


**7)** 10:30

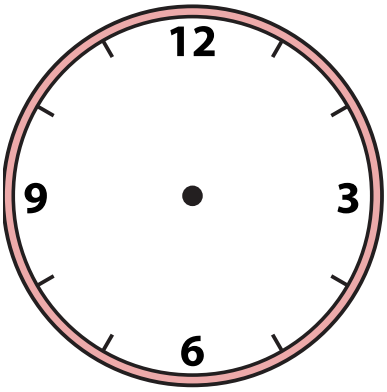


**8)** 3:05

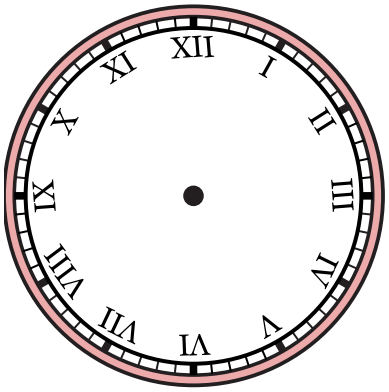


**9)** 11:15

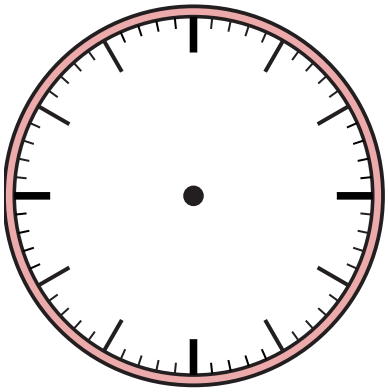



| 1-9 | 89 | 78 | 67 | 56 | 44 | 33 | 22 | 11 | 0 |
|---|---|---|---|---|---|---|---|---|---|

Creating Clocks Name: **Answer Key**

**Draw the hour and minute hand on the clock so it represents the time shown.**

**1)** 6:08

**2)** 11:41




**3)** 12:25

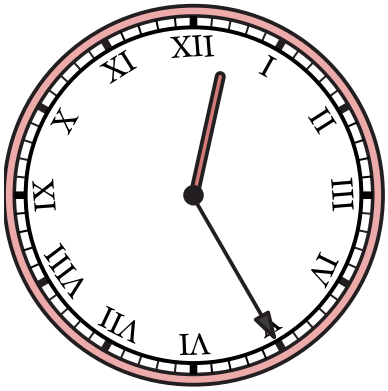


**4)** 9:18




**5)** 12:04

**6)** 6:06




**7)** 10:30




**8)** 3:05

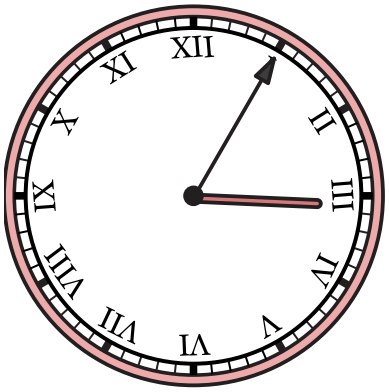


**9)** 11:15

| 1-9 | 89 | 78 | 67 | 56 | 44 | 33 | 22 | 11 | 0 |
|---|---|---|---|---|---|---|---|---|---|