Identifying Similar and Congruent Shapes

Name:

Determine if the shapes shown are 'similar', 'congruent' or 'neither'.

1)

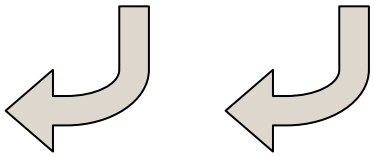

2)

3)

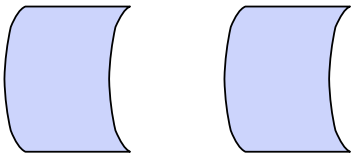

4)

5)

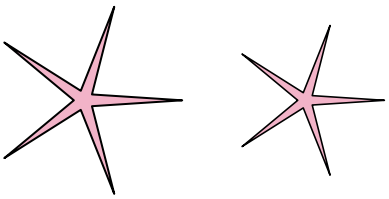

6)

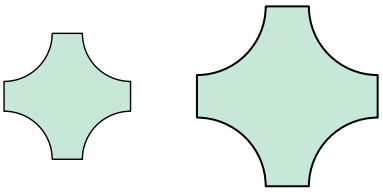

7)

8)

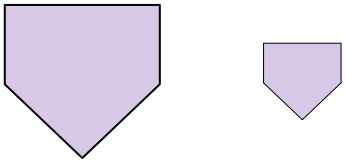

9)

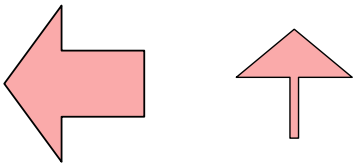

10)

11)

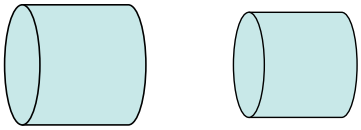

12)

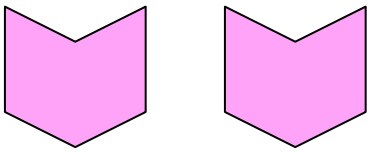

13)

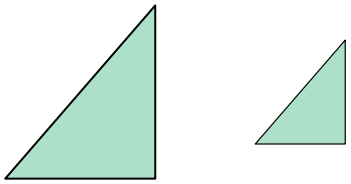

14)

15)

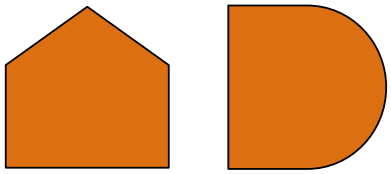

16)

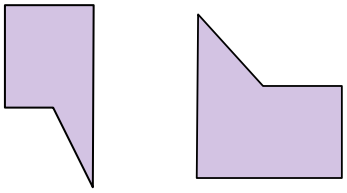

Answers

1. _____
2. _____
3. _____
4. _____
5. _____
6. _____
7. _____
8. _____
9. _____
10. _____
11. _____
12. _____
13. _____
14. _____
15. _____
16. _____

1-10	94	88	81	75	69	63	56	50	44	38
11-16	31	25	19	13	6	0				

Identifying Similar and Congruent Shapes Name: **Answer Key**

Determine if the shapes shown are 'similar', 'congruent' or 'neither'.

1)

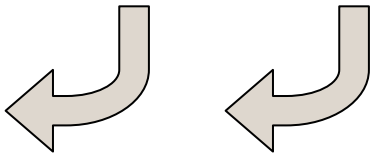

2)

3)

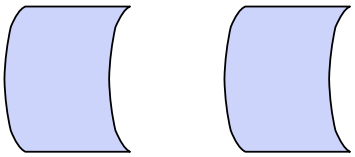

4)

5)

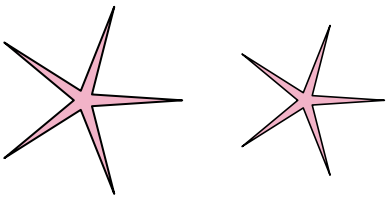

6)

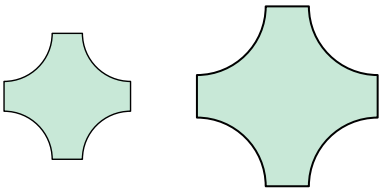

7)

8)

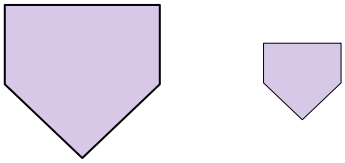

9)

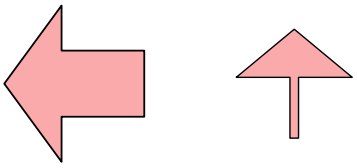

10)

11)

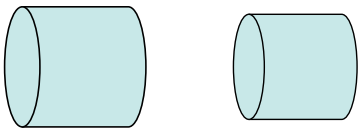

12)

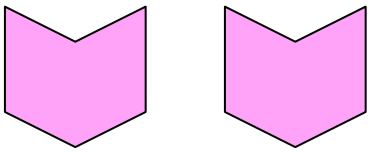

13)

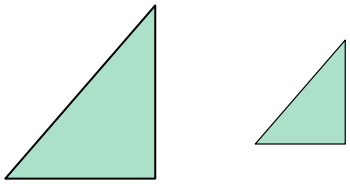

14)

15)

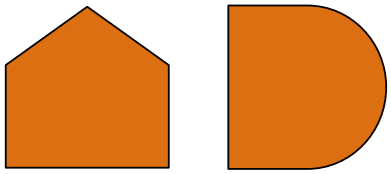

16)

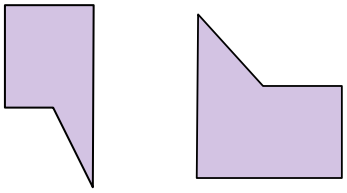

Answers

1. congruent
2. congruent
3. congruent
4. congruent
5. similar
6. similar
7. neither
8. similar
9. neither
10. neither
11. similar
12. congruent
13. similar
14. congruent
15. neither
16. neither

1-10	94	88	81	75	69	63	56	50	44	38
11-16	31	25	19	13	6	0				