Classifying Shapes Name:

Determine if the shape shown is a Quadrilateral, Kite, Trapezoid, Parallelogram, Rhombus, Rectangle or Square (can be more than one).

1)

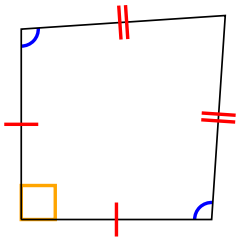

2)

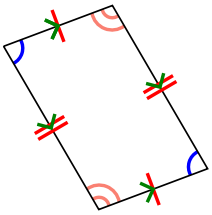

3)

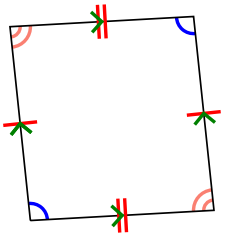

4)



5)

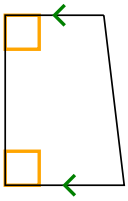

6)

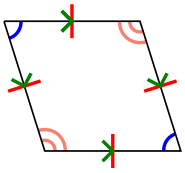

7)

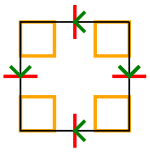

8)

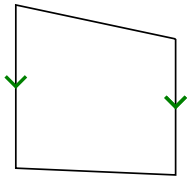

9)

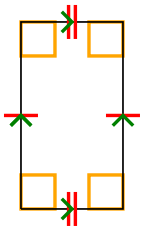

10)



11)



12)

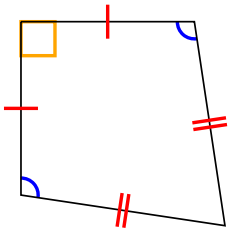

Answers

1. _____
2. _____
3. _____
4. _____
5. _____
6. _____
7. _____
8. _____
9. _____
10. _____
11. _____
12. _____

1-10	92	83	75	67	58	50	42	33	25	17
11-12	8	0								

Classifying Shapes

Name: **Answer Key**

Determine if the shape shown is a Quadrilateral, Kite, Trapezoid, Parallelogram, Rhombus, Rectangle or Square (can be more than one).

1)

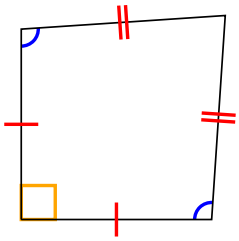

2)

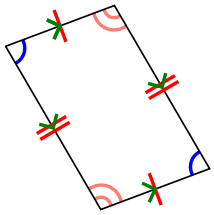

3)

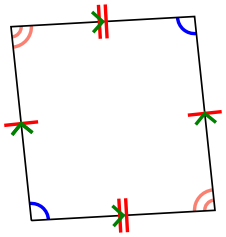

4)



5)

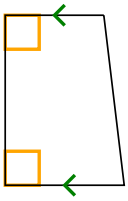

6)

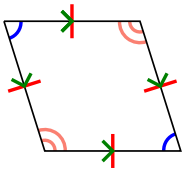

7)

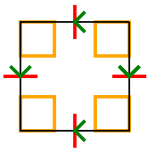

8)

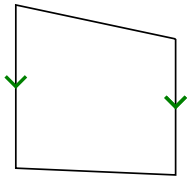

9)

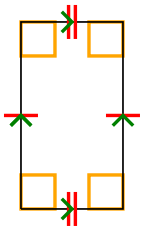

10)



11)



12)

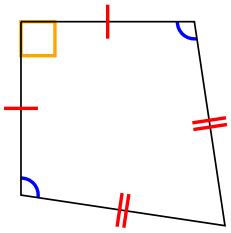

Answers

1. Q,K
2. Q,P
3. Q,P
4. Q
5. Q,T
6. Q,P,H
7. Q,P,H,R,S
8. Q,T
9. Q,P,R
10. Q
11. Q
12. Q,K

1-10	92	83	75	67	58	50	42	33	25	17
11-12	8	0								