Function Machines (Add & Subtract) Name:

Determine the rule each function machine is using.

Ex)

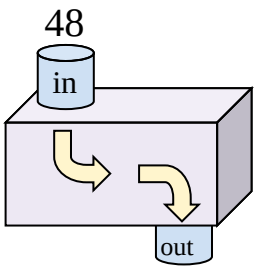

Subtract 33

1)

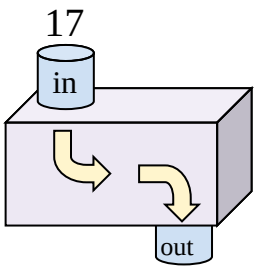

2)

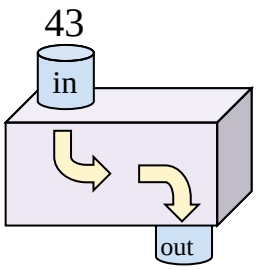

3)

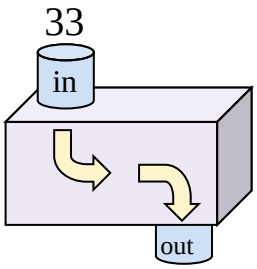

4)

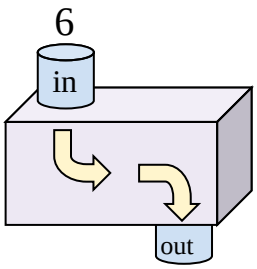

5)

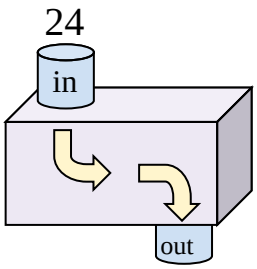

6)

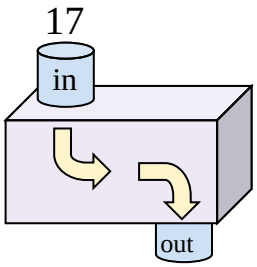

7)

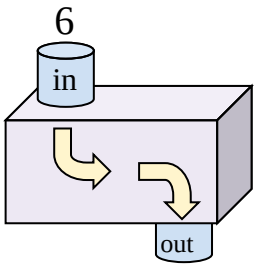

8)

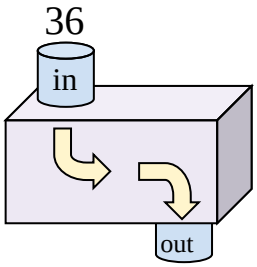

9)

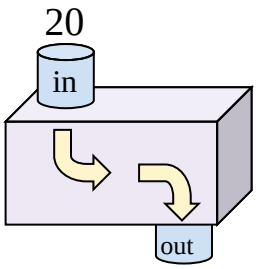

10)

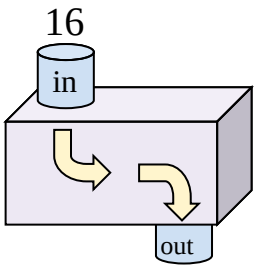

11)

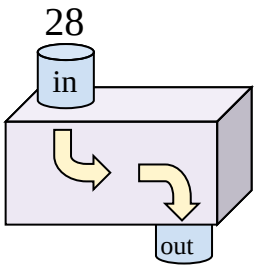

Answers

Ex. Subtract 33

1. _____
2. _____
3. _____
4. _____
5. _____
6. _____
7. _____
8. _____
9. _____
10. _____
11. _____

1-10	91	82	73	64	55	45	36	27	18	9
11	0									

Function Machines (Add & Subtract) Name: **Answer Key**

Determine the rule each function machine is using.

Ex)

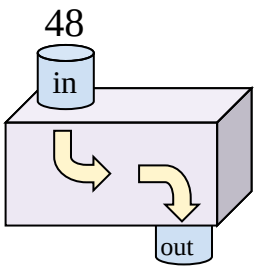

Subtract 33

1)

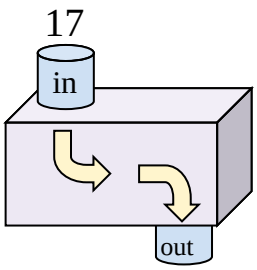

Add 15

2)

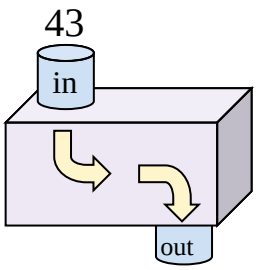

Subtract 23

3)

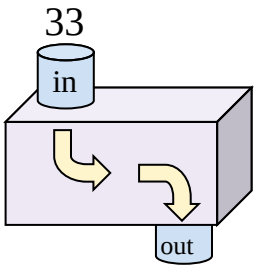

Subtract 15

4)

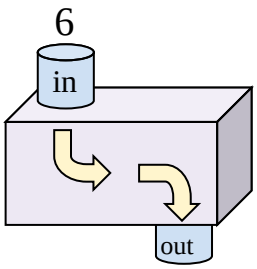

Add 36

5)

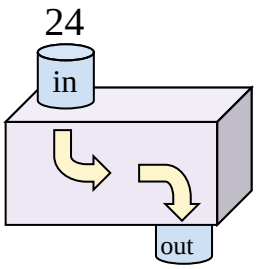

Add 14

6)

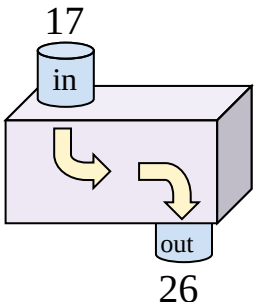

Add 9

7)

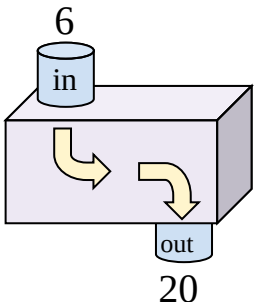

Add 14

8)

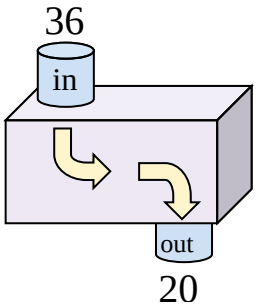

Subtract 16

9)

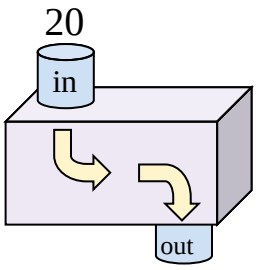

Add 8

10)

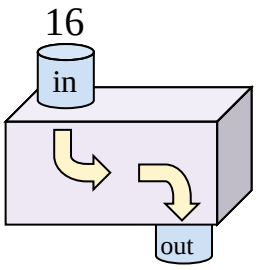

Add 19

11)

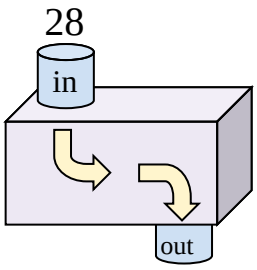

Subtract 9

Answers

Ex.	Subtract 33
1.	Add 15
2.	Subtract 23
3.	Subtract 15
4.	Add 36
5.	Add 14
6.	Add 9
7.	Add 14
8.	Subtract 16
9.	Add 8
10.	Add 19
11.	Subtract 9

1-10	91	82	73	64	55	45	36	27	18	9
11	0									