Rewriting Multiplication Problems (visual)

Name:

Write each array as a multiplication problem and solve.

Ex)

1)



2)



3)

4)



5)

6)



7)



8)

9)



10)



11)

Answers

Ex. 3 × 2 = 6

1. _____
2. _____
3. _____
4. _____
5. _____
6. _____
7. _____
8. _____
9. _____
10. _____
11. _____

Rewriting Multiplication Problems (visual) Name: **Answer Key**

Write each array as a multiplication problem and solve.

Ex)

1) 

2) 

3)

4) 

5)

6) 

7) 

8)

9) 

10) 

11)

Answers

Ex. 3 × 2 = 6

1. 6 × 8 = 48
2. 9 × 7 = 63
3. 7 × 3 = 21
4. 6 × 10 = 60
5. 5 × 10 = 50
6. 8 × 6 = 48
7. 10 × 3 = 30
8. 2 × 8 = 16
9. 7 × 10 = 70
10. 8 × 7 = 56
11. 2 × 6 = 12

1-10	91	82	73	64	55	45	36	27	18	9
11	0									