Rewriting Multiplication Problems (visual)

Name:

Write each array as a multiplication problem and solve.

Ex)



1)



2)

3)

4)

5)



6)

7)



8)



9)



10)



11)



Answers

Ex. **6 × 7 = 42**

1. _____
2. _____
3. _____
4. _____
5. _____
6. _____
7. _____
8. _____
9. _____
10. _____
11. _____

1-10	91	82	73	64	55	45	36	27	18	9
11	0									

Rewriting Multiplication Problems (visual) Name: **Answer Key**

Write each array as a multiplication problem and solve.

Ex)



1)



2)

3)

4)

5)



6)

7)



8)



9)



10)



11)



Answers

Ex. 6 × 7 = 42

1. 7 × 10 = 70
2. 3 × 4 = 12
3. 3 × 7 = 21
4. 5 × 4 = 20
5. 7 × 4 = 28
6. 4 × 9 = 36
7. 4 × 10 = 40
8. 2 × 8 = 16
9. 8 × 9 = 72
10. 4 × 4 = 16
11. 7 × 9 = 63

1-10	91	82	73	64	55	45	36	27	18	9
11	0									