# Dividing Unit Fractions with a Numberline

Name:

**Use the numberline to solve each problem. The first is marked for you.**

**1)** $\frac{1}{6} \div 2$

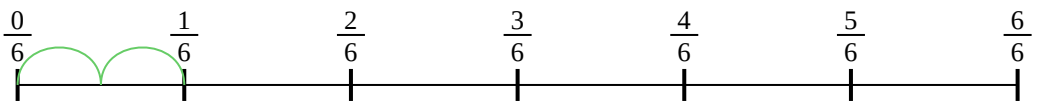


**2)** $\frac{1}{3} \div 5$




**3)** $\frac{1}{5} \div 3$




**4)** $\frac{1}{6} \div 6$

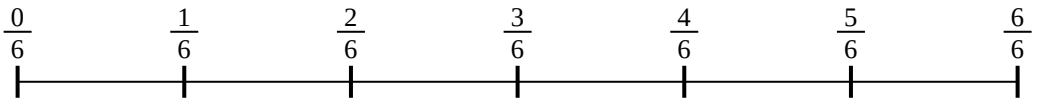


**5)** $\frac{1}{3} \div 4$




**6)** $\frac{1}{5} \div 2$




**7)** $\frac{1}{4} \div 4$

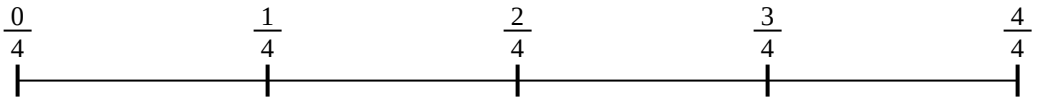


**8)** $\frac{1}{4} \div 3$

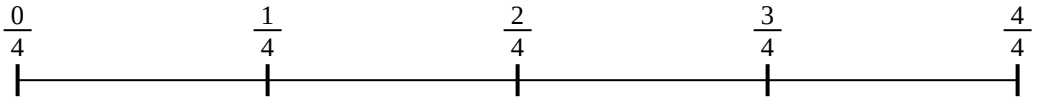


**9)** $\frac{1}{6} \div 5$

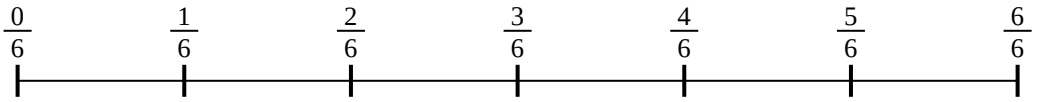


## Answers

1. _____
2. _____
3. _____
4. _____
5. _____
6. _____
7. _____
8. _____
9. _____



| 1-9 | 89 | 78 | 67 | 56 | 44 | 33 | 22 | 11 | 0 |
|---|---|---|---|---|---|---|---|---|---|

Dividing Unit Fractions with a Numberline Name: **Answer Key**

**Use the numberline to solve each problem. The first is marked for you.**

**1)** $\frac{1}{6} \div 2$

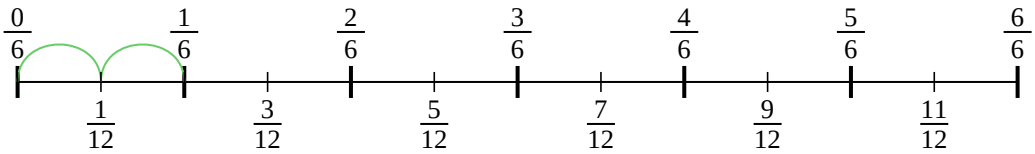


**2)** $\frac{1}{3} \div 5$

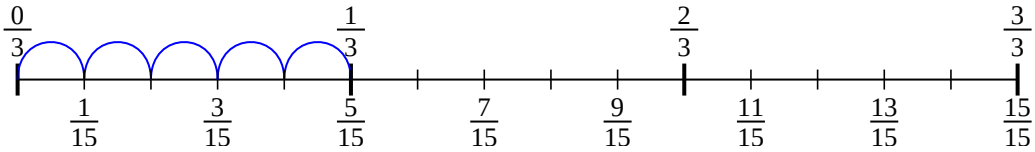


**3)** $\frac{1}{5} \div 3$

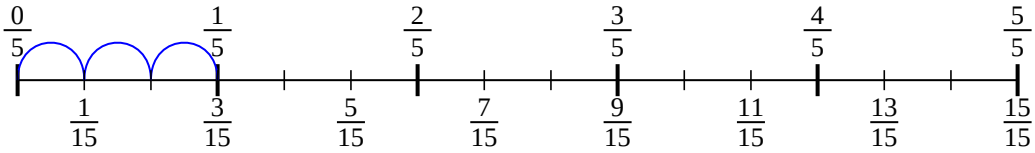


**4)** $\frac{1}{6} \div 6$

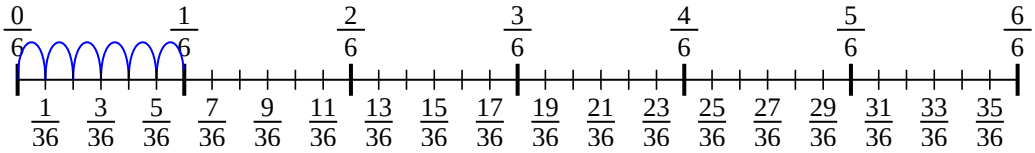


**5)** $\frac{1}{3} \div 4$

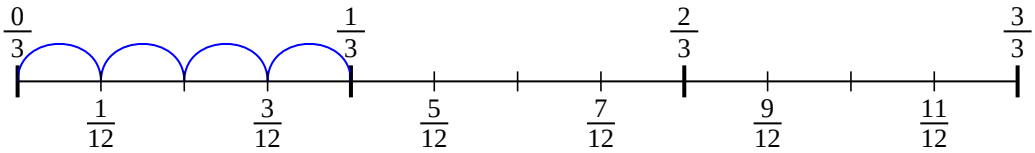


**6)** $\frac{1}{5} \div 2$

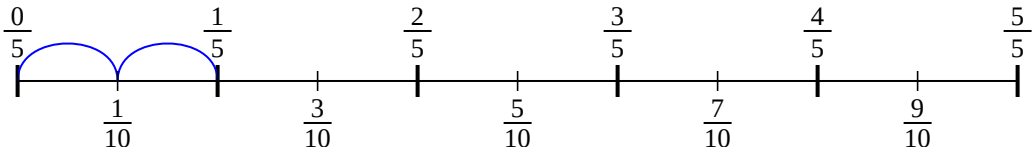


**7)** $\frac{1}{4} \div 4$

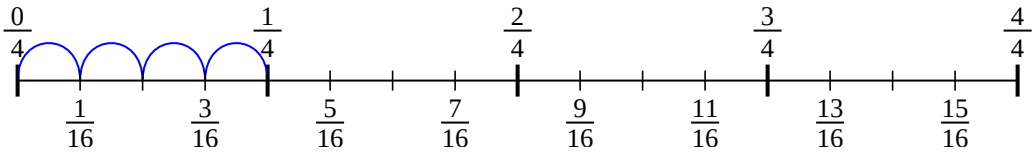


**8)** $\frac{1}{4} \div 3$

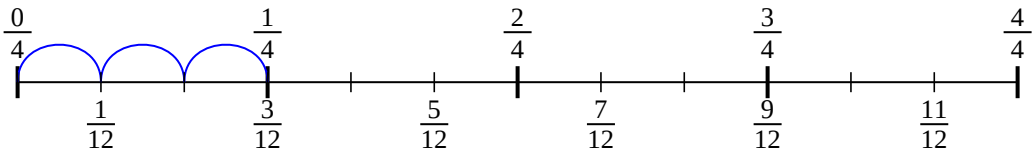


**9)** $\frac{1}{6} \div 5$

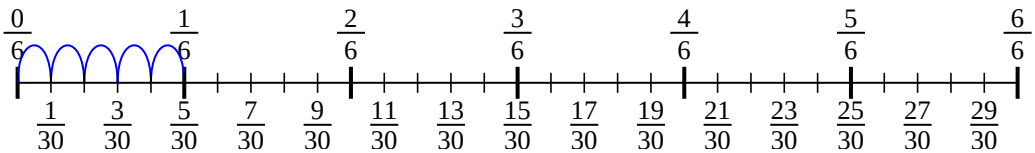


## Answers

1. $\frac{1}{12}$
2. $\frac{1}{15}$
3. $\frac{1}{15}$
4. $\frac{1}{36}$
5. $\frac{1}{12}$
6. $\frac{1}{10}$
7. $\frac{1}{16}$
8. $\frac{1}{12}$
9. $\frac{1}{30}$



| 1-9 | 89 | 78 | 67 | 56 | 44 | 33 | 22 | 11 | 0 |
|---|---|---|---|---|---|---|---|---|---|

# Dividing Unit Fractions with a Numberline

Name:

**Use the numberline to solve each problem. The first is marked for you.**

| | | | |
|---|---|---|---|
| $1/36$ | $1/12$ | $1/30$ | $1/12$ |
| $1/15$ | $1/10$ | $1/12$ | $1/16$ |
| $1/15$ | | | |

**1)** $1/6 \div 2$

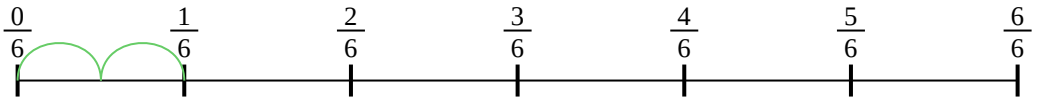


**2)** $1/3 \div 5$




**3)** $1/5 \div 3$




**4)** $1/6 \div 6$

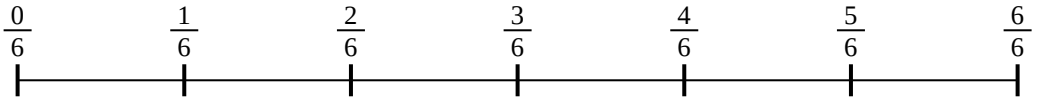


**5)** $1/3 \div 4$




**6)** $1/5 \div 2$




**7)** $1/4 \div 4$

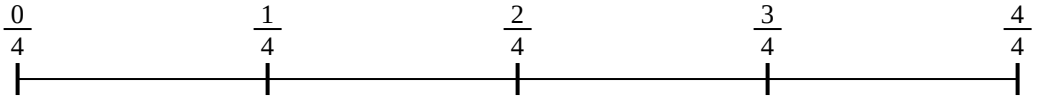


**8)** $1/4 \div 3$

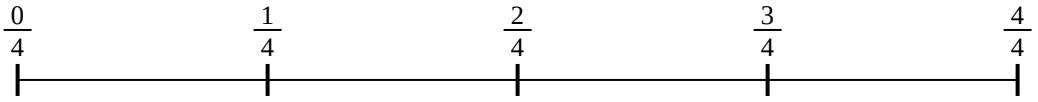


**9)** $1/6 \div 5$

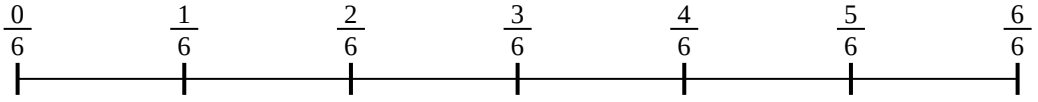


## Answers

1. _____
2. _____
3. _____
4. _____
5. _____
6. _____
7. _____
8. _____
9. _____



| 1-9 | 89 | 78 | 67 | 56 | 44 | 33 | 22 | 11 | 0 |
|---|---|---|---|---|---|---|---|---|---|