Identifying Hour and Minute Hands

Name:

Determine which clock accurately shows the time.

1) 6:00

A. 

B. 

2) 11:00

A. 

B. 

3) 12:45

A. 

B. 

4) 9:45

A. 

B. 

5) 12:45

A. 

B. 

6) 6:00

A. 

B. 

7) 10:00

A. 

B. 

8) 3:30

A. 

B. 

9) 11:30

A. 

B. 

10) 4:30

A. 

B. 

11) 8:45

A.

B. 

12) 6:15

A. 

B. 

Answers

1. _____
2. _____
3. _____
4. _____
5. _____
6. _____
7. _____
8. _____
9. _____
10. _____
11. _____
12. _____

1-10	92	83	75	67	58	50	42	33	25	17
11-12	8	0								

Identifying Hour and Minute Hands

Name: **Answer Key**

Determine which clock accurately shows the time.

1) 6:00

A. 

B. 

2) 11:00

A. 

B. 

3) 12:45

A. 

B. 

4) 9:45

A. 

B. 

5) 12:45

A. 

B. 

6) 6:00

A. 

B. 

7) 10:00

A. 

B. 

8) 3:30

A. 

B. 

9) 11:30

A. 

B. 

10) 4:30

A. 

B.

11) 8:45

A.

B. 

12) 6:15

A. 

B. 

Answers

1. A
2. B
3. B
4. A
5. A
6. A
7. A
8. B
9. A
10. A
11. A
12. A

1-10	92	83	75	67	58	50	42	33	25	17
11-12	8	0								