Dividing with a Numberline

Name:

Use the numberline to solve each problem.

1) 16÷4=

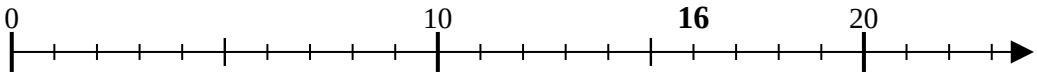

2) 30÷6=

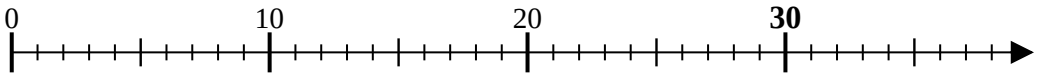

3) 8÷2=

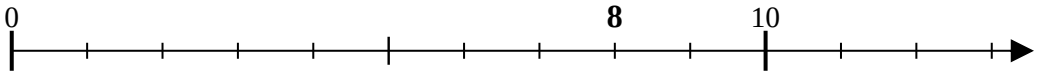

4) 20÷5=

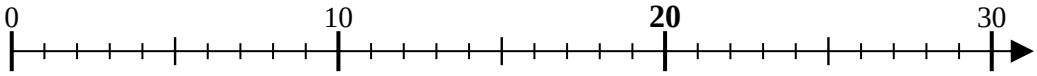

5) 6÷2=

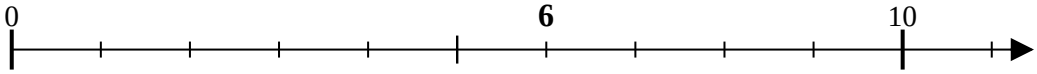

6) 40÷8=

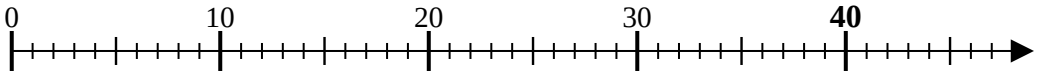

7) 9÷3=

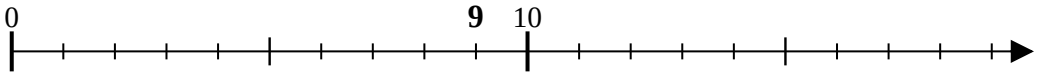

8) 18÷9=

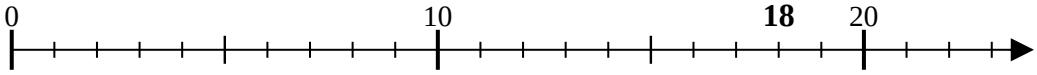

9) 24÷6=

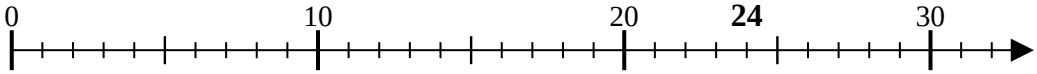

10) 45÷9=

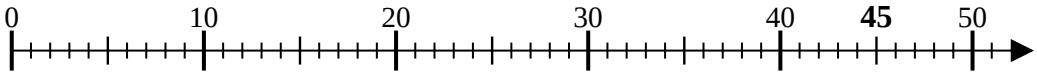

11) 24÷8=

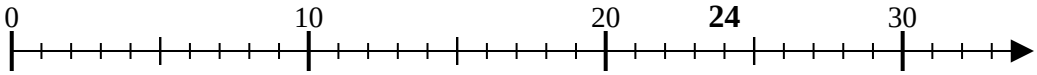

Answers

1. _____
2. _____
3. _____
4. _____
5. _____
6. _____
7. _____
8. _____
9. _____
10. _____
11. _____

1-10	91	82	73	64	55	45	36	27	18	9
11	0									

Dividing with a Numberline

Name: **Answer Key**

Use the numberline to solve each problem.

1) 16÷4=

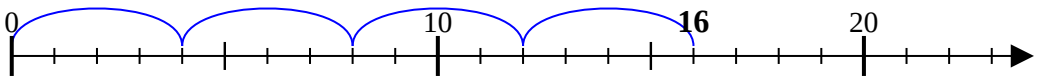

2) 30÷6=

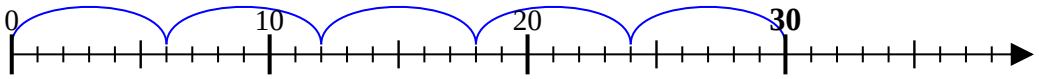

3) 8÷2=

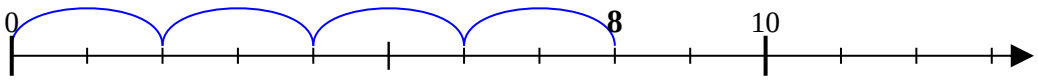

4) 20÷5=

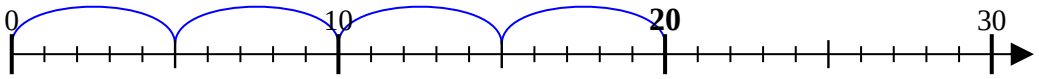

5) 6÷2=

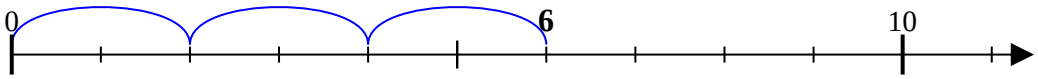

6) 40÷8=

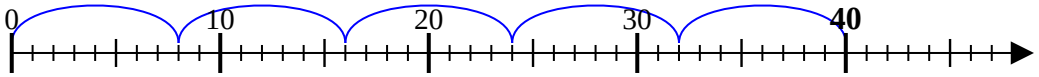

7) 9÷3=

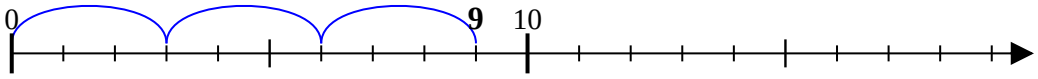

8) 18÷9=

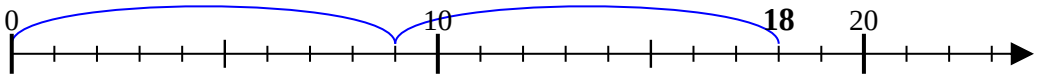

9) 24÷6=

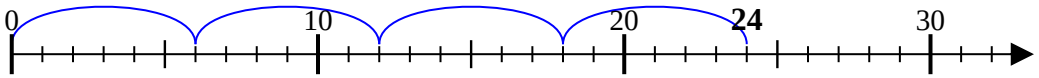

10) 45÷9=

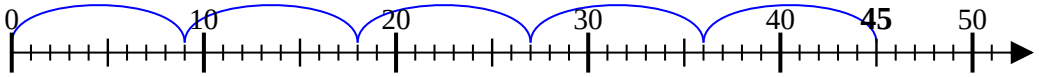

11) 24÷8=

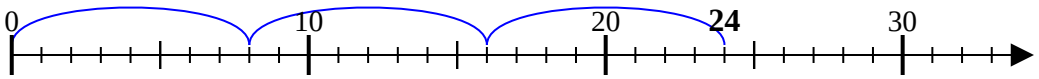

Answers

1. 4
2. 5
3. 4
4. 4
5. 3
6. 5
7. 3
8. 2
9. 4
10. 5
11. 3

1-10	91	82	73	64	55	45	36	27	18	9
11	0									