Determining Decimal Value with Blocks

Name:

Use the block on the left to find the value of the set of blocks on the right.

1) 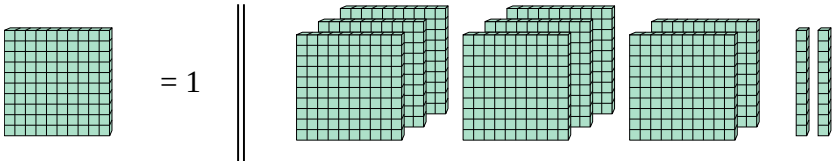

2) 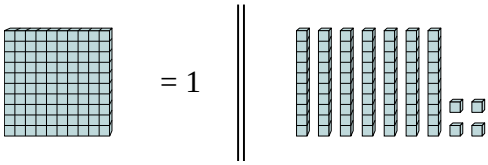

3) 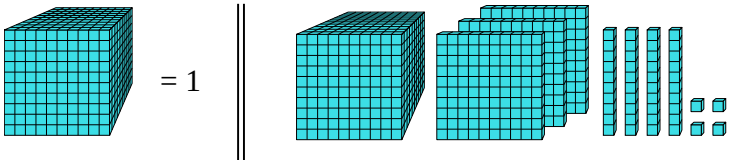

4) 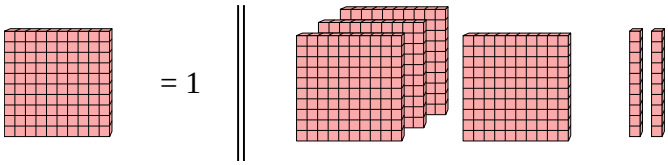

5) 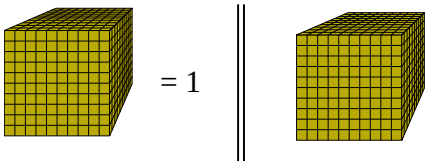

6) 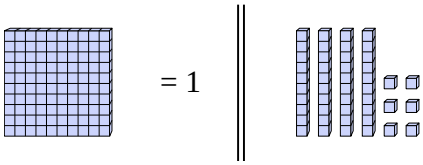

7) 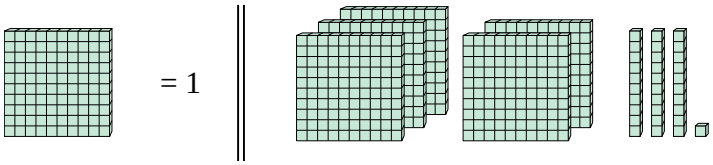

8) 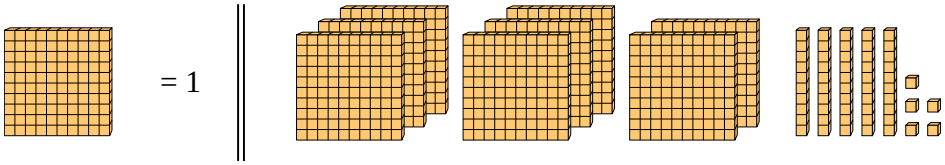

9) 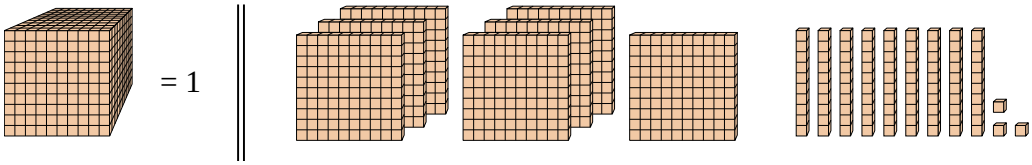

10) 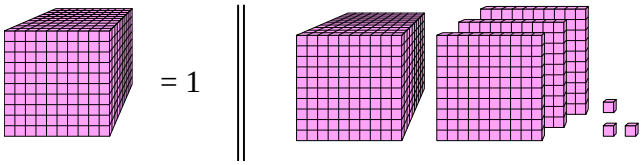

Answers

1. _____
2. _____
3. _____
4. _____
5. _____
6. _____
7. _____
8. _____
9. _____
10. _____

1-10	90	80	70	60	50	40	30	20	10	0

Determining Decimal Value with Blocks

Name: **Answer Key**

Use the block on the left to find the value of the set of blocks on the right.

1) 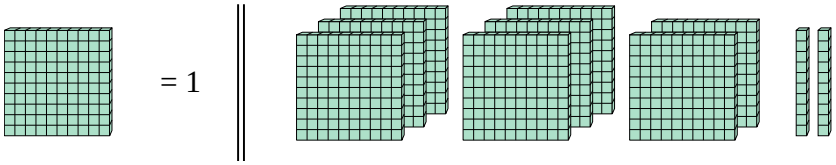

2) 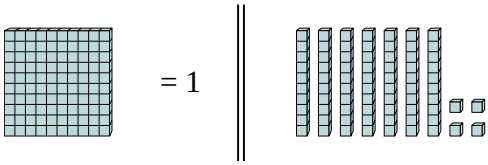

3) 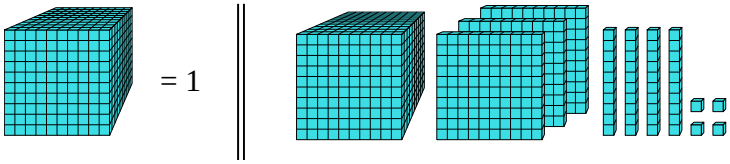

4) 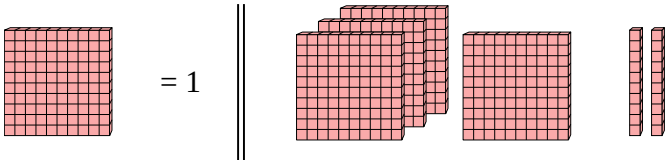

5) 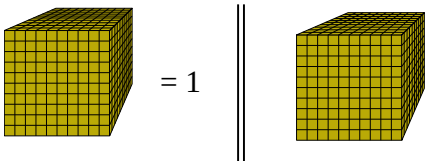

6) 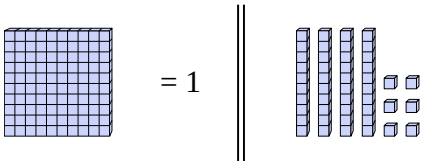

7) 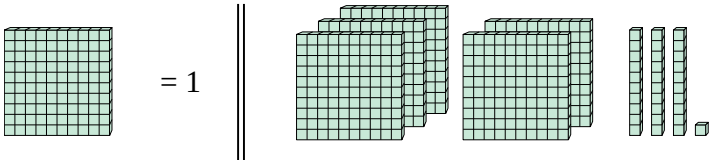

8) 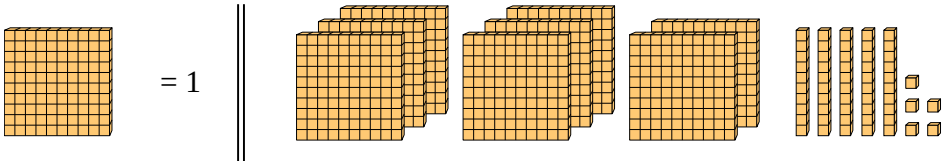

9) 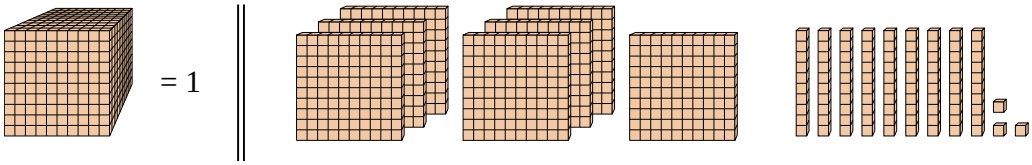

10) 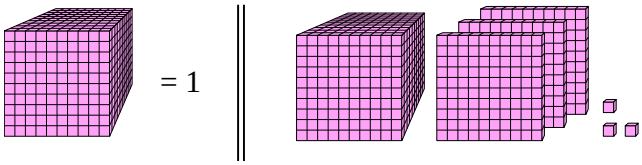

Answers

1. **8.2**
2. **0.74**
3. **1.344**
4. **4.2**
5. **1**
6. **0.46**
7. **5.31**
8. **8.55**
9. **0.793**
10. **1.303**

1-10	90	80	70	60	50	40	30	20	10	0