Counting Groups of Ten

Name:

Determine the quantity of groups of ten. Then find the total number of smaller blocks.

1)

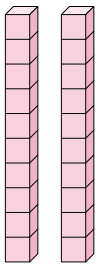

2)

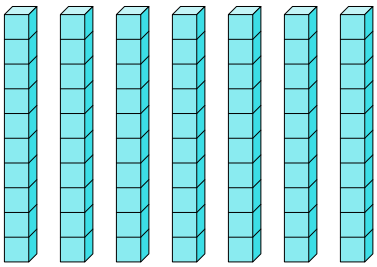

3)

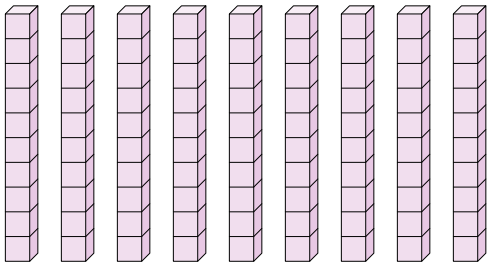

4)



5)

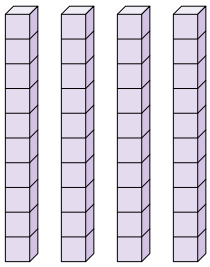

6)

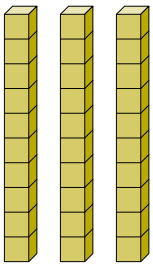

7)

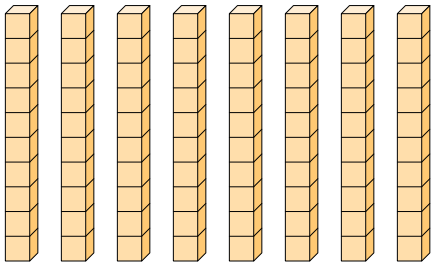

8)

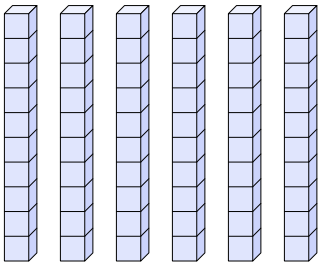

Answers

1. _____ _____
2. _____ _____
3. _____ _____
4. _____ _____
5. _____ _____
6. _____ _____
7. _____ _____
8. _____ _____

1-8	88	75	63	50	38	25	13	0

Counting Groups of Ten

Name: **Answer Key**

Determine the quantity of groups of ten. Then find the total number of smaller blocks.

1)

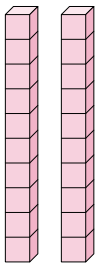

2)

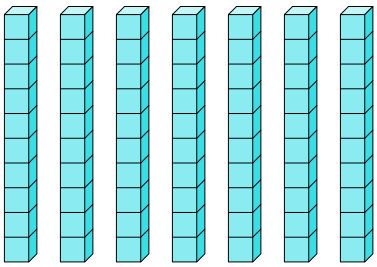

3)

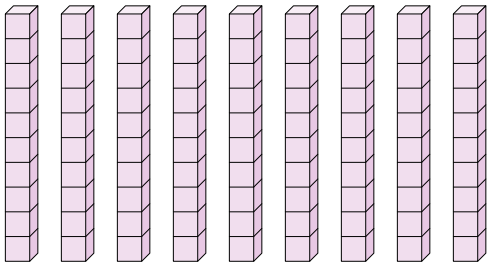

4)



5)

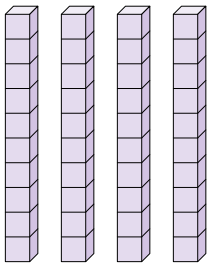

6)

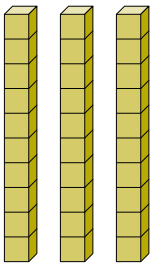

7)

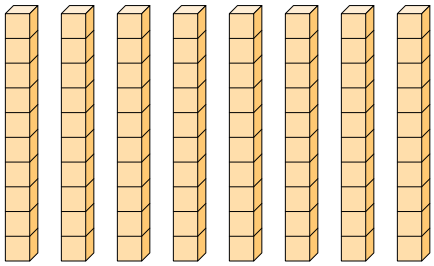

8)

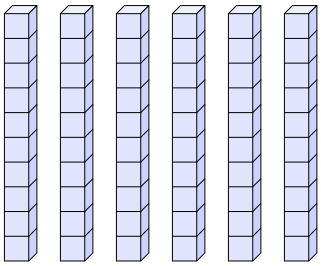

Answers

1.	2	20
2.	7	70
3.	9	90
4.	5	50
5.	4	40
6.	3	30
7.	8	80
8.	6	60

1-8	88	75	63	50	38	25	13	0

Counting Groups of Ten

Name:

Determine the quantity of groups of ten. Then find the total number of smaller blocks.

1)

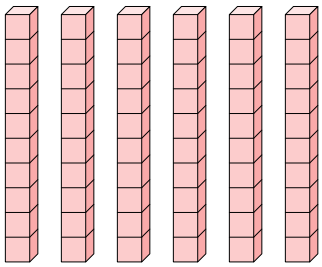

2)

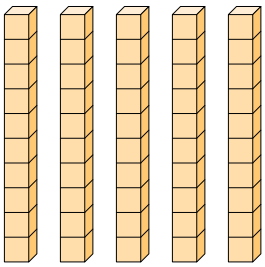

3)

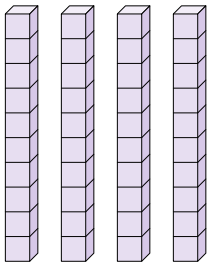

4)

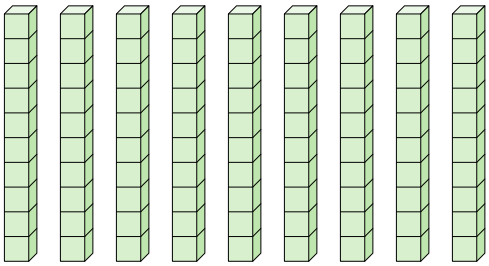

5)

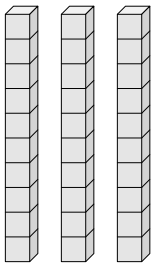

6)

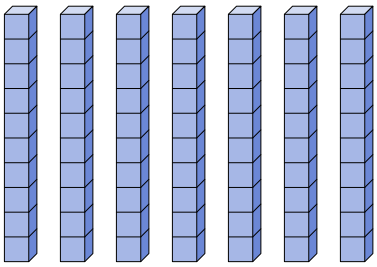

7)

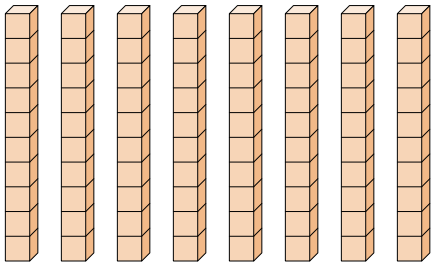

8)

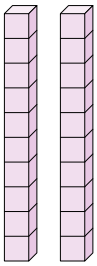

Answers

1. _____ _____
2. _____ _____
3. _____ _____
4. _____ _____
5. _____ _____
6. _____ _____
7. _____ _____
8. _____ _____

1-8	88	75	63	50	38	25	13	0

Counting Groups of Ten

Name: **Answer Key**

Determine the quantity of groups of ten. Then find the total number of smaller blocks.

1)

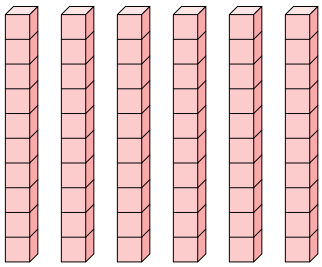

2)

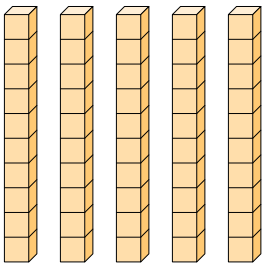

3)

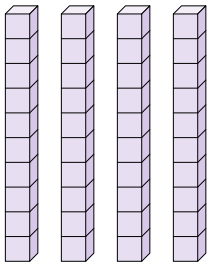

4)

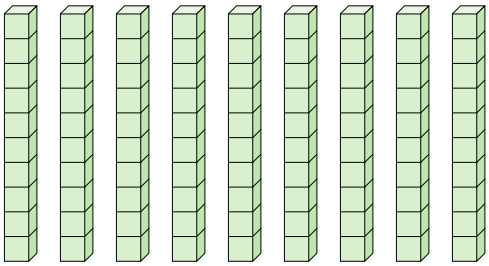

5)

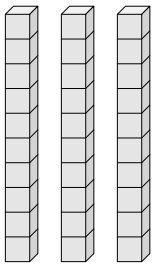

6)

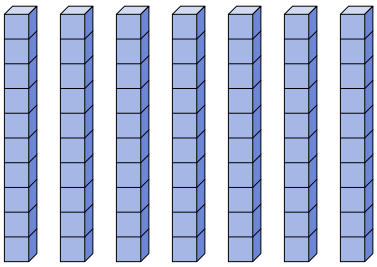

7)

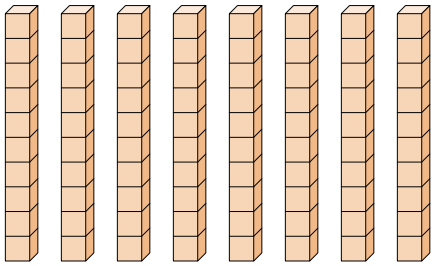

8)

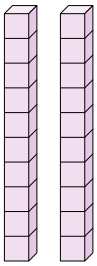

Answers

1.	6	60
2.	5	50
3.	4	40
4.	9	90
5.	3	30
6.	7	70
7.	8	80
8.	2	20

1-8	88	75	63	50	38	25	13	0

Counting Groups of Ten

Name:

Determine the quantity of groups of ten. Then find the total number of smaller blocks.

1)

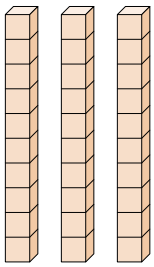

2)

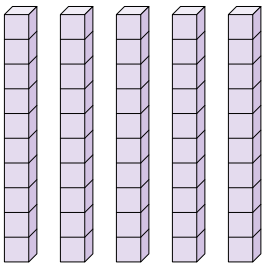

3)

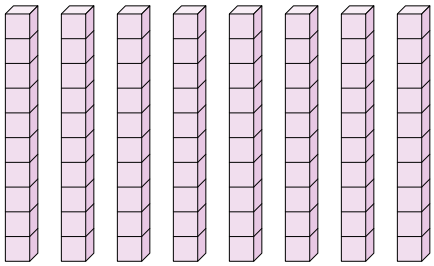

4)

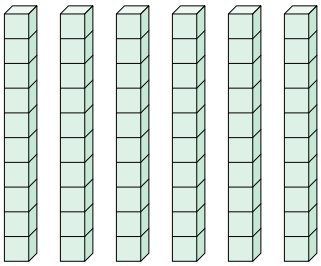

5)

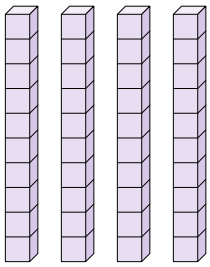

6)

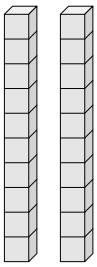

7)

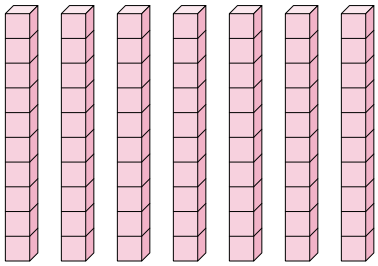

8)



Answers

1. _____ _____
2. _____ _____
3. _____ _____
4. _____ _____
5. _____ _____
6. _____ _____
7. _____ _____
8. _____ _____

1-8	88	75	63	50	38	25	13	0

Counting Groups of Ten

Name: **Answer Key**

Determine the quantity of groups of ten. Then find the total number of smaller blocks.

1)

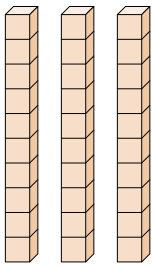

2)

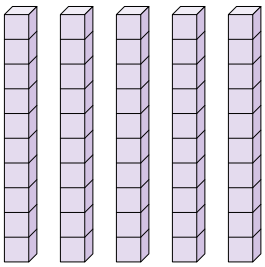

3)

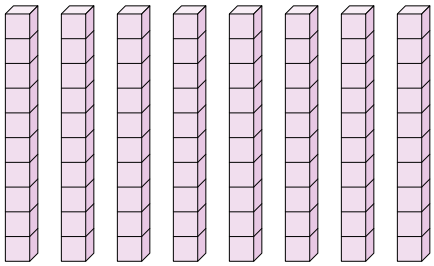

4)

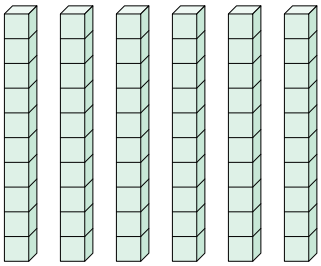

5)

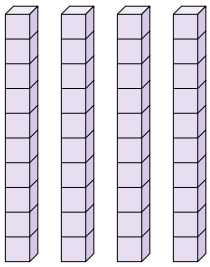

6)

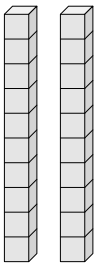

7)

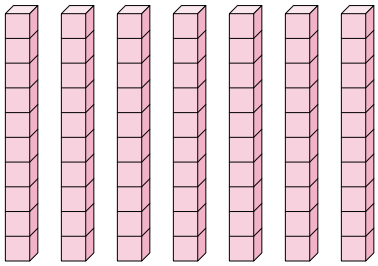

8)



Answers

1.	3	30
2.	5	50
3.	8	80
4.	6	60
5.	4	40
6.	2	20
7.	7	70
8.	9	90

1-8	88	75	63	50	38	25	13	0

Counting Groups of Ten

Name:

Determine the quantity of groups of ten. Then find the total number of smaller blocks.

1)

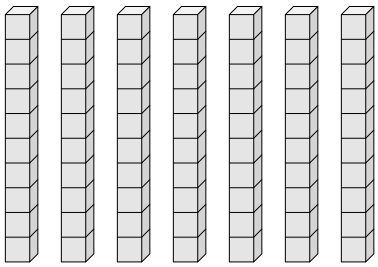

2)

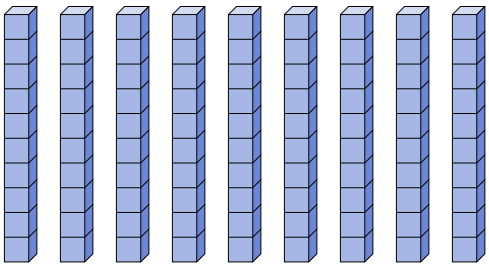

3)

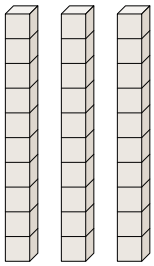

4)

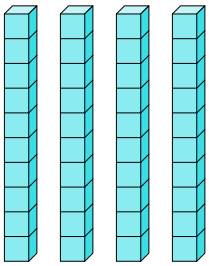

5)

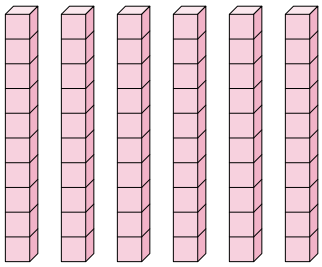

6)

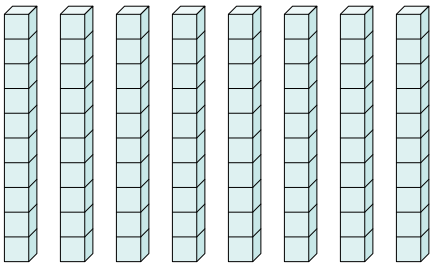

7)

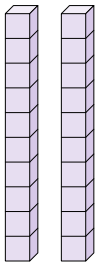

8)



Answers

1. _____ _____
2. _____ _____
3. _____ _____
4. _____ _____
5. _____ _____
6. _____ _____
7. _____ _____
8. _____ _____

1-8	88	75	63	50	38	25	13	0

Counting Groups of Ten

Name: **Answer Key**

Determine the quantity of groups of ten. Then find the total number of smaller blocks.

1)

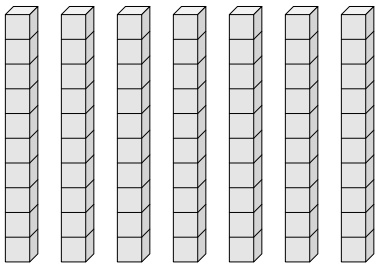

2)

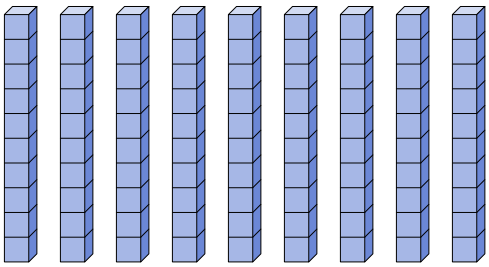

3)

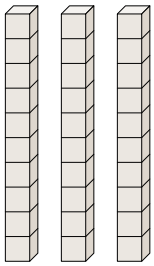

4)

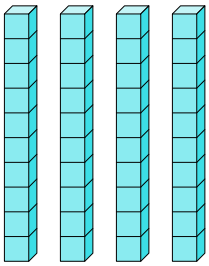

5)

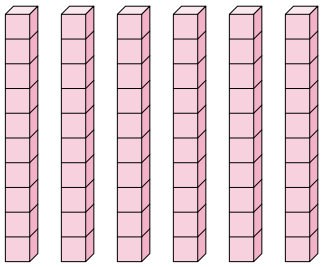

6)

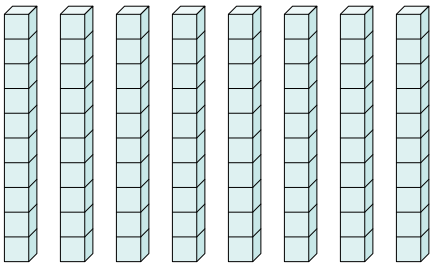

7)

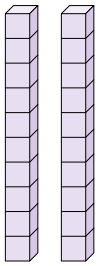

8)



Answers

1.	7	70
2.	9	90
3.	3	30
4.	4	40
5.	6	60
6.	8	80
7.	2	20
8.	5	50

1-8	88	75	63	50	38	25	13	0

Counting Groups of Ten

Name:

Determine the quantity of groups of ten. Then find the total number of smaller blocks.

1)

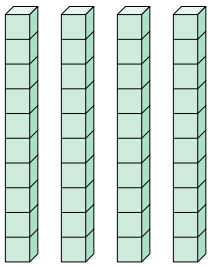

2)

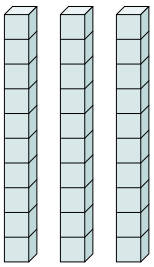

3)

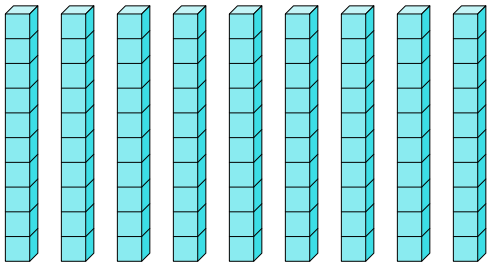

4)

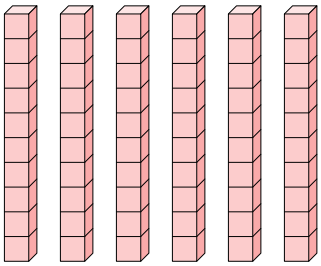

5)

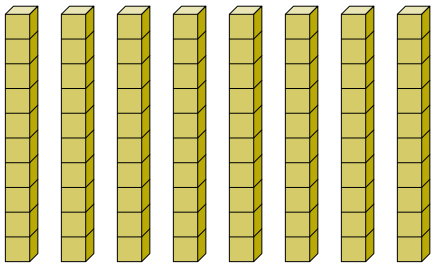

6)

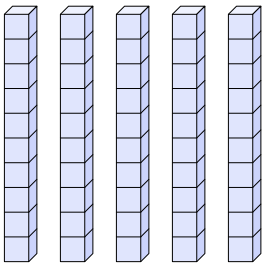

7)



8)

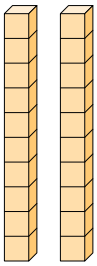

Answers

1. _____ _____
2. _____ _____
3. _____ _____
4. _____ _____
5. _____ _____
6. _____ _____
7. _____ _____
8. _____ _____

1-8	88	75	63	50	38	25	13	0

Counting Groups of Ten

Name: **Answer Key**

Determine the quantity of groups of ten. Then find the total number of smaller blocks.

1)

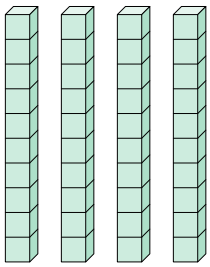

2)

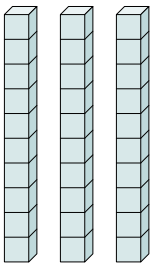

3)

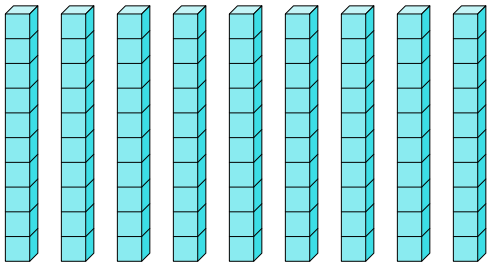

4)

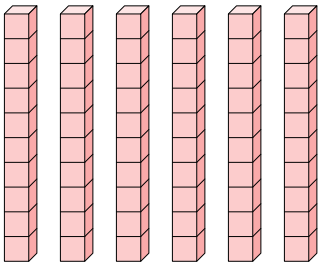

5)

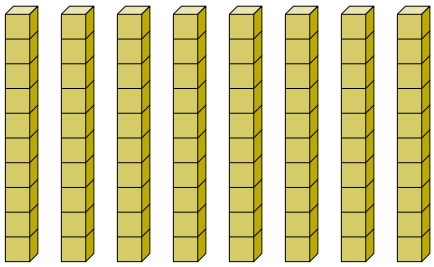

6)

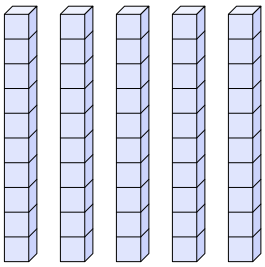

7)



8)

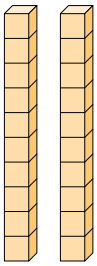

Answers

1.	4	40
2.	3	30
3.	9	90
4.	6	60
5.	8	80
6.	5	50
7.	7	70
8.	2	20

1-8	88	75	63	50	38	25	13	0

Counting Groups of Ten

Name:

Determine the quantity of groups of ten. Then find the total number of smaller blocks.

1)



2)

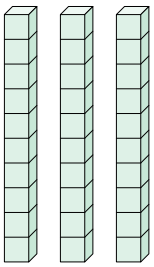

3)

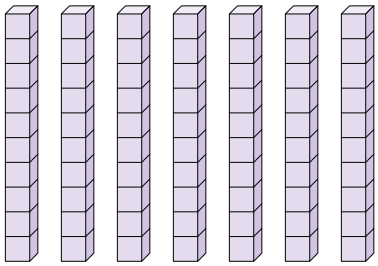

4)

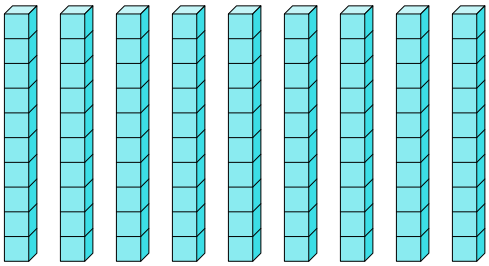

5)

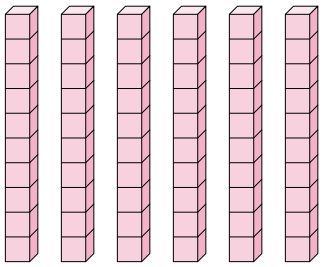

6)



7)

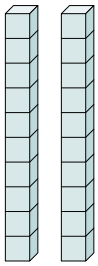

8)

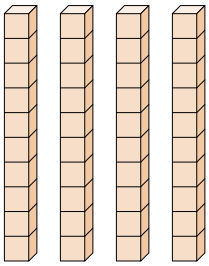

Answers

1. _____ _____
2. _____ _____
3. _____ _____
4. _____ _____
5. _____ _____
6. _____ _____
7. _____ _____
8. _____ _____

1-8	88	75	63	50	38	25	13	0

Counting Groups of Ten

Name: **Answer Key**

Determine the quantity of groups of ten. Then find the total number of smaller blocks.

1)



2)

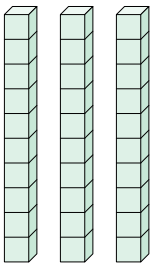

3)

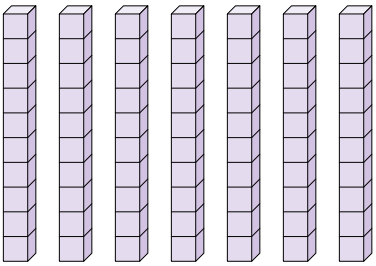

4)

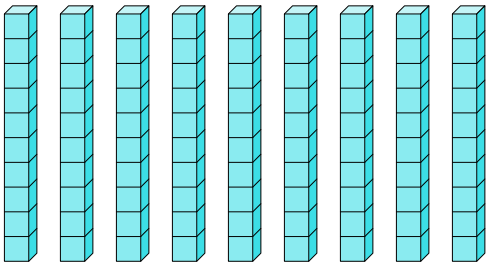

5)

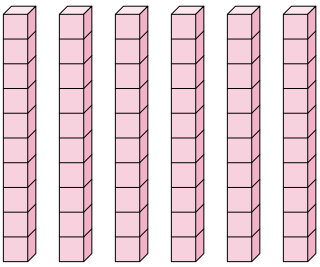

6)



7)

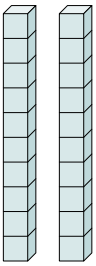

8)

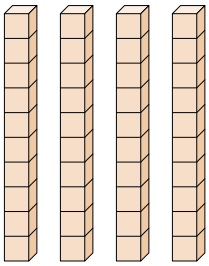

Answers

1.	8	80
2.	3	30
3.	7	70
4.	9	90
5.	6	60
6.	5	50
7.	2	20
8.	4	40

1-8	88	75	63	50	38	25	13	0

Counting Groups of Ten

Name:

Determine the quantity of groups of ten. Then find the total number of smaller blocks.

1)

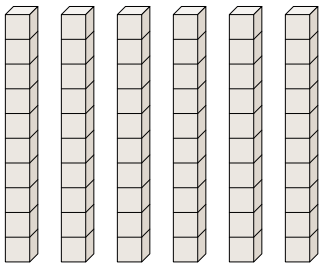

2)

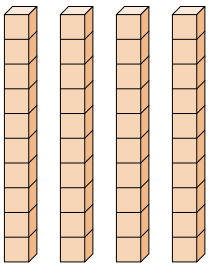

3)

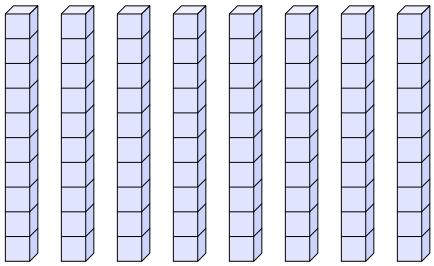

4)

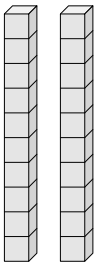

5)

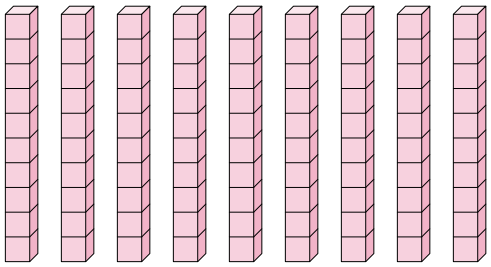

6)



7)

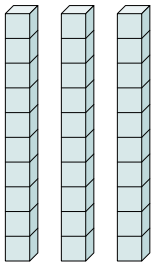

8)

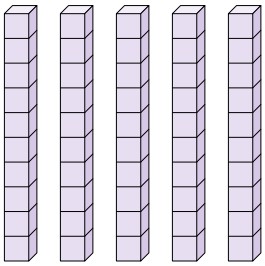

Answers

1. _____ _____
2. _____ _____
3. _____ _____
4. _____ _____
5. _____ _____
6. _____ _____
7. _____ _____
8. _____ _____

1-8	88	75	63	50	38	25	13	0

Counting Groups of Ten

Name: **Answer Key**

Determine the quantity of groups of ten. Then find the total number of smaller blocks.

1)

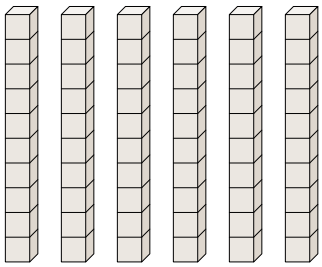

2)

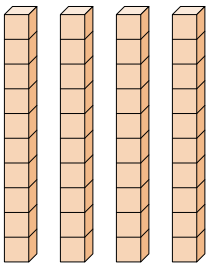

3)

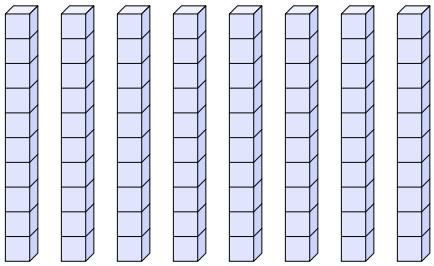

4)

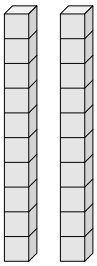

5)

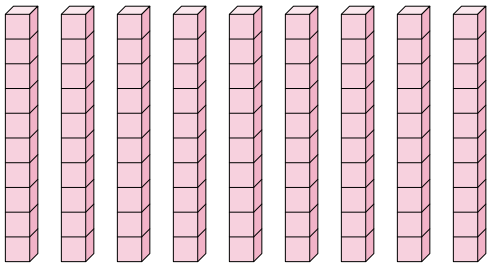

6)



7)

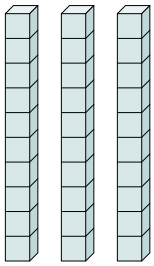

8)

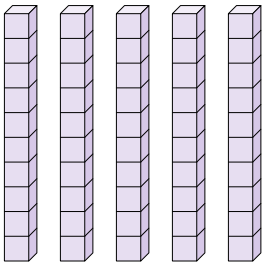

Answers

1.	6	60
2.	4	40
3.	8	80
4.	2	20
5.	9	90
6.	7	70
7.	3	30
8.	5	50

1-8	88	75	63	50	38	25	13	0

Counting Groups of Ten

Name:

Determine the quantity of groups of ten. Then find the total number of smaller blocks.

1)

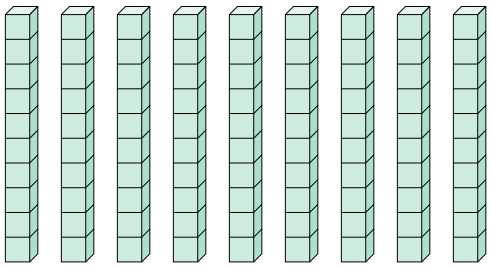

2)

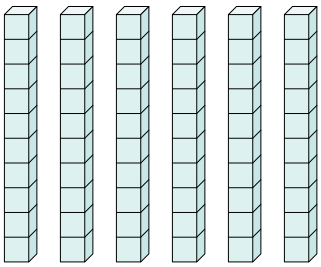

3)

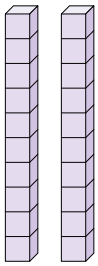

4)

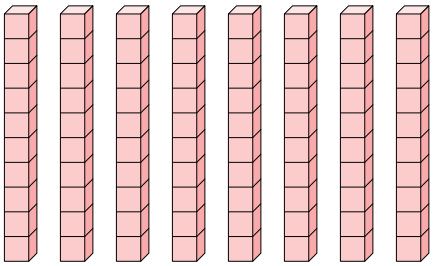

5)

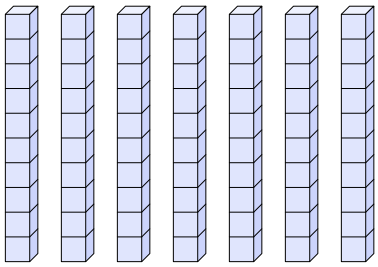

6)

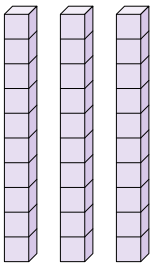

7)

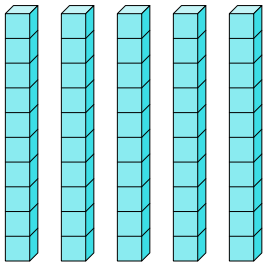

8)

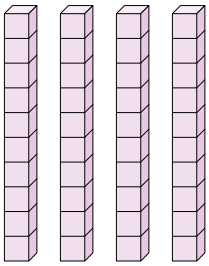

Answers

1. _____ _____
2. _____ _____
3. _____ _____
4. _____ _____
5. _____ _____
6. _____ _____
7. _____ _____
8. _____ _____

1-8	88	75	63	50	38	25	13	0

Counting Groups of Ten

Name: **Answer Key**

Determine the quantity of groups of ten. Then find the total number of smaller blocks.

1)

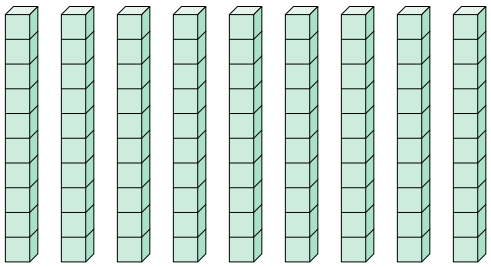

2)

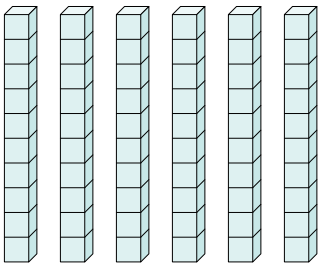

3)

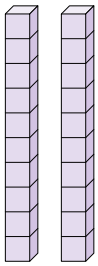

4)

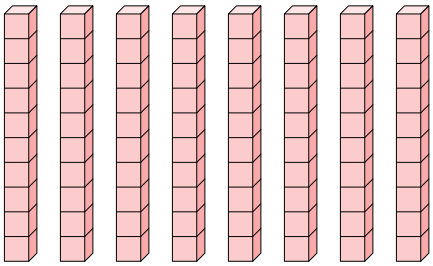

5)

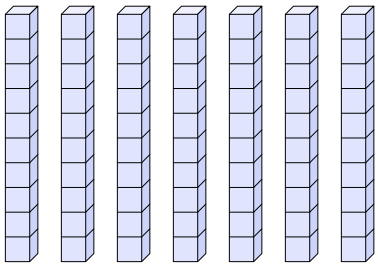

6)

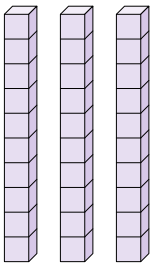

7)

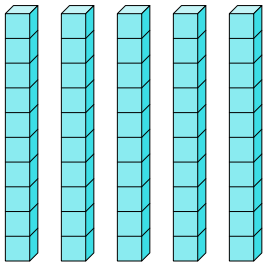

8)

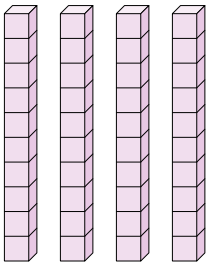

Answers

1.	9	90
2.	6	60
3.	2	20
4.	8	80
5.	7	70
6.	3	30
7.	5	50
8.	4	40

1-8	88	75	63	50	38	25	13	0

Counting Groups of Ten

Name:

Determine the quantity of groups of ten. Then find the total number of smaller blocks.

1)



2)

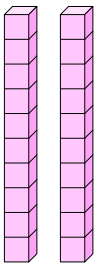

3)

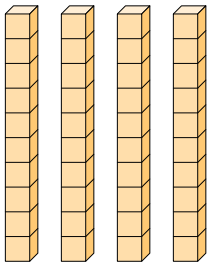

4)

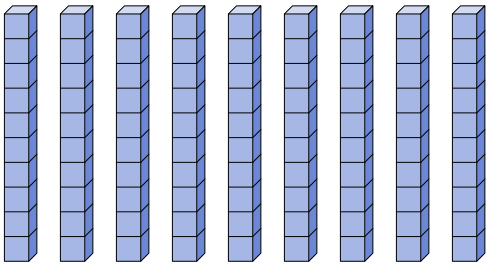

5)

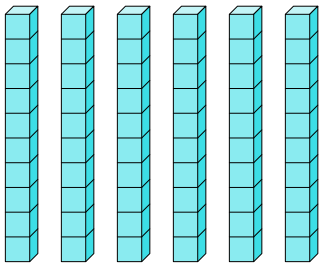

6)

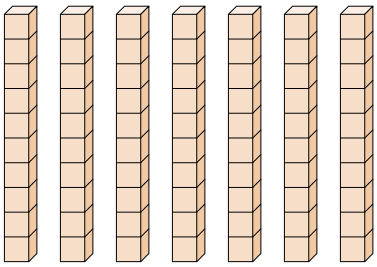

7)

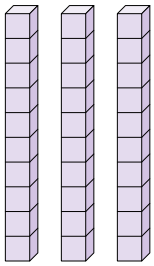

8)

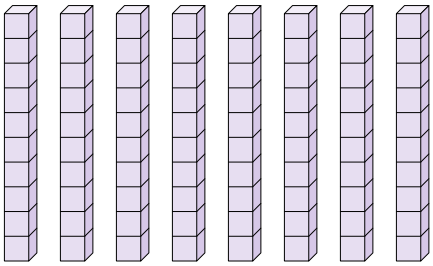

Answers

1. _____ _____
2. _____ _____
3. _____ _____
4. _____ _____
5. _____ _____
6. _____ _____
7. _____ _____
8. _____ _____

1-8	88	75	63	50	38	25	13	0

Counting Groups of Ten

Name: **Answer Key**

Determine the quantity of groups of ten. Then find the total number of smaller blocks.

1)



2)

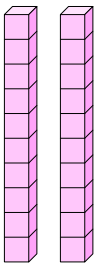

3)

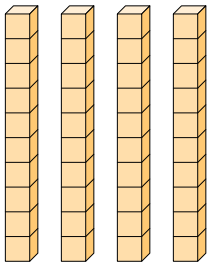

4)

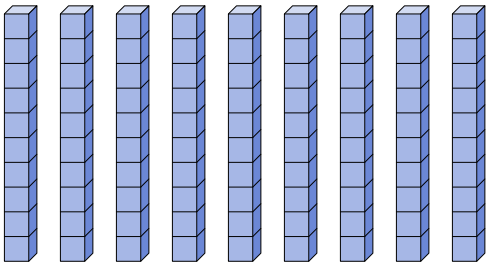

5)

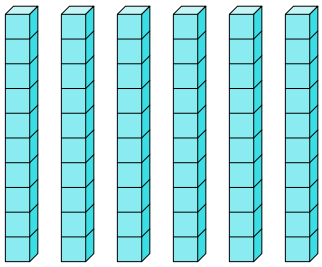

6)

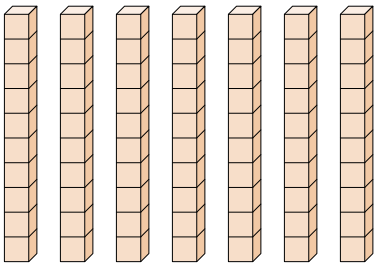

7)

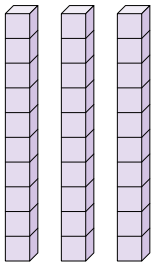

8)

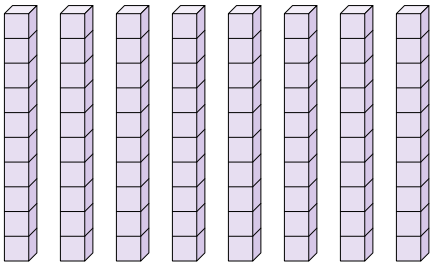

Answers

1.	5	50
2.	2	20
3.	4	40
4.	9	90
5.	6	60
6.	7	70
7.	3	30
8.	8	80

1-8	88	75	63	50	38	25	13	0

Counting Groups of Ten

Name:

Determine the quantity of groups of ten. Then find the total number of smaller blocks.

1)

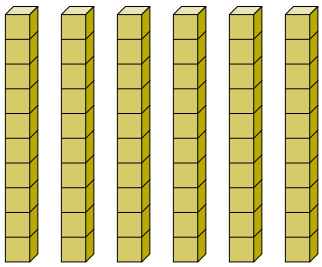

2)

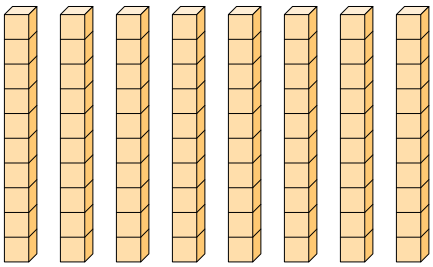

3)

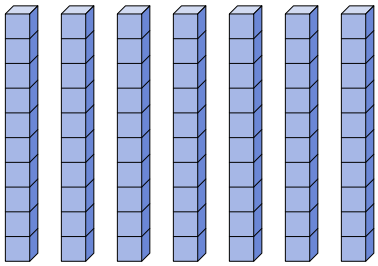

4)



5)

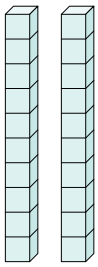

6)

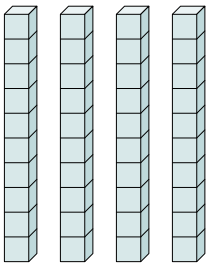

7)

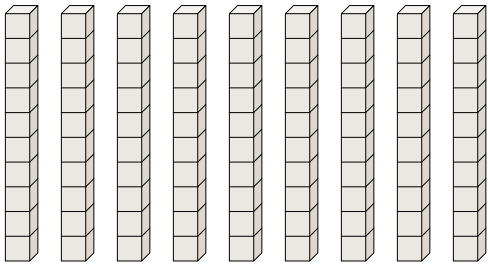

8)

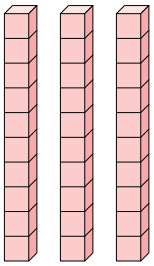

Answers

1. _____ _____
2. _____ _____
3. _____ _____
4. _____ _____
5. _____ _____
6. _____ _____
7. _____ _____
8. _____ _____

1-8	88	75	63	50	38	25	13	0

Counting Groups of Ten

Name: **Answer Key**

Determine the quantity of groups of ten. Then find the total number of smaller blocks.

1)

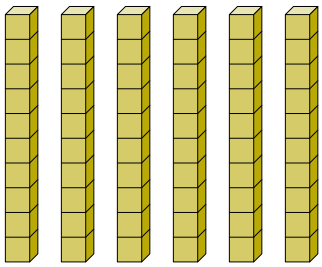

2)

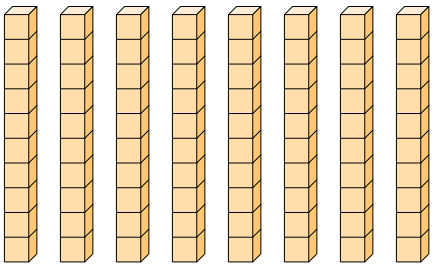

3)

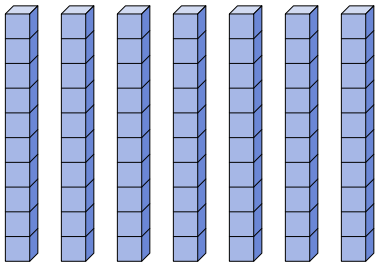

4)



5)

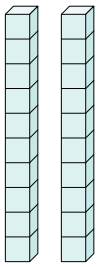

6)

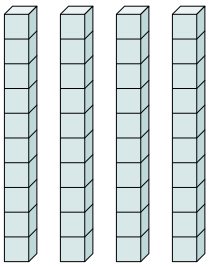

7)

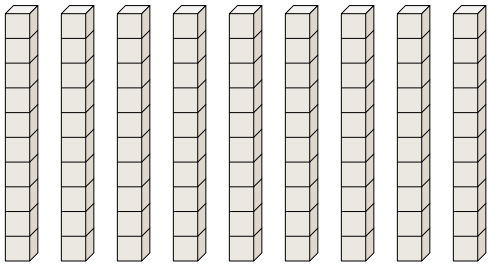

8)

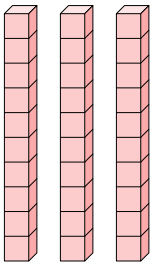

Answers

1.	6	60
2.	8	80
3.	7	70
4.	5	50
5.	2	20
6.	4	40
7.	9	90
8.	3	30

1-8	88	75	63	50	38	25	13	0