Finding Volume Of Rectangular Prisms

Name:

Find the volume of each of the rectangular prisms. Measured in cm (not to scale).

1)

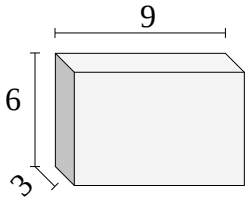

2)

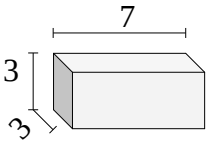

3)

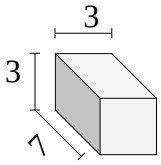

4)

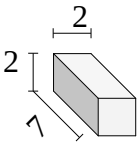

5)

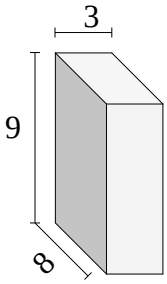

6)

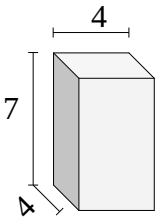

7)

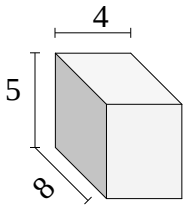

8)

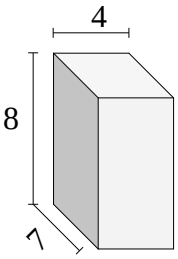

9)

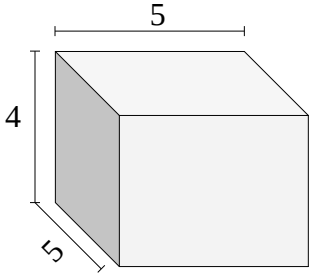

10)

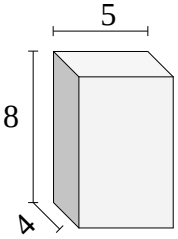

Answers

1. _____
2. _____
3. _____
4. _____
5. _____
6. _____
7. _____
8. _____
9. _____
10. _____

1-10	90	80	70	60	50	40	30	20	10	0

Finding Volume Of Rectangular Prisms

Name: **Answer Key**

Find the volume of each of the rectangular prisms. Measured in cm (not to scale).

1)

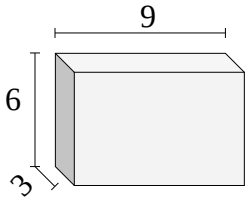

2)

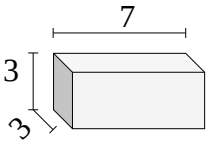

3)

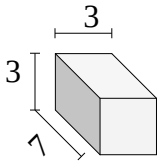

4)

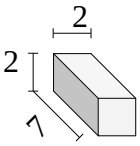

5)

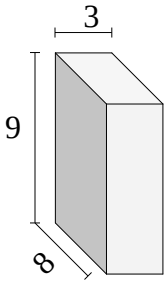

6)

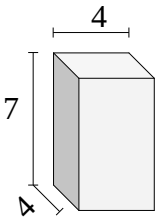

7)

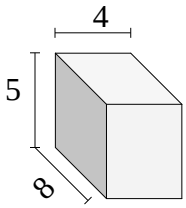

8)

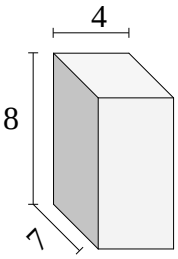

9)

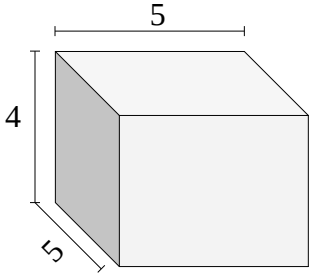

10)

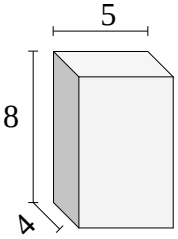

Answers

1. 162
2. 63
3. 63
4. 28
5. 216
6. 112
7. 160
8. 224
9. 100
10. 160

1-10	90	80	70	60	50	40	30	20	10	0

Finding Volume Of Rectangular Prisms

Name:

Find the volume of each of the rectangular prisms. Measured in cm (not to scale).

1)

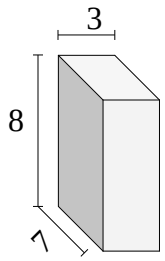

2)

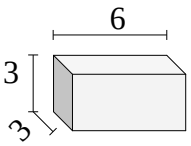

3)

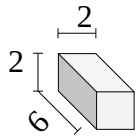

4)

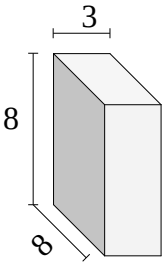

5)

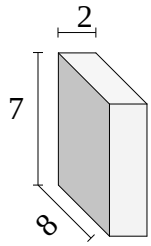

6)

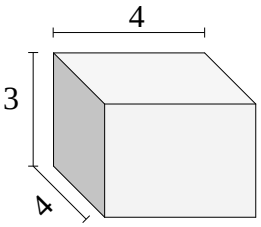

7)

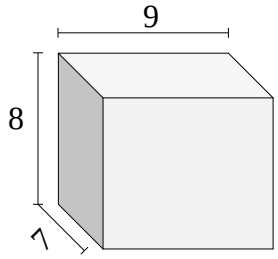

8)

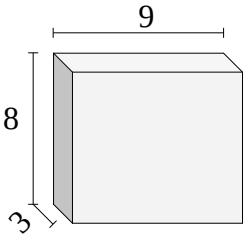

9)

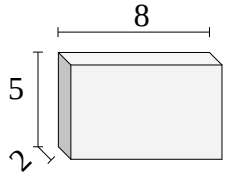

10)

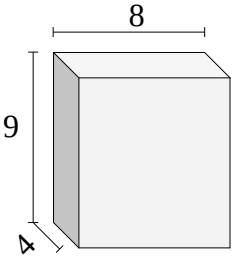

Answers

1. _____
2. _____
3. _____
4. _____
5. _____
6. _____
7. _____
8. _____
9. _____
10. _____

1-10	90	80	70	60	50	40	30	20	10	0

Finding Volume Of Rectangular Prisms

Name: **Answer Key**

Find the volume of each of the rectangular prisms. Measured in cm (not to scale).

1)

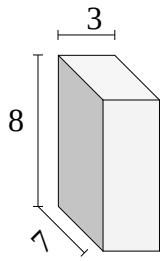

2)

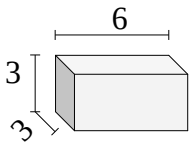

3)

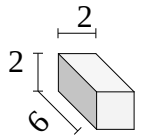

4)

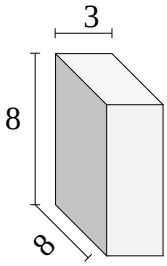

5)

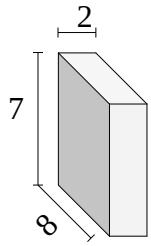

6)

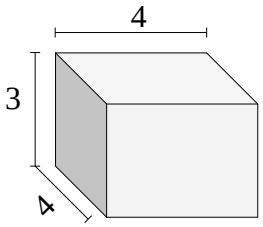

7)

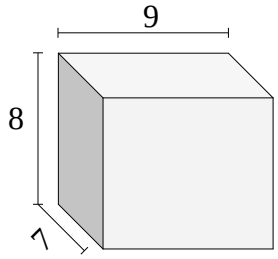

8)

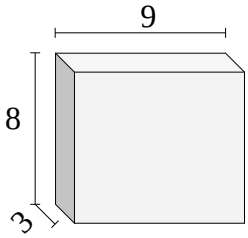

9)

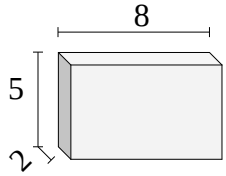

10)

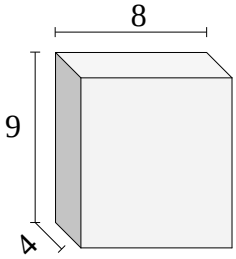

Answers

1. **168**
2. **54**
3. **24**
4. **192**
5. **112**
6. **48**
7. **504**
8. **216**
9. **80**
10. **288**

1-10	90	80	70	60	50	40	30	20	10	0

Finding Volume Of Rectangular Prisms

Name:

Find the volume of each of the rectangular prisms. Measured in cm (not to scale).

1)

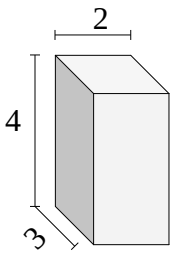

2)

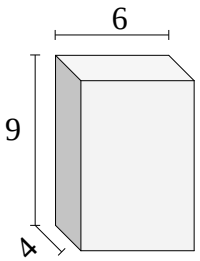

3)

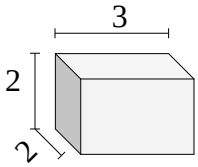

4)

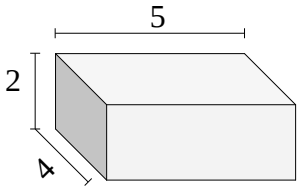

5)

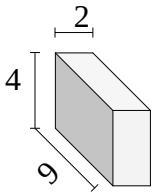

6)

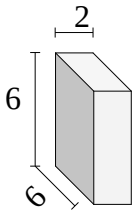

7)

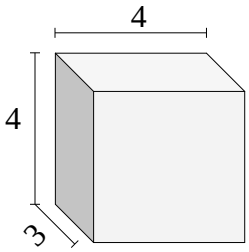

8)

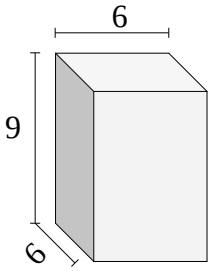

9)

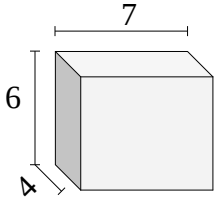

10)

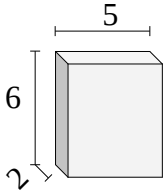

Answers

1. _____
2. _____
3. _____
4. _____
5. _____
6. _____
7. _____
8. _____
9. _____
10. _____

1-10	90	80	70	60	50	40	30	20	10	0

Finding Volume Of Rectangular Prisms Name: **Answer Key**

Find the volume of each of the rectangular prisms. Measured in cm (not to scale).

1)

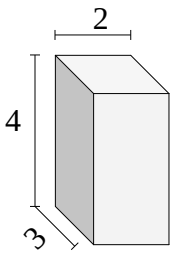

2)

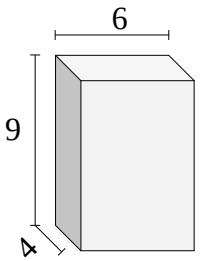

3)

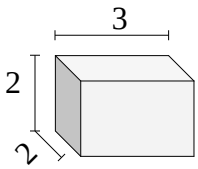

4)

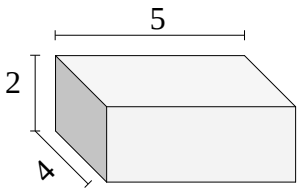

5)

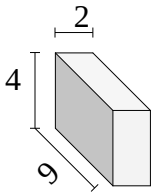

6)

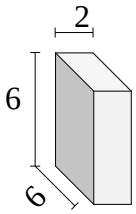

7)

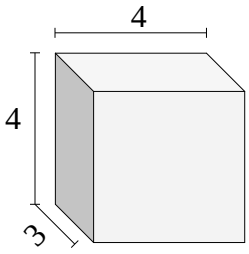

8)

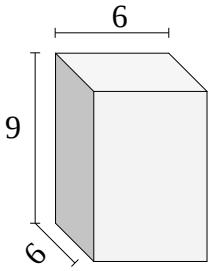

9)

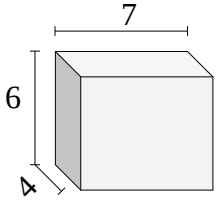

10)

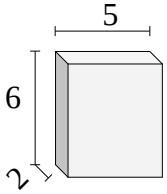

Answers

1. **24**
2. **216**
3. **12**
4. **40**
5. **72**
6. **72**
7. **48**
8. **324**
9. **168**
10. **60**

1-10	90	80	70	60	50	40	30	20	10	0

Finding Volume Of Rectangular Prisms

Name:

Find the volume of each of the rectangular prisms. Measured in cm (not to scale).

1)

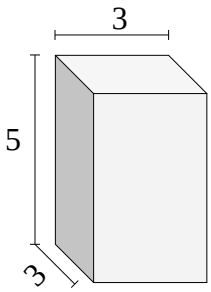

2)

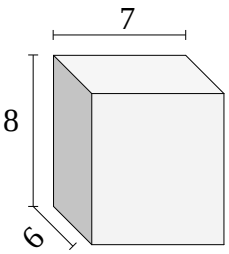

3)

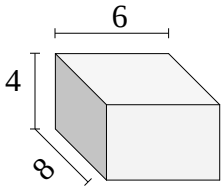

4)

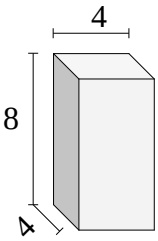

5)

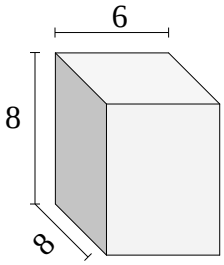

6)

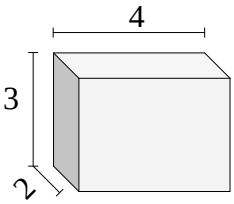

7)

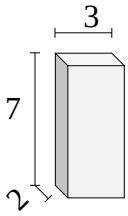

8)

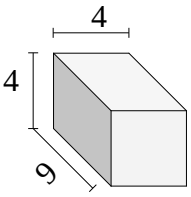

9)

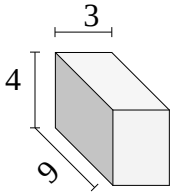

10)

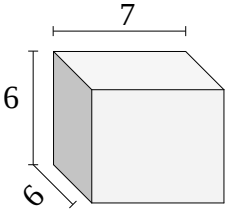

Answers

1. _____
2. _____
3. _____
4. _____
5. _____
6. _____
7. _____
8. _____
9. _____
10. _____

1-10	90	80	70	60	50	40	30	20	10	0

Finding Volume Of Rectangular Prisms Name: **Answer Key**

Find the volume of each of the rectangular prisms. Measured in cm (not to scale).

1)

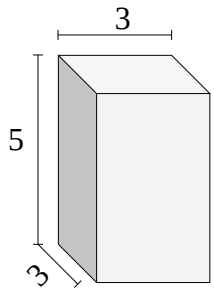

2)

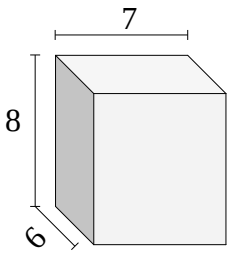

3)

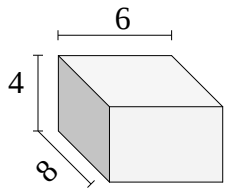

4)

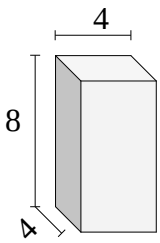

5)

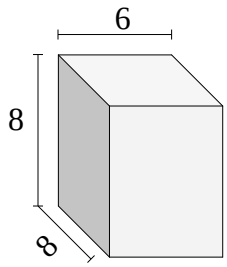

6)

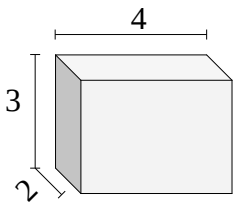

7)

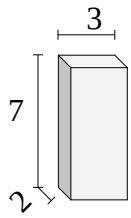

8)

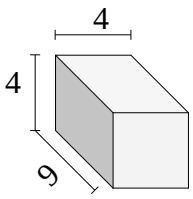

9)

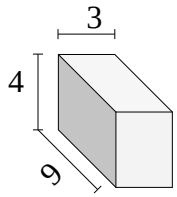

10)

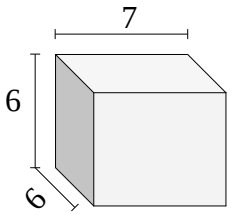

Answers

1. **45**
2. **336**
3. **192**
4. **128**
5. **384**
6. **24**
7. **42**
8. **144**
9. **108**
10. **252**

1-10	90	80	70	60	50	40	30	20	10	0

Finding Volume Of Rectangular Prisms

Name:

Find the volume of each of the rectangular prisms. Measured in cm (not to scale).

1)

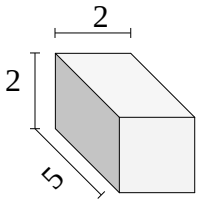

2)

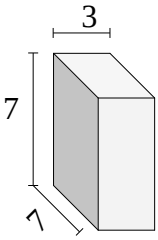

3)

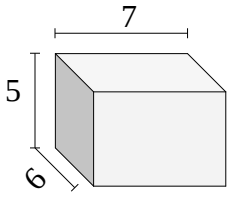

4)

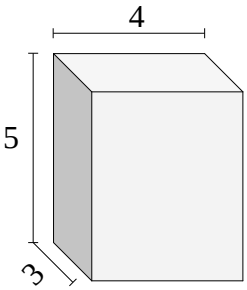

5)

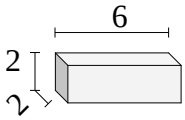

6)

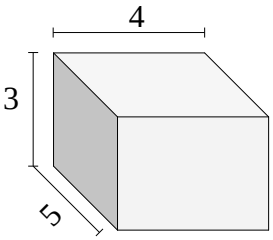

7)

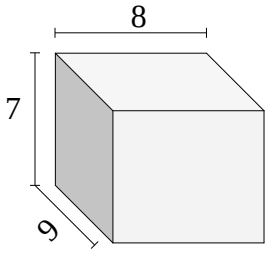

8)

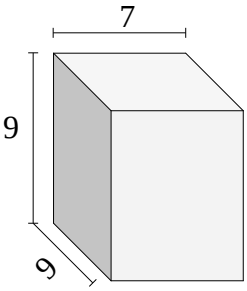

9)

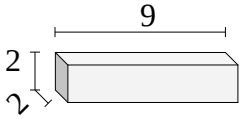

10)

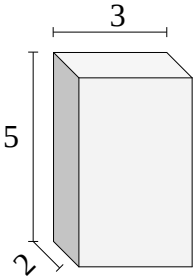

Answers

1. _____
2. _____
3. _____
4. _____
5. _____
6. _____
7. _____
8. _____
9. _____
10. _____

1-10	90	80	70	60	50	40	30	20	10	0

Finding Volume Of Rectangular Prisms Name: **Answer Key**

Find the volume of each of the rectangular prisms. Measured in cm (not to scale).

1)

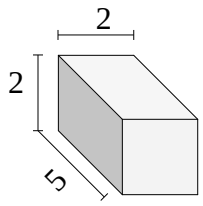

2)

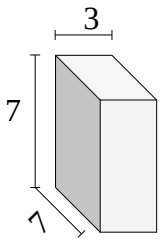

3)

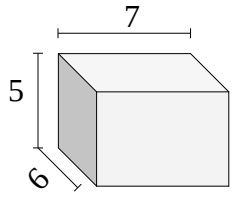

4)

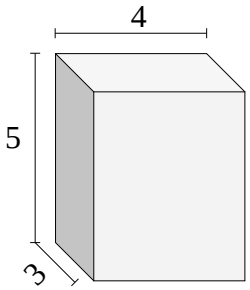

5)

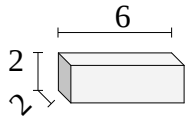

6)

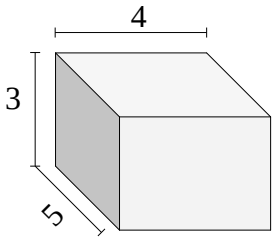

7)

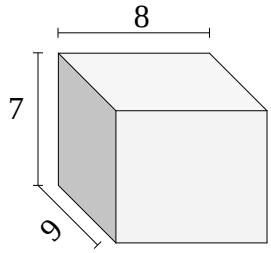

8)

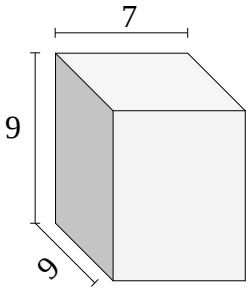

9)

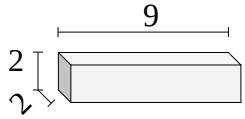

10)

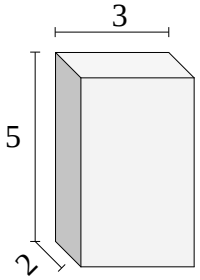

Answers

1. **20**
2. **147**
3. **210**
4. **60**
5. **24**
6. **60**
7. **504**
8. **567**
9. **36**
10. **30**

1-10	90	80	70	60	50	40	30	20	10	0

Finding Volume Of Rectangular Prisms

Name:

Find the volume of each of the rectangular prisms. Measured in cm (not to scale).

1)

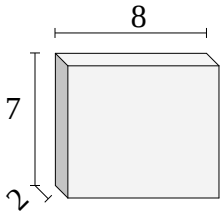

2)

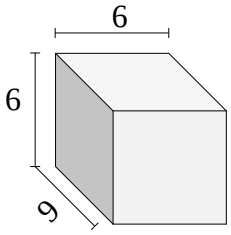

3)

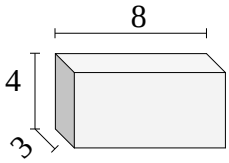

4)

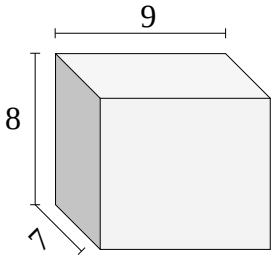

5)

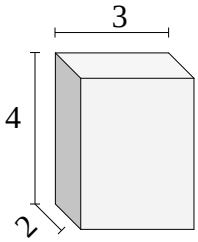

6)

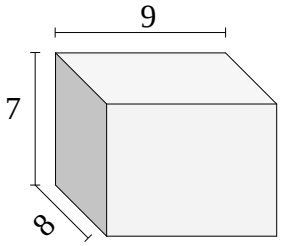

7)

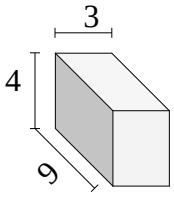

8)

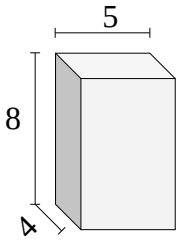

9)

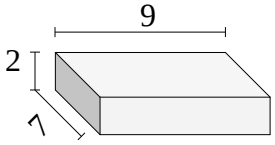

10)

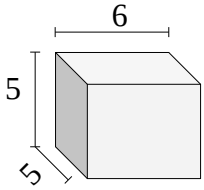

Answers

1. _____
2. _____
3. _____
4. _____
5. _____
6. _____
7. _____
8. _____
9. _____
10. _____

1-10	90	80	70	60	50	40	30	20	10	0

Finding Volume Of Rectangular Prisms Name: **Answer Key**

Find the volume of each of the rectangular prisms. Measured in cm (not to scale).

1)

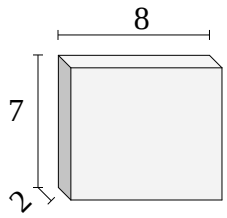

2)

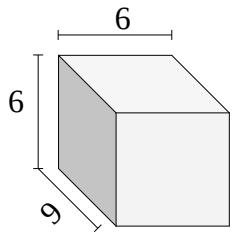

3)

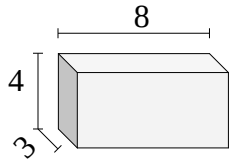

4)

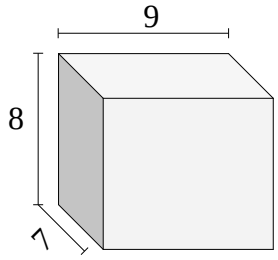

5)

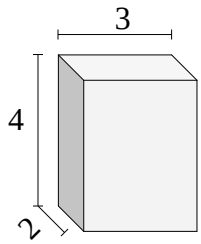

6)

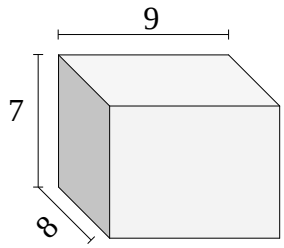

7)

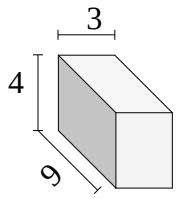

8)

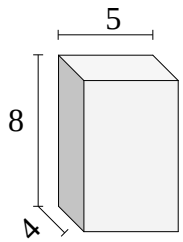

9)

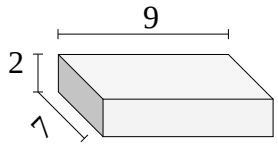

10)

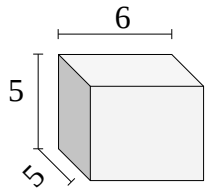

Answers

1. 112
2. 324
3. 96
4. 504
5. 24
6. 504
7. 108
8. 160
9. 126
10. 150

1-10	90	80	70	60	50	40	30	20	10	0

Finding Volume Of Rectangular Prisms

Name:

Find the volume of each of the rectangular prisms. Measured in cm (not to scale).

1)

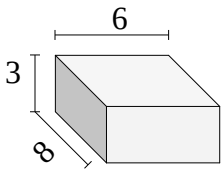

2)

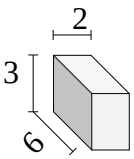

3)

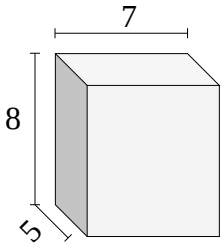

4)

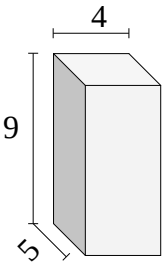

5)

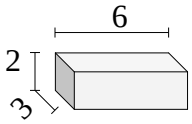

6)

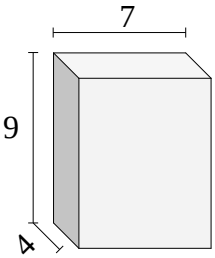

7)

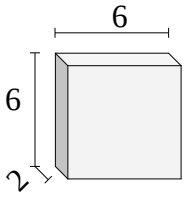

8)

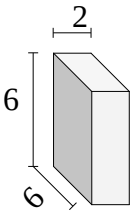

9)

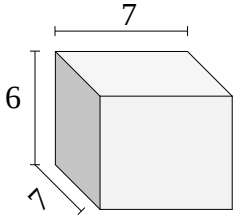

10)

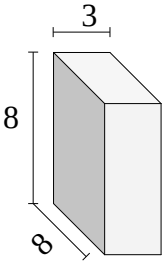

Answers

1. _____
2. _____
3. _____
4. _____
5. _____
6. _____
7. _____
8. _____
9. _____
10. _____

1-10	90	80	70	60	50	40	30	20	10	0

Finding Volume Of Rectangular Prisms Name: **Answer Key**

Find the volume of each of the rectangular prisms. Measured in cm (not to scale).

1)

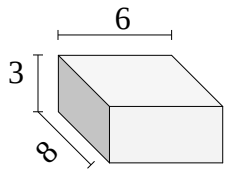

2)

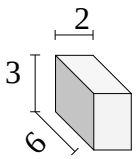

3)

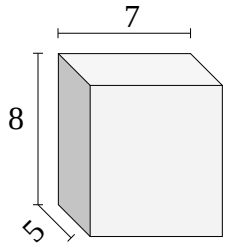

4)

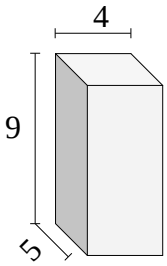

5)

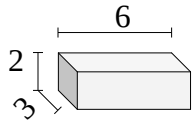

6)

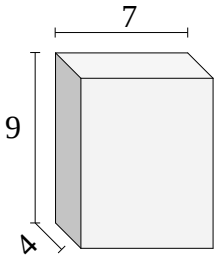

7)

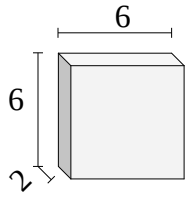

8)

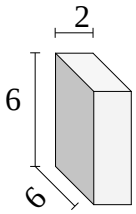

9)

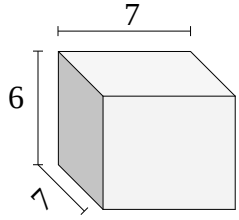

10)

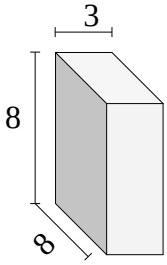

Answers

1. **144**
2. **36**
3. **280**
4. **180**
5. **36**
6. **252**
7. **72**
8. **72**
9. **294**
10. **192**

1-10	90	80	70	60	50	40	30	20	10	0

Finding Volume Of Rectangular Prisms

Name:

Find the volume of each of the rectangular prisms. Measured in cm (not to scale).

1)

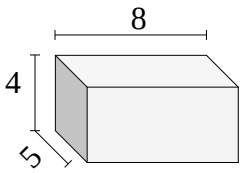

2)

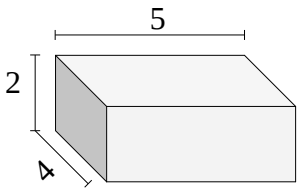

3)

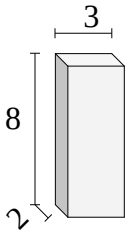

4)

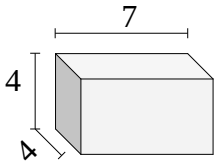

5)

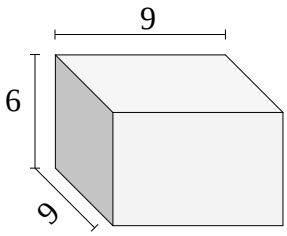

6)

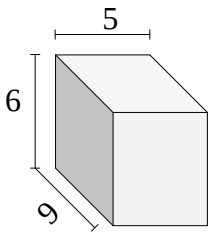

7)

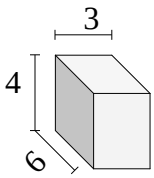

8)

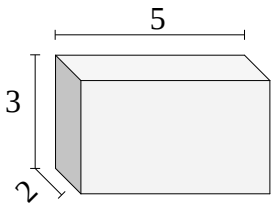

9)

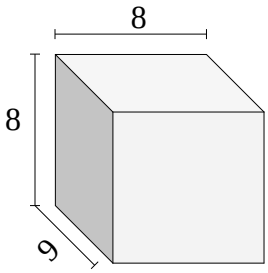

10)

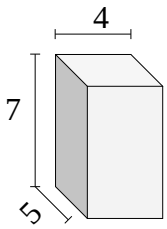

Answers

1. _____
2. _____
3. _____
4. _____
5. _____
6. _____
7. _____
8. _____
9. _____
10. _____

1-10	90	80	70	60	50	40	30	20	10	0

Finding Volume Of Rectangular Prisms

Name: **Answer Key**

Find the volume of each of the rectangular prisms. Measured in cm (not to scale).

1)

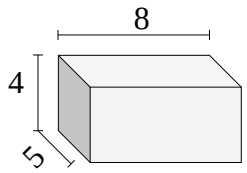

2)

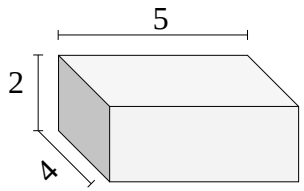

3)

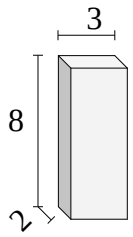

4)

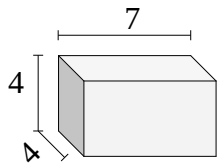

5)

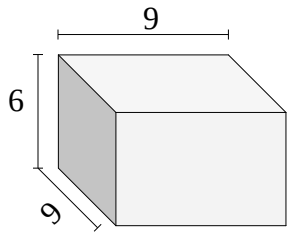

6)

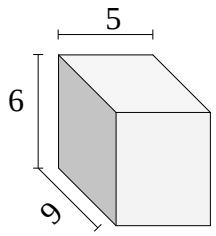

7)

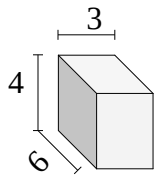

8)

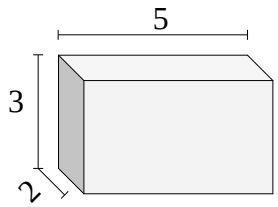

9)

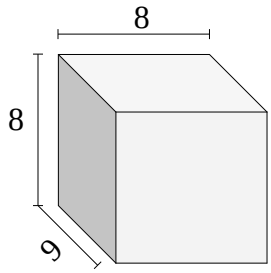

10)

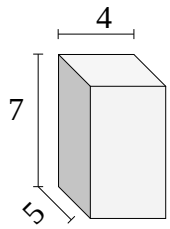

Answers

1. 160
2. 40
3. 48
4. 112
5. 486
6. 270
7. 72
8. 30
9. 576
10. 140

1-10	90	80	70	60	50	40	30	20	10	0

Finding Volume Of Rectangular Prisms

Name:

Find the volume of each of the rectangular prisms. Measured in cm (not to scale).

1)

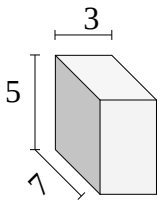

2)

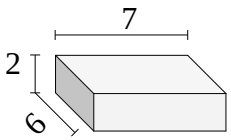

3)

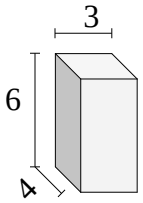

4)

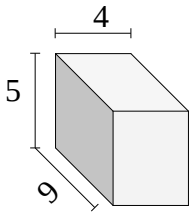

5)

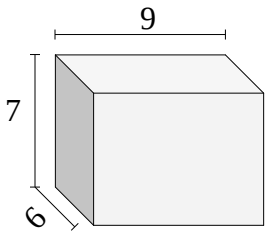

6)

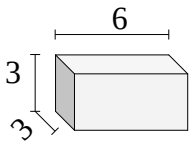

7)

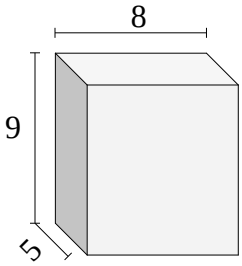

8)

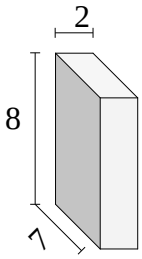

9)

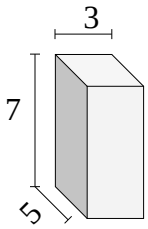

10)

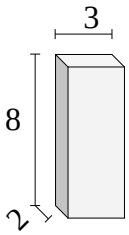

Answers

1. _____
2. _____
3. _____
4. _____
5. _____
6. _____
7. _____
8. _____
9. _____
10. _____

1-10	90	80	70	60	50	40	30	20	10	0

Finding Volume Of Rectangular Prisms Name: **Answer Key**

Find the volume of each of the rectangular prisms. Measured in cm (not to scale).

1)

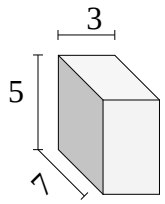

2)

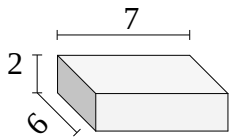

3)

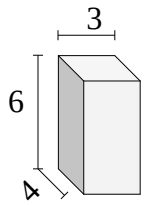

4)

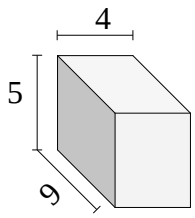

5)

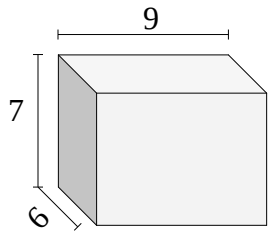

6)

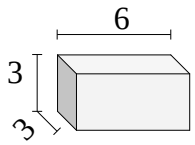

7)

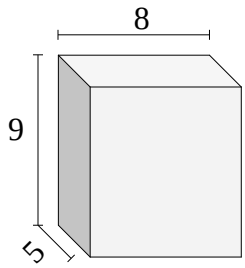

8)

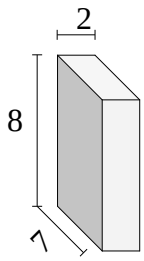

9)

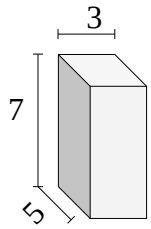

10)

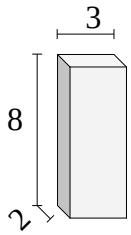

Answers

1. **105**
2. **84**
3. **72**
4. **180**
5. **378**
6. **54**
7. **360**
8. **112**
9. **105**
10. **48**

1-10	90	80	70	60	50	40	30	20	10	0

Finding Volume Of Rectangular Prisms

Name:

Find the volume of each of the rectangular prisms. Measured in cm (not to scale).

1)

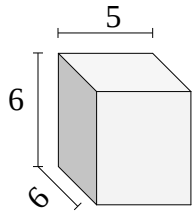

2)

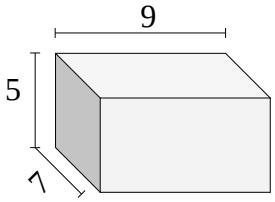

3)

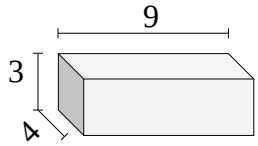

4)

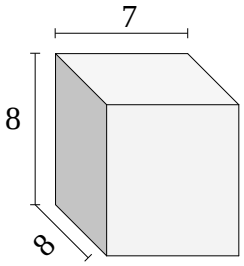

5)

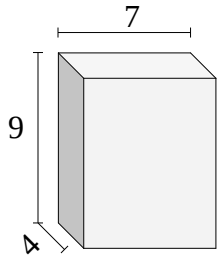

6)

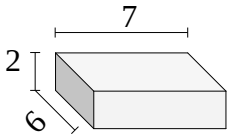

7)

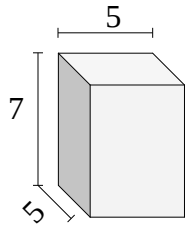

8)

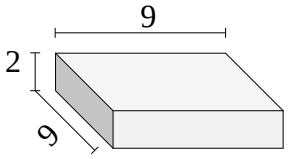

9)

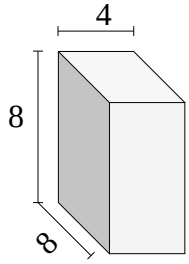

10)

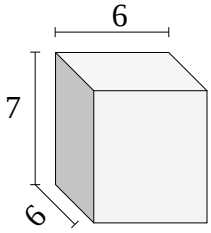

Answers

1. _____
2. _____
3. _____
4. _____
5. _____
6. _____
7. _____
8. _____
9. _____
10. _____

1-10	90	80	70	60	50	40	30	20	10	0

Finding Volume Of Rectangular Prisms Name: **Answer Key**

Find the volume of each of the rectangular prisms. Measured in cm (not to scale).

1)

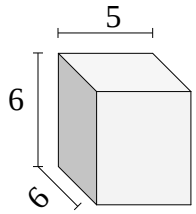

2)

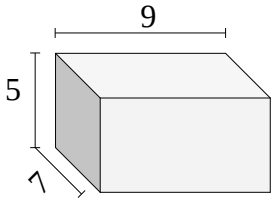

3)

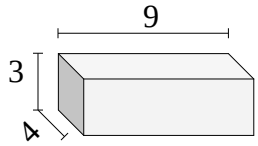

4)

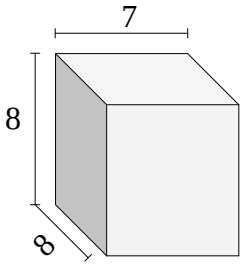

5)

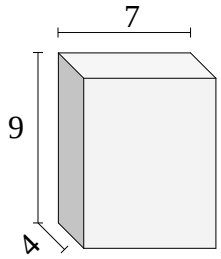

6)

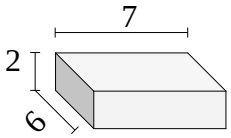

7)

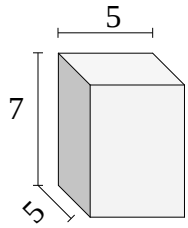

8)

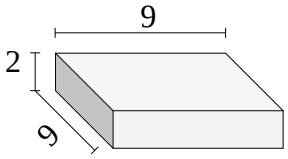

9)

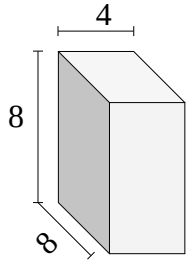

10)

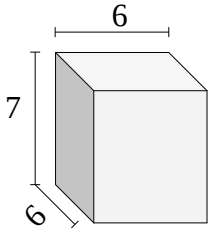

Answers

1. **180**
2. **315**
3. **108**
4. **448**
5. **252**
6. **84**
7. **175**
8. **162**
9. **256**
10. **252**

1-10	90	80	70	60	50	40	30	20	10	0