Finding Volume Of Rectangular Prisms

Name:

Find the volume of each of the rectangular prisms. Measured in cm (not to scale).

1)

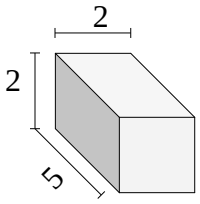

2)

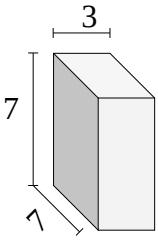

3)

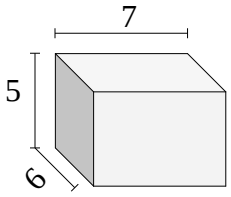

4)

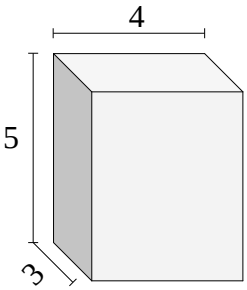

5)

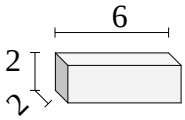

6)

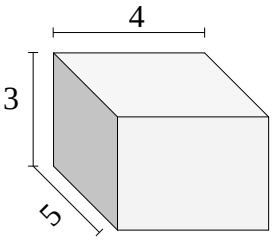

7)

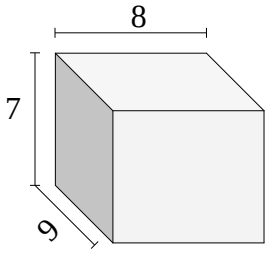

8)

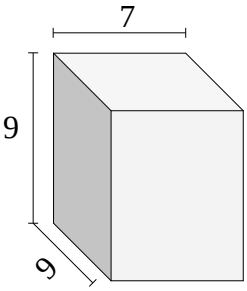

9)

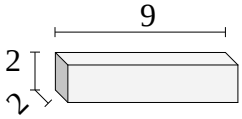

10)

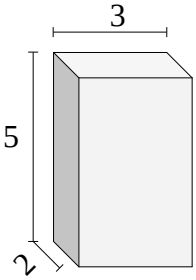

Answers

1. _____
2. _____
3. _____
4. _____
5. _____
6. _____
7. _____
8. _____
9. _____
10. _____

1-10	90	80	70	60	50	40	30	20	10	0

Finding Volume Of Rectangular Prisms Name: **Answer Key**

Find the volume of each of the rectangular prisms. Measured in cm (not to scale).

1)

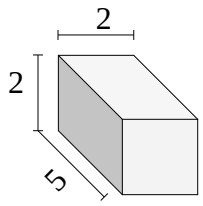

2)

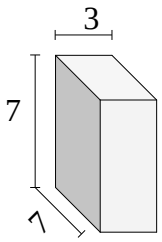

3)

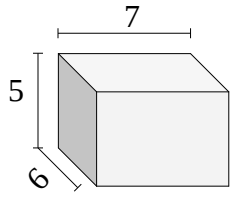

4)

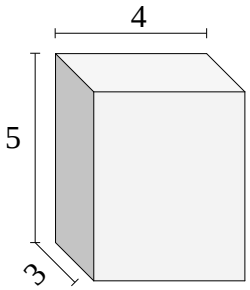

5)

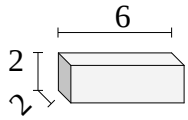

6)

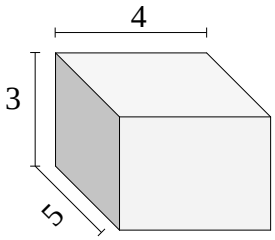

7)

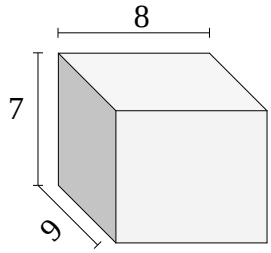

8)

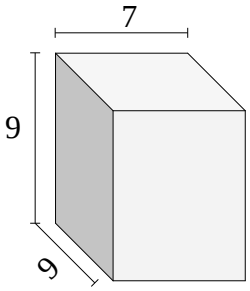

9)

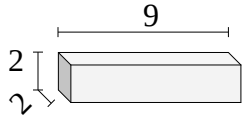

10)

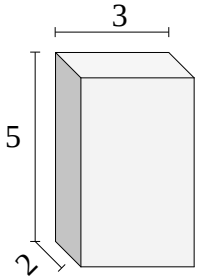

Answers

1. **20**
2. **147**
3. **210**
4. **60**
5. **24**
6. **60**
7. **504**
8. **567**
9. **36**
10. **30**

1-10	90	80	70	60	50	40	30	20	10	0