Identifying Smaller Units

Name:

Determine the number of smaller fractional pieces that can be made from the larger piece.

Ex) $9\frac{1}{2}$

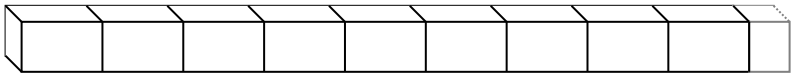

1) $9\frac{1}{2}$

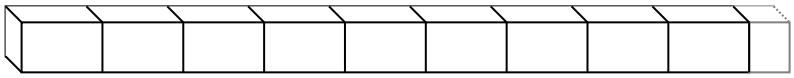

2) $3\frac{2}{3}$

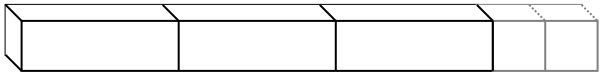

3) $9\frac{2}{3}$

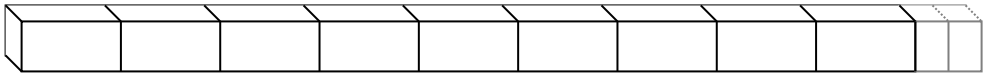

4) $7\frac{2}{4}$

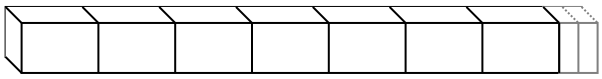

5) $2\frac{1}{2}$



6) $5\frac{2}{4}$

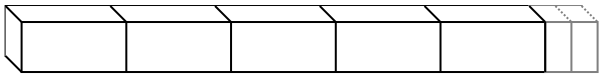

7) $4\frac{2}{4}$

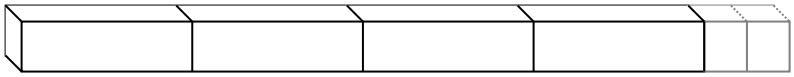

8) $4\frac{2}{3}$



9) $4\frac{1}{5}$

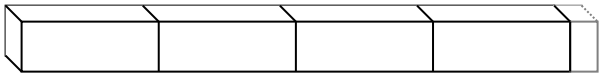

10) $8\frac{2}{3}$

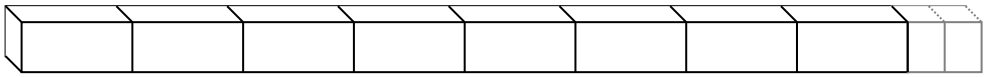

Answers

Ex. 19

1. _____
2. _____
3. _____
4. _____
5. _____
6. _____
7. _____
8. _____
9. _____
10. _____

1-10	90	80	70	60	50	40	30	20	10	0

Identifying Smaller Units

Name: **Answer Key**

Determine the number of smaller fractional pieces that can be made from the larger piece.

Ex) $9\frac{1}{2}$

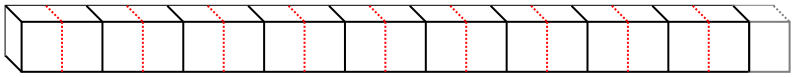

1) $9\frac{1}{2}$

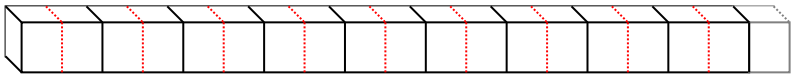

2) $3\frac{2}{3}$

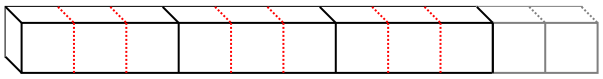

3) $9\frac{2}{3}$

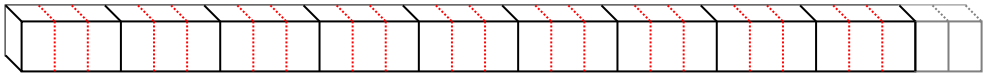

4) $7\frac{2}{4}$

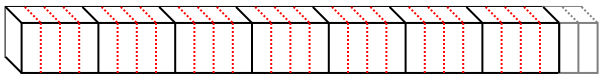

5) $2\frac{1}{2}$



6) $5\frac{2}{4}$

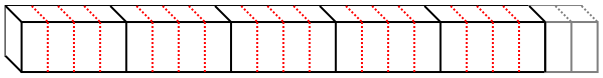

7) $4\frac{2}{4}$

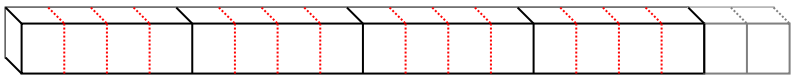

8) $4\frac{2}{3}$

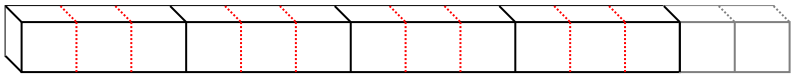

9) $4\frac{1}{5}$

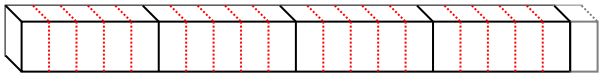

10) $8\frac{2}{3}$

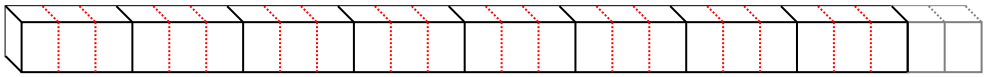

Answers

Ex.	19
1.	19
2.	11
3.	29
4.	30
5.	5
6.	22
7.	18
8.	14
9.	21
10.	26

1-10	90	80	70	60	50	40	30	20	10	0