Identifying Smaller Units

Name:

Determine the number of smaller fractional pieces that can be made from the larger piece.

Ex) $7\frac{1}{3}$

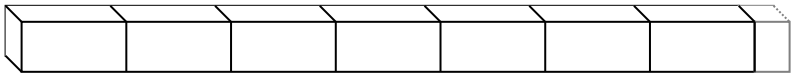

1) $8\frac{2}{3}$

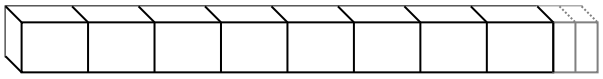

2) $3\frac{1}{3}$



3) $4\frac{1}{2}$

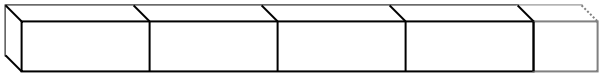

4) $9\frac{3}{4}$

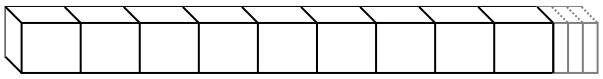

5) $4\frac{1}{2}$



6) $8\frac{2}{4}$

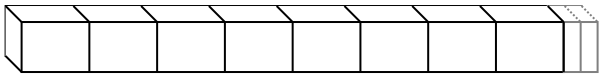

7) $7\frac{2}{3}$

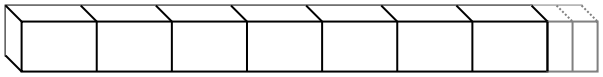

8) $4\frac{3}{4}$



9) $1\frac{1}{3}$



10) $8\frac{1}{3}$

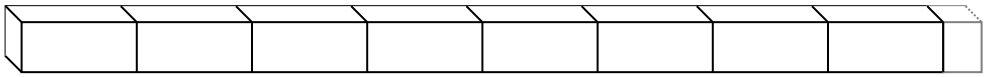

Answers

Ex. 22

1. _____
2. _____
3. _____
4. _____
5. _____
6. _____
7. _____
8. _____
9. _____
10. _____

1-10	90	80	70	60	50	40	30	20	10	0

Identifying Smaller Units

Name: **Answer Key**

Determine the number of smaller fractional pieces that can be made from the larger piece.

Ex) $7\frac{1}{3}$

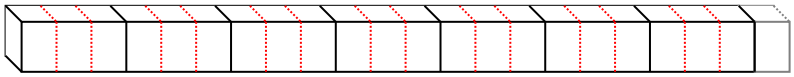

1) $8\frac{2}{3}$

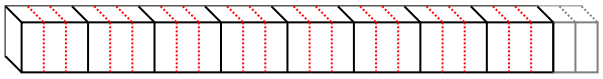

2) $3\frac{1}{3}$

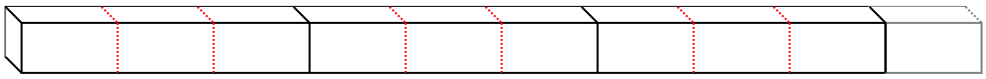

3) $4\frac{1}{2}$

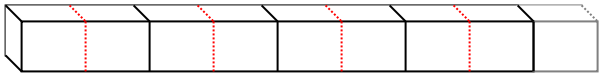

4) $9\frac{3}{4}$

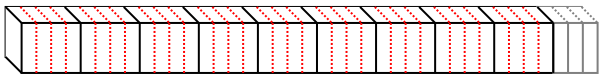

5) $4\frac{1}{2}$



6) $8\frac{2}{4}$

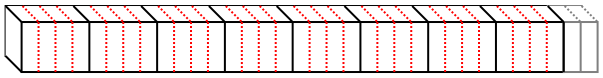

7) $7\frac{2}{3}$

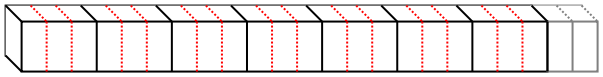

8) $4\frac{3}{4}$

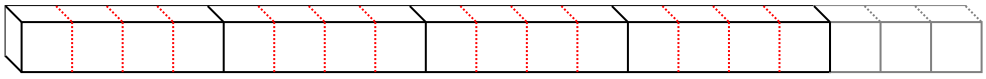

9) $1\frac{1}{3}$

10) $8\frac{1}{3}$

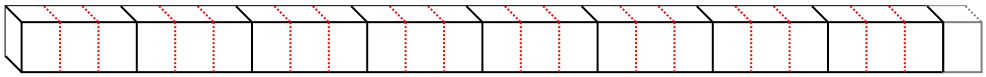

Answers

Ex.	22
1.	26
2.	10
3.	9
4.	39
5.	9
6.	34
7.	23
8.	19
9.	4
10.	25

1-10	90	80	70	60	50	40	30	20	10	0