Identifying Smaller Units Name:

Determine the number of smaller fractional pieces that can be made from the larger piece.

Ex) $4\frac{1}{2}$



1) $9\frac{1}{3}$

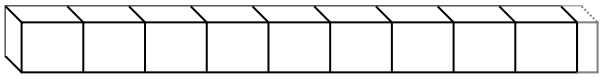

2) $3\frac{1}{2}$



3) $1\frac{1}{2}$



4) $2\frac{1}{3}$

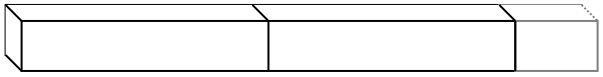

5) $6\frac{1}{2}$

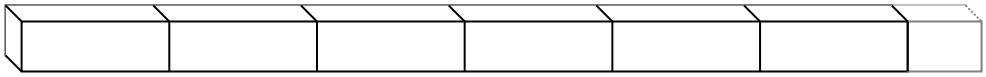

6) $3\frac{2}{4}$



7) $1\frac{3}{5}$



8) $7\frac{3}{5}$

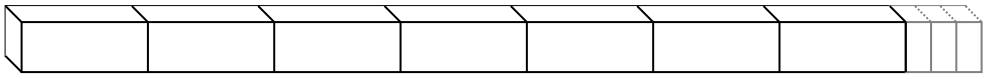

9) $6\frac{1}{4}$

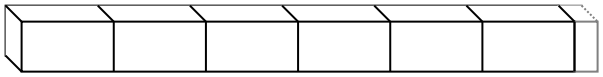

10) $3\frac{3}{4}$

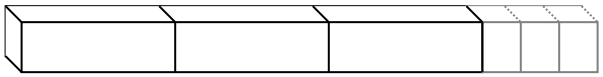

Answers

Ex. 9

1. _____
2. _____
3. _____
4. _____
5. _____
6. _____
7. _____
8. _____
9. _____
10. _____

1-10	90	80	70	60	50	40	30	20	10	0

Identifying Smaller Units

Name: **Answer Key**

Determine the number of smaller fractional pieces that can be made from the larger piece.

Ex) $4\frac{1}{2}$



1) $9\frac{1}{3}$

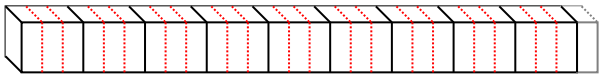

2) $3\frac{1}{2}$



3) $1\frac{1}{2}$



4) $2\frac{1}{3}$

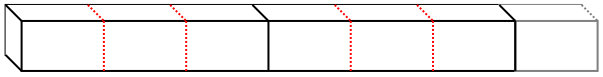

5) $6\frac{1}{2}$

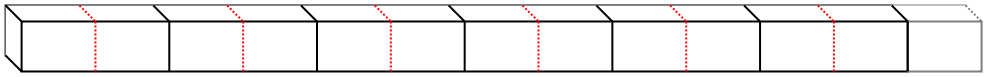

6) $3\frac{2}{4}$

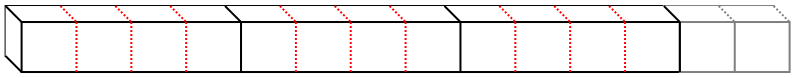

7) $1\frac{3}{5}$

8) $7\frac{3}{5}$

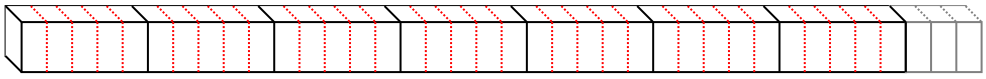

9) $6\frac{1}{4}$

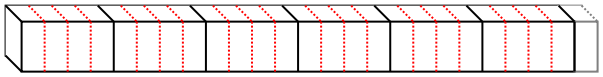

10) $3\frac{3}{4}$

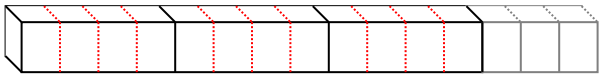

Answers

Ex.	9
1.	28
2.	7
3.	3
4.	7
5.	13
6.	14
7.	8
8.	38
9.	25
10.	15

1-10	90	80	70	60	50	40	30	20	10	0