Identifying Smaller Units

Name:

Determine the number of smaller fractional pieces that can be made from the larger piece.

Ex) $5\frac{3}{4}$

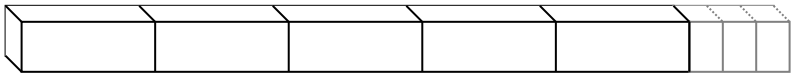

1) $9\frac{1}{5}$

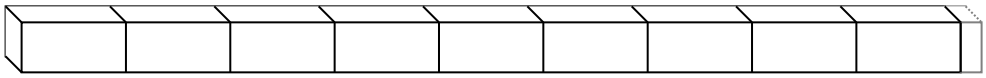

2) $8\frac{4}{5}$

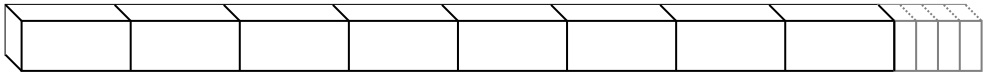

3) $4\frac{2}{5}$

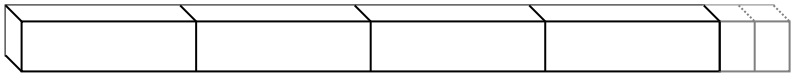

4) $7\frac{1}{3}$



5) $8\frac{2}{3}$

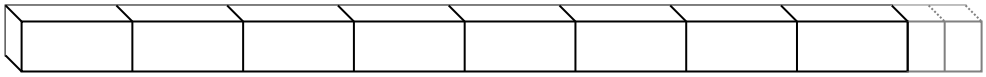

6) $2\frac{1}{3}$



7) $3\frac{2}{5}$



8) $9\frac{1}{5}$

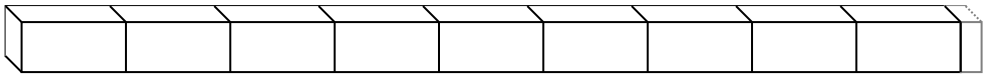

9) $9\frac{3}{4}$

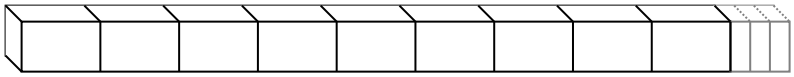

10) $1\frac{1}{2}$



Answers

Ex. 23

1. _____
2. _____
3. _____
4. _____
5. _____
6. _____
7. _____
8. _____
9. _____
10. _____

1-10	90	80	70	60	50	40	30	20	10	0

Identifying Smaller Units

Name: **Answer Key**

Determine the number of smaller fractional pieces that can be made from the larger piece.

Ex) $5\frac{3}{4}$

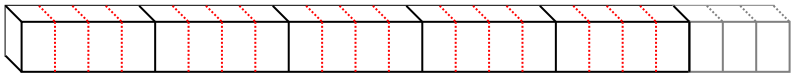

1) $9\frac{1}{5}$

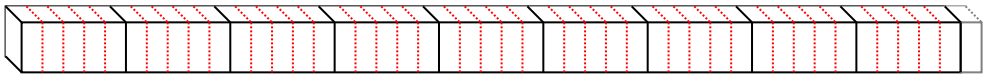

2) $8\frac{4}{5}$

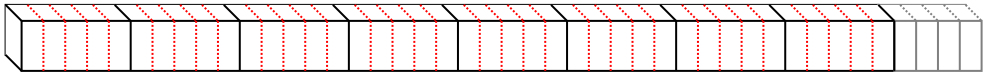

3) $4\frac{2}{5}$

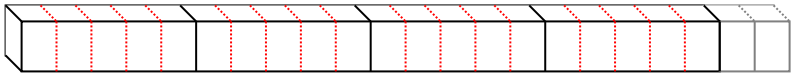

4) $7\frac{1}{3}$

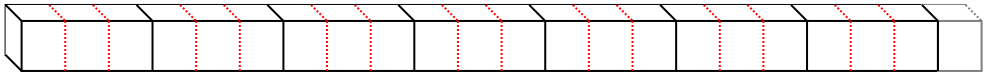

5) $8\frac{2}{3}$

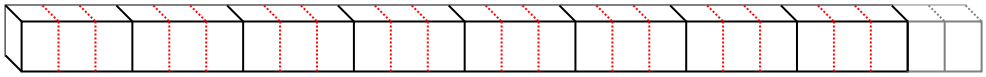

6) $2\frac{1}{3}$



7) $3\frac{2}{5}$

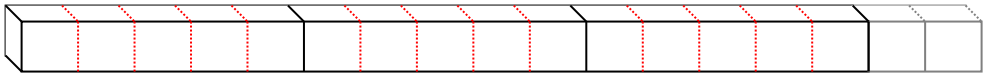

8) $9\frac{1}{5}$

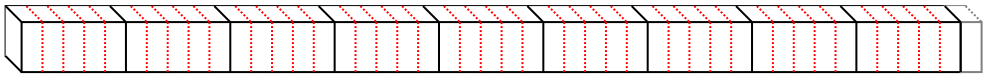

9) $9\frac{3}{4}$

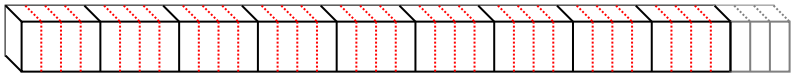

10) $1\frac{1}{2}$



Answers

Ex.	23
1.	46
2.	44
3.	22
4.	22
5.	26
6.	7
7.	17
8.	46
9.	39
10.	3

1-10	90	80	70	60	50	40	30	20	10	0