Completing and Matching Volume Equations

Name:

Match each problem with the equation that could represent it. Answer with the missing term and letter.

Ex) 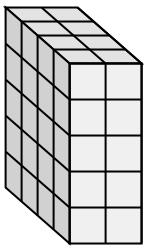

1) 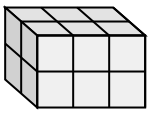

2) 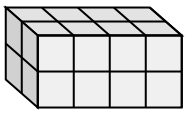

3) 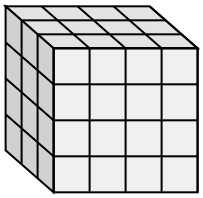

4) 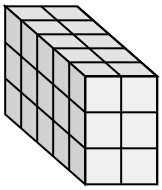

5) 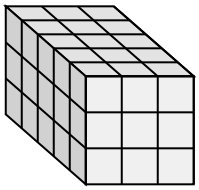

6) 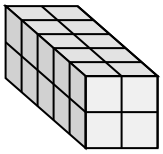

7) 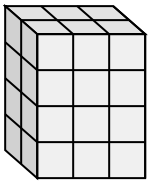

8) 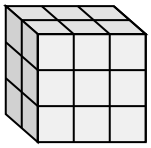

9) 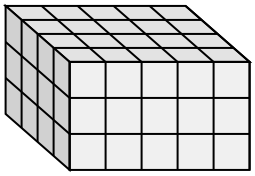

10) 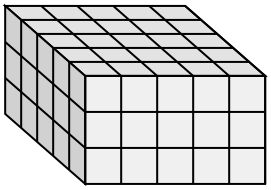

11) 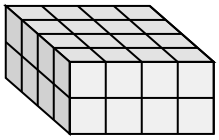

A. 5 × 3 × ___ = 45

B. 2 × ___ × 4 = 24

C. 2 × 3 × ___ = 12

D. 2 × 3 × 3 = ___

E. 4 × 4 × 2 = ___

F. ___ × 4 × 4 = 48

G. 4 × 5 × 3 = ___

H. ___ × 4 × 2 = 16

I. 5 × ___ × 3 = 75

J. 5 × ___ × 2 = 20

K. ___ × 2 × 3 = 30

L. 4 × 2 × 5 = ___

Answers

Ex. L , 40

1. _____
2. _____
3. _____
4. _____
5. _____
6. _____
7. _____
8. _____
9. _____
10. _____
11. _____

Completing and Matching Volume Equations Name: **Answer Key**

Match each problem with the equation that could represent it. Answer with the missing term and letter.

Ex) 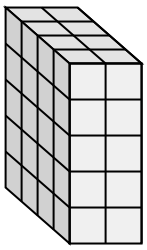

1) 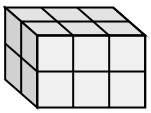

2) 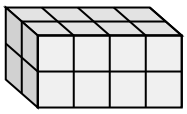

3) 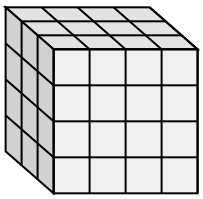

4) 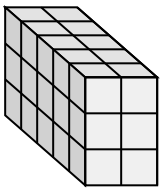

5) 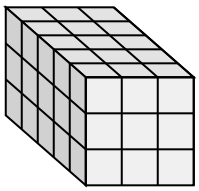

6) 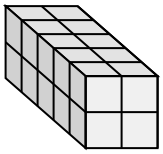

7) 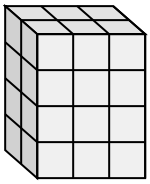

8) 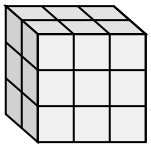

9) 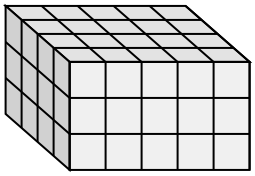

10) 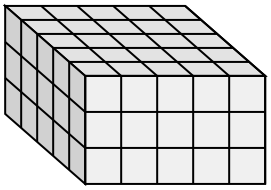

11) 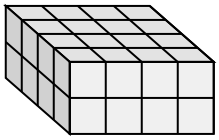

A. 5 × 3 × ___ = 45

B. 2 × ___ × 4 = 24

C. 2 × 3 × ___ = 12

D. 2 × 3 × 3 = ___

E. 4 × 4 × 2 = ___

F. ___ × 4 × 4 = 48

G. 4 × 5 × 3 = ___

H. ___ × 4 × 2 = 16

I. 5 × ___ × 3 = 75

J. 5 × ___ × 2 = 20

K. ___ × 2 × 3 = 30

L. 4 × 2 × 5 = ___

Answers

Ex.	L , 40
1.	C , 2
2.	H , 2
3.	F , 3
4.	K , 5
5.	A , 3
6.	J , 2
7.	B , 3
8.	D , 18
9.	G , 60
10.	I , 5
11.	E , 32