Completing and Matching Volume Equations

Name:

Match each problem with the equation that could represent it. Answer with the missing term and letter.

Ex)

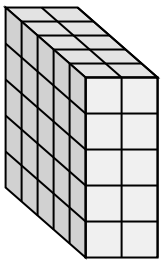

1)

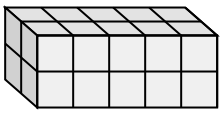

2)

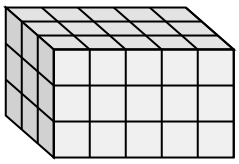

3)

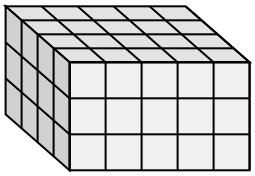

4)

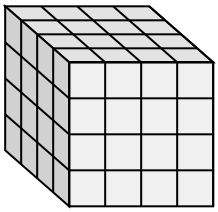

5)

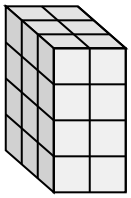

6)

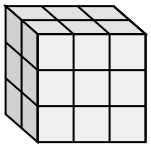

7)

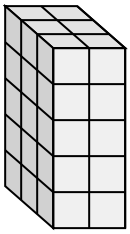

8)

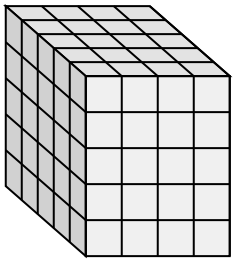

9)

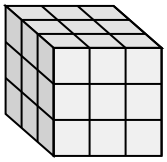

10)

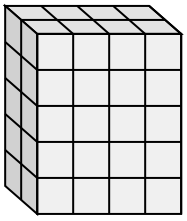

11)

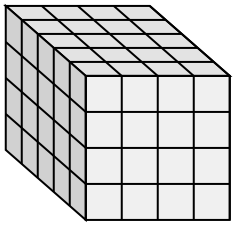

A. ___ × 2 × 5 = 30

B. ___ × 5 × 3 = 60

C. 3 × 3 × ___ = 27

D. 3 × 2 × ___ = 24

E. ___ × 4 × 5 = 100

F. 5 × ___ × 5 = 50

G. ___ × 4 × 4 = 64

H. 3 × 5 × ___ = 45

I. 2 × 5 × 2 = ___

J. ___ × 4 × 4 = 80

K. ___ × 3 × 3 = 18

L. 2 × 4 × ___ = 40

Answers

Ex. F , 2

1. _____
2. _____
3. _____
4. _____
5. _____
6. _____
7. _____
8. _____
9. _____
10. _____
11. _____

1-10	91	82	73	64	55	45	36	27	18	9
11	0									

Completing and Matching Volume Equations Name: **Answer Key**

Match each problem with the equation that could represent it. Answer with the missing term and letter.

Ex) 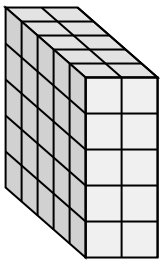

1) 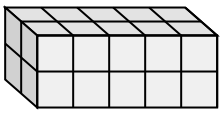

2) 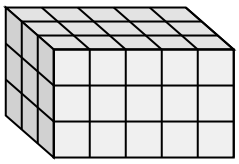

3) 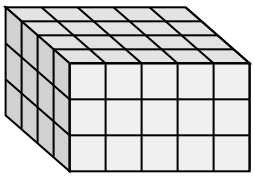

4) 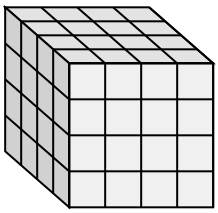

5) 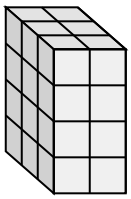

6) 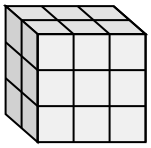

7) 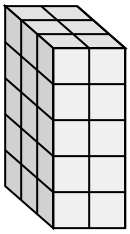

8) 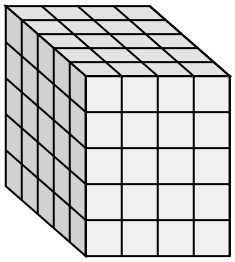

9) 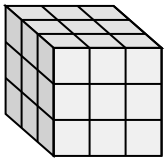

10) 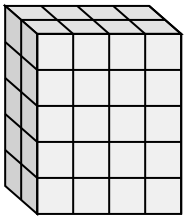

11) 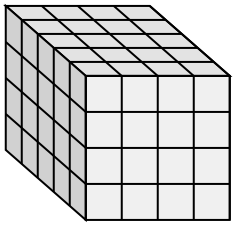

A. ___ × 2 × 5 = 30

B. ___ × 5 × 3 = 60

C. 3 × 3 × ___ = 27

D. 3 × 2 × ___ = 24

E. ___ × 4 × 5 = 100

F. 5 × ___ × 5 = 50

G. ___ × 4 × 4 = 64

H. 3 × 5 × ___ = 45

I. 2 × 5 × 2 = ___

J. ___ × 4 × 4 = 80

K. ___ × 3 × 3 = 18

L. 2 × 4 × ___ = 40

Answers

Ex. **F , 2**

1. **I , 20**
2. **H , 3**
3. **B , 4**
4. **G , 4**
5. **D , 4**
6. **K , 2**
7. **A , 3**
8. **E , 5**
9. **C , 3**
10. **L , 5**
11. **J , 5**

1-10	91	82	73	64	55	45	36	27	18	9
11	0									