Measuring and Showing Data Name:

Measure each paper_clip tip to tip then place your results in the line plot.

Ex)

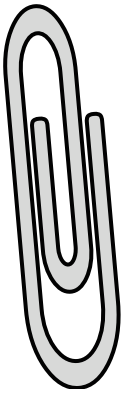

1)

2)

3)



4)

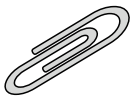

5)

6)

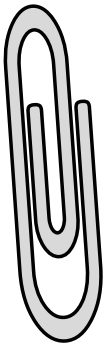

7)



8)

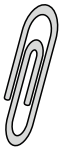

9)

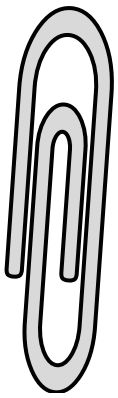

10)

11)

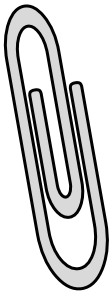

Line Plot

$\frac{1}{4}$	$\frac{1}{2}$	$\frac{3}{4}$	1	$1\frac{1}{4}$	$1\frac{1}{2}$	$1\frac{3}{4}$	2

Answers

Ex. 2

1. _____
2. _____
3. _____
4. _____
5. _____
6. _____
7. _____
8. _____
9. _____
10. _____
11. _____

1-10	91	82	73	64	55	45	36	27	18	9
11	0									

Measuring and Showing Data

Name: **Answer Key**

Measure each paper_clip tip to tip then place your results in the line plot.

Ex)

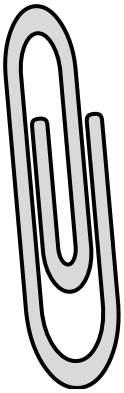

1)

2)

3)



4)

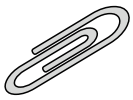

5)

6)

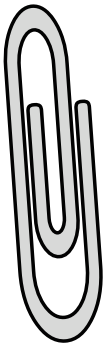

7)



8)

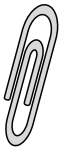

9)

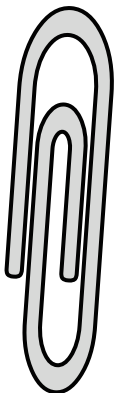

10)

11)

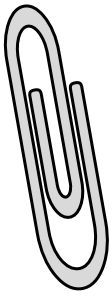

Line Plot

X		X			X		X
X	X	X	X	X	X	X	X
$\frac{1}{4}$	$\frac{1}{2}$	$\frac{3}{4}$	1	$1\frac{1}{4}$	$1\frac{1}{2}$	$1\frac{3}{4}$	2

Answers

Ex.	2
1.	$\frac{1}{2}$
2.	$\frac{1}{4}$
3.	$1\frac{1}{4}$
4.	$\frac{3}{4}$
5.	1
6.	$1\frac{3}{4}$
7.	$1\frac{1}{2}$
8.	$\frac{3}{4}$
9.	2
10.	$\frac{1}{4}$
11.	$1\frac{1}{2}$