Finding Distance on a Grid

Name:

Find the distance between points.

Ex)

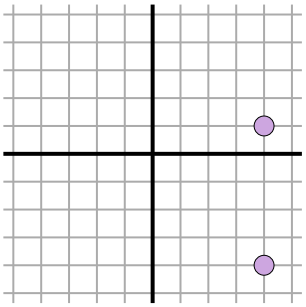

1)

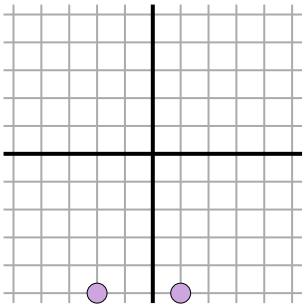

2)

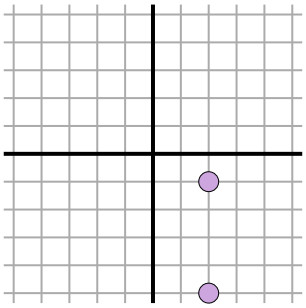

3)

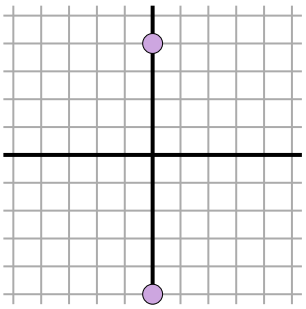

4)

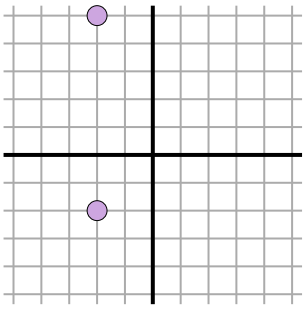

5)

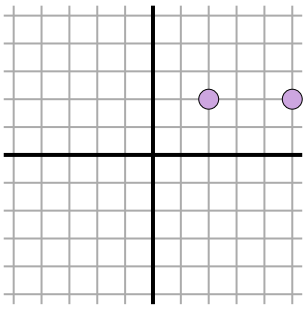

6)

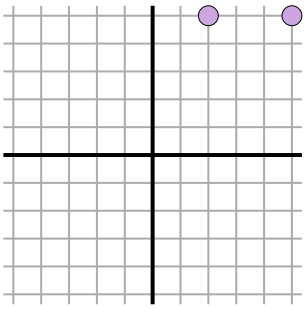

7)

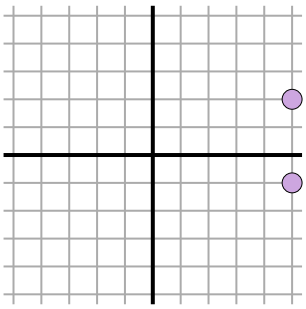

8)

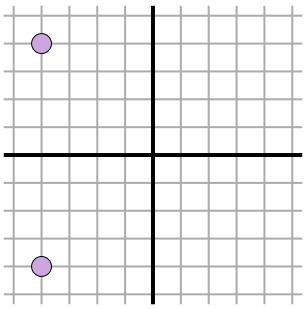

9)

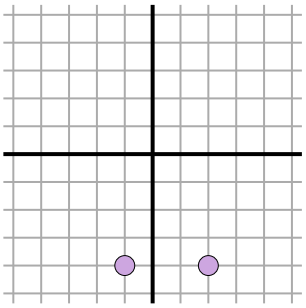

10)

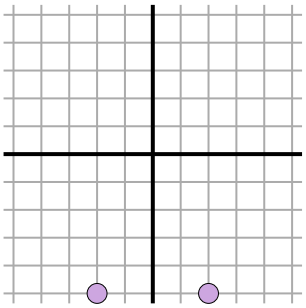

11)

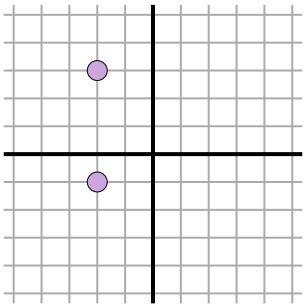

Answers

Ex. 5

1. _____

2. _____

3. _____

4. _____

5. _____

6. _____

7. _____

8. _____

9. _____

10. _____

11. _____

1-10	91	82	73	64	55	45	36	27	18	9
11	0									

Finding Distance on a Grid

Name: **Answer Key**

Find the distance between points.

Ex)

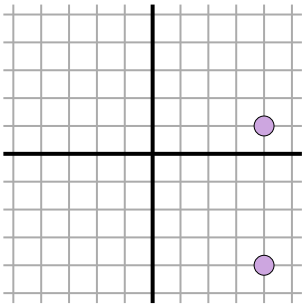

$\sqrt{(4-4)^2 + (1--4)^2}$

$\sqrt{(0) + (25)}$

1)

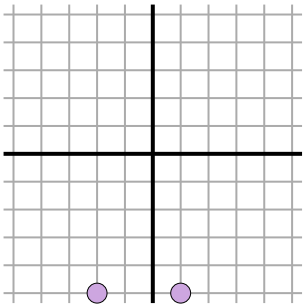

$\sqrt{(1--2)^2 + (-5--5)^2}$

$\sqrt{(9) + (0)}$

2)

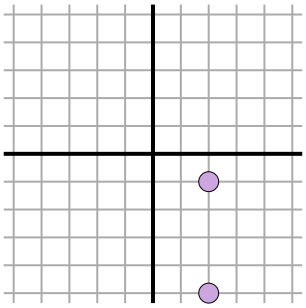

$\sqrt{(2-2)^2 + (-1--5)^2}$

$\sqrt{(0) + (16)}$

3)

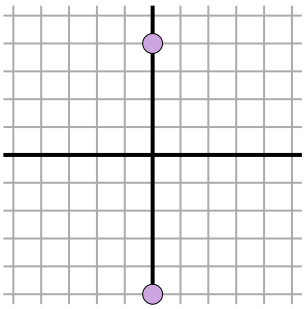

$\sqrt{(0-0)^2 + (-5-4)^2}$

$\sqrt{(0) + (81)}$

4)

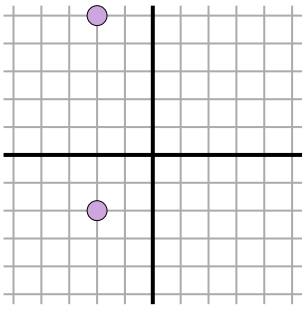

$\sqrt{(-2--2)^2 + (5--2)^2}$

$\sqrt{(0) + (49)}$

5)

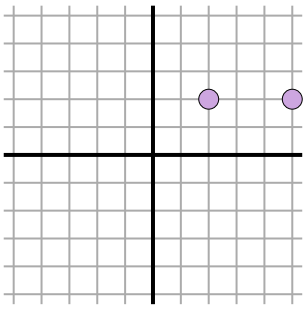

$\sqrt{(5-2)^2 + (2-2)^2}$

$\sqrt{(9) + (0)}$

6)

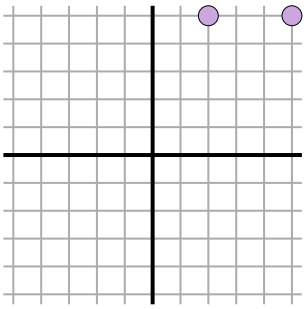

$\sqrt{(2-5)^2 + (5-5)^2}$

$\sqrt{(9) + (0)}$

7)

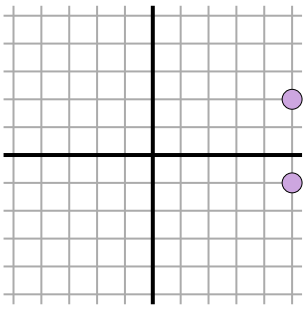

$\sqrt{(5-5)^2 + (2--1)^2}$

$\sqrt{(0) + (9)}$

8)

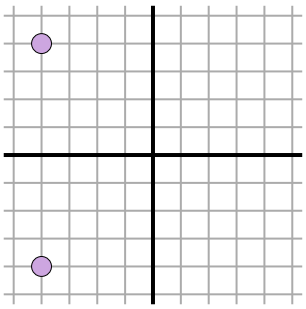

$\sqrt{(-4--4)^2 + (-4-4)^2}$

$\sqrt{(0) + (64)}$

9)

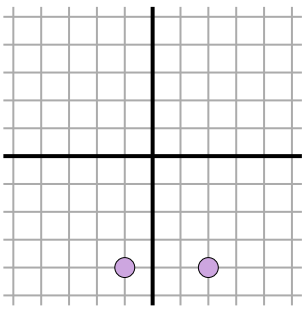

$\sqrt{(-1-2)^2 + (-4--4)^2}$

$\sqrt{(9) + (0)}$

10)

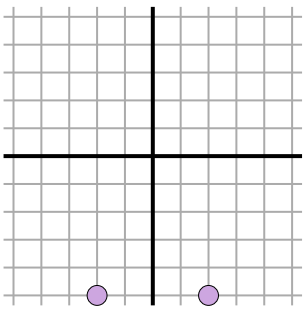

$\sqrt{(-2-2)^2 + (-5--5)^2}$

$\sqrt{(16) + (0)}$

11)

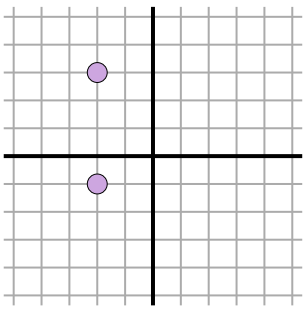

$\sqrt{(-2--2)^2 + (3--1)^2}$

$\sqrt{(0) + (16)}$

Answers

Ex.	5
1.	3
2.	4
3.	9
4.	7
5.	3
6.	3
7.	3
8.	8
9.	3
10.	4
11.	4

1-10	91	82	73	64	55	45	36	27	18	9
11	0									