Finding Distance on a Grid

Name:

**Find the distance between points. Round your answer to the nearest tenth.**

**Ex)**

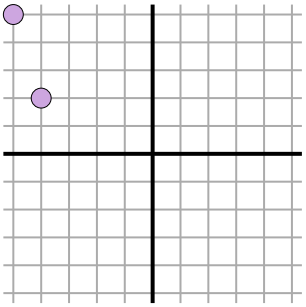

**1)**

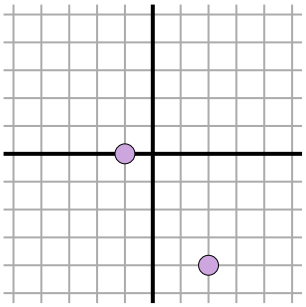

**2)**

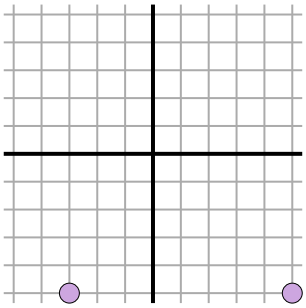

**3)**

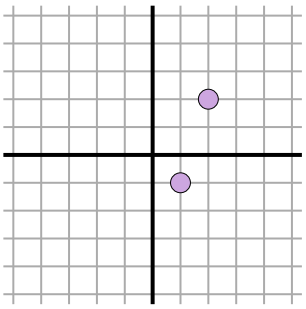

**4)**

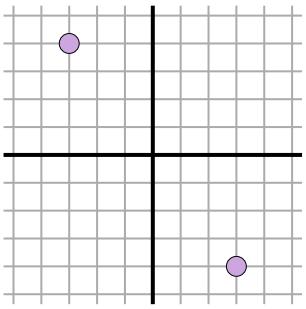

**5)**

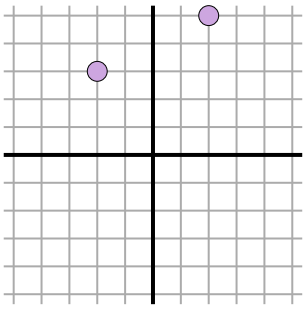

**6)**

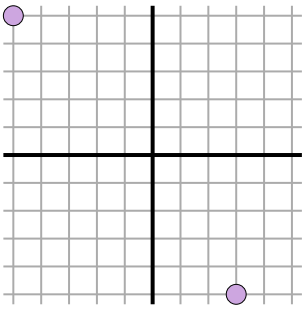

**7)**

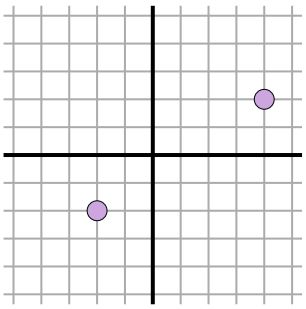

**8)**

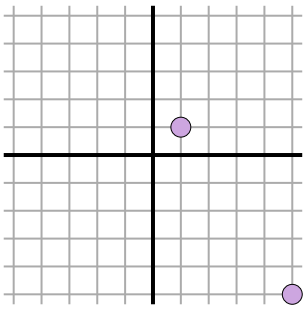

**9)**

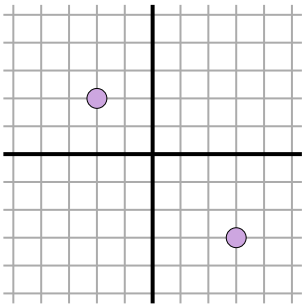

**10)**

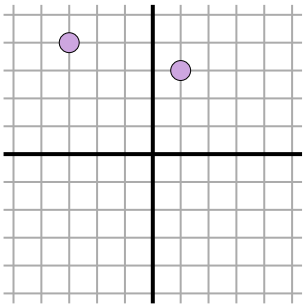

**11)**

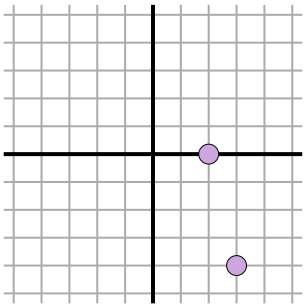

**Answers**

Ex. 3.2

1. _____
2. _____
3. _____
4. _____
5. _____
6. _____
7. _____
8. _____
9. _____
10. _____
11. _____



| | | | | | | | | | | |
|---|---|---|---|---|---|---|---|---|---|---|
| 1-10 | 91 | 82 | 73 | 64 | 55 | 45 | 36 | 27 | 18 | 9 |
| 11 | 0 | | | | | | | | | |

Finding Distance on a Grid

Name: **Answer Key**

**Find the distance between points. Round your answer to the nearest tenth.**

**Ex)**

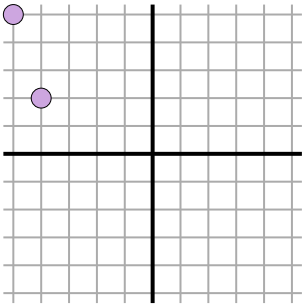

$\sqrt{(-5--4)^2 + (5-2)^2}$

$\sqrt{(1) + (9)}$

**1)**

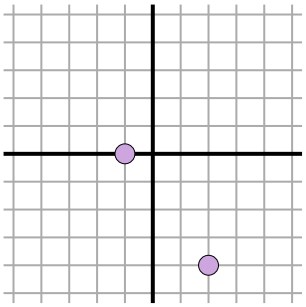

$\sqrt{(2--1)^2 + (-4-0)^2}$

$\sqrt{(9) + (16)}$

**2)**

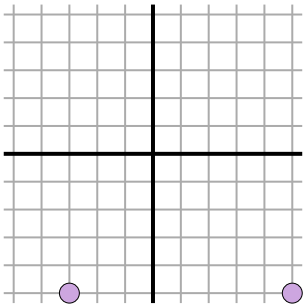

$\sqrt{(5--3)^2 + (-5--5)^2}$

$\sqrt{(64) + (0)}$

**3)**

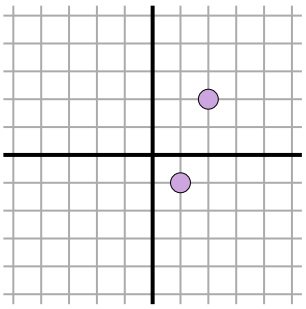

$\sqrt{(2-1)^2 + (2--1)^2}$

$\sqrt{(1) + (9)}$

**4)**

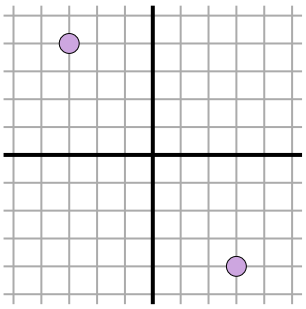

$\sqrt{(3--3)^2 + (-4-4)^2}$

$\sqrt{(36) + (64)}$

**5)**

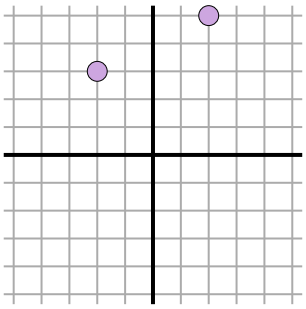

$\sqrt{(-2-2)^2 + (3-5)^2}$

$\sqrt{(16) + (4)}$

**6)**

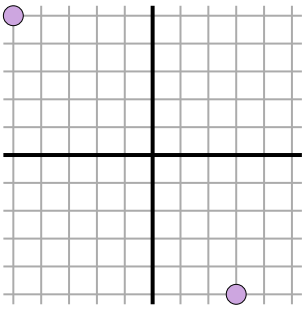

$\sqrt{(3--5)^2 + (-5-5)^2}$

$\sqrt{(64) + (100)}$

**7)**

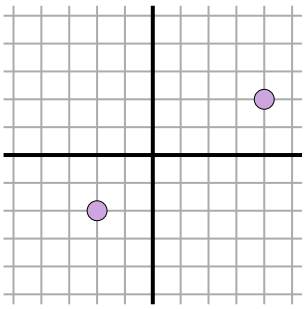

$\sqrt{(4--2)^2 + (2--2)^2}$

$\sqrt{(36) + (16)}$

**8)**

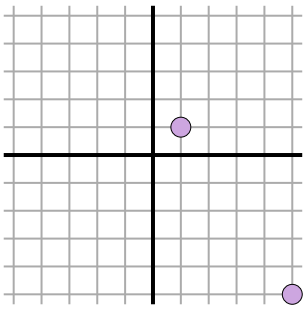

$\sqrt{(5-1)^2 + (-5-1)^2}$

$\sqrt{(16) + (36)}$

**9)**

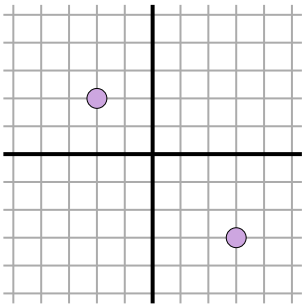

$\sqrt{(-2-3)^2 + (2--3)^2}$

$\sqrt{(25) + (25)}$

**10)**

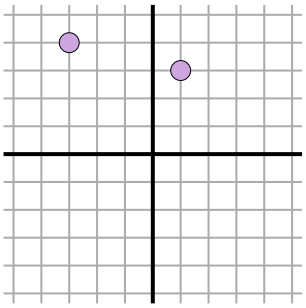

$\sqrt{(1--3)^2 + (3-4)^2}$

$\sqrt{(16) + (1)}$

**11)**

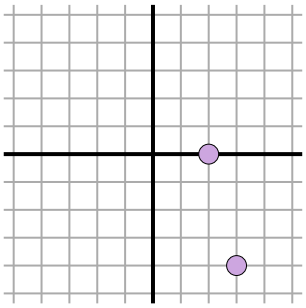

$\sqrt{(3-2)^2 + (-4-0)^2}$

$\sqrt{(1) + (16)}$

## Answers

| | |
|---|---|
| Ex. | 3.2 |
| 1. | 5 |
| 2. | 8 |
| 3. | 3.2 |
| 4. | 10 |
| 5. | 4.5 |
| 6. | 12.8 |
| 7. | 7.2 |
| 8. | 7.2 |
| 9. | 7.1 |
| 10. | 4.1 |
| 11. | 4.1 |



| | | | | | | | | | | |
|---|---|---|---|---|---|---|---|---|---|---|
| 1-10 | 91 | 82 | 73 | 64 | 55 | 45 | 36 | 27 | 18 | 9 |
| 11 | 0 | | | | | | | | | |