Determining Symmetry Name:

Determine if the line through each figure is a line of symmetry.

Ex)



1)

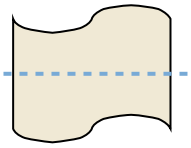

2)

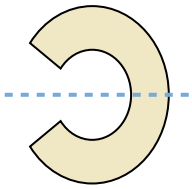

3)

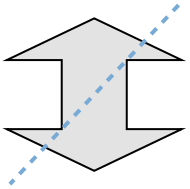

4)

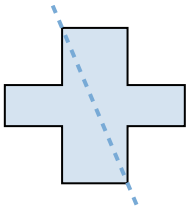

5)

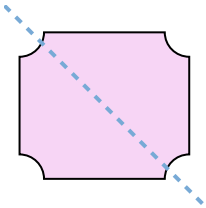

6)

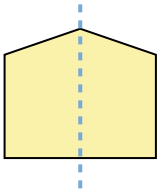

7)

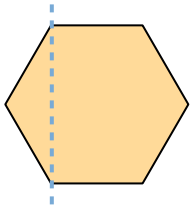

8)

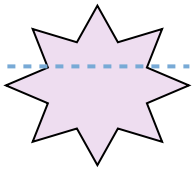

9)

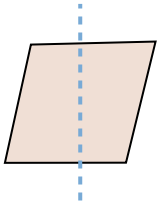

10)

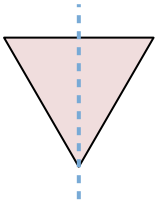

11)

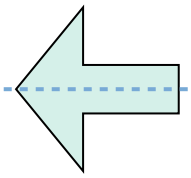

Answers

Ex. no

1. _____
2. _____
3. _____
4. _____
5. _____
6. _____
7. _____
8. _____
9. _____
10. _____
11. _____

1-10	91	82	73	64	55	45	36	27	18	9
11	0									

Determining Symmetry Name: **Answer Key**

Determine if the line through each figure is a line of symmetry.

Ex)

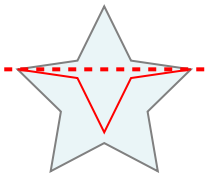

1)

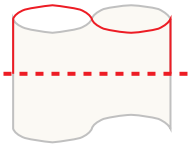

2)

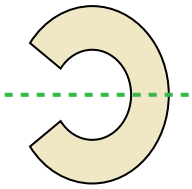

3)

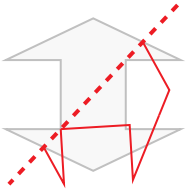

4)

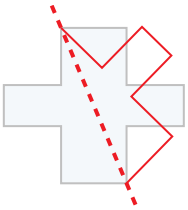

5)

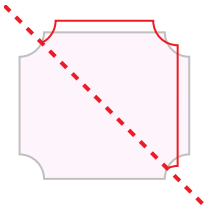

6)

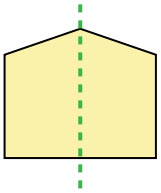

7)

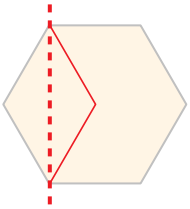

8)

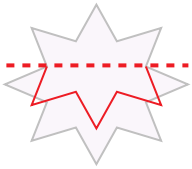

9)

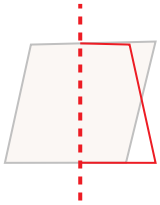

10)

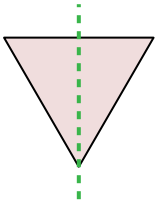

11)

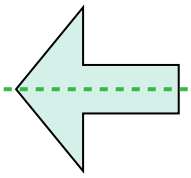

Answers

Ex.	no
1.	no
2.	yes
3.	no
4.	no
5.	no
6.	yes
7.	no
8.	no
9.	no
10.	yes
11.	yes

1-10	91	82	73	64	55	45	36	27	18	9
11	0									