# Rewriting Multiplication Problems (visual)

Name:

**Write each array as a multipication problem and solve.**

**Ex)**



**1)**



**2)**

**3)**



**4)**



**5)**

**6)**

**7)**



**8)**



**9)**



**10)**



**11)**

## Answers

Ex. 6 • 8 = 48

1. _____
2. _____
3. _____
4. _____
5. _____
6. _____
7. _____
8. _____
9. _____
10. _____
11. _____



| | | | | | | | | | | |
|---|---|---|---|---|---|---|---|---|---|---|
| 1-10 | 91 | 82 | 73 | 64 | 55 | 45 | 36 | 27 | 18 | 9 |
| 11 | 0 | | | | | | | | | |

Rewriting Multiplication Problems (visual) Name: **Answer Key**

**Write each array as a multipication problem and solve.**

**Ex)**



**1)**



**2)**

**3)**



**4)**



**5)**

**6)**

**7)**



**8)**



**9)**



**10)**



**11)**

## Answers

Ex. 6 • 8 = 48

1. 5 • 10 = 50
2. 2 • 10 = 20
3. 8 • 10 = 80
4. 5 • 5 = 25
5. 4 • 10 = 40
6. 7 • 3 = 21
7. 9 • 9 = 81
8. 10 • 6 = 60
9. 8 • 8 = 64
10. 9 • 7 = 63
11. 2 • 6 = 12



| | | | | | | | | | | |
|---|---|---|---|---|---|---|---|---|---|---|
| 1-10 | 91 | 82 | 73 | 64 | 55 | 45 | 36 | 27 | 18 | 9 |
| 11 | 0 | | | | | | | | | |