Rewriting Multiplication Problems (visual)

Name:

Write each array as a multipication problem and solve.

Ex) 

1) 

2)

3) 

4) 

5)

6)

7)

8)

9)

10)

11)

Answers

Ex. 4 × 4 = 16

1. _____
2. _____
3. _____
4. _____
5. _____
6. _____
7. _____
8. _____
9. _____
10. _____
11. _____

1-10	91	82	73	64	55	45	36	27	18	9
11	0									

Rewriting Multiplication Problems (visual)

Name: **Answer Key**

Write each array as a multipication problem and solve.

Ex) 

1) 

2)

3) 

4) 

5)

6)

7)

8)

9)

10)

11)

Answers

Ex. 4 × 4 = 16

1. 6 × 3 = 18
2. 9 × 3 = 27
3. 10 × 3 = 30
4. 10 × 6 = 60
5. 5 × 3 = 15
6. 7 × 2 = 14
7. 9 × 8 = 72
8. 4 × 8 = 32
9. 4 × 7 = 28
10. 2 × 3 = 6
11. 6 × 2 = 12

1-10	91	82	73	64	55	45	36	27	18	9
11	0									