Fraction, Decimal & Percent (Visual)

Name:

Determine the value written as a fraction , decimal & a percent.

Ex)



fraction $^{2}/_{100}$
decimal 0.02
percent 2%

1)

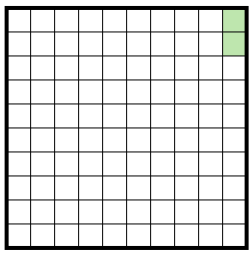

fraction _____
decimal _____
percent _____

2)

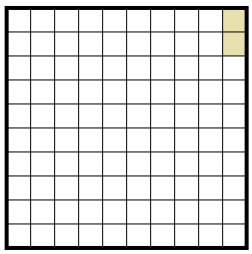

fraction _____
decimal _____
percent _____

3)



fraction _____
decimal _____
percent _____

4)

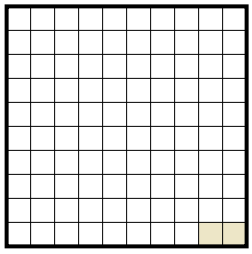

fraction _____
decimal _____
percent _____

5)

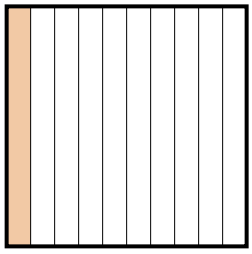

fraction _____
decimal _____
percent _____

6)

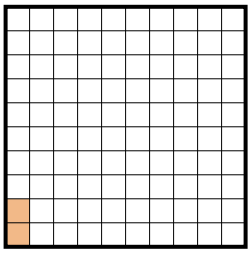

fraction _____
decimal _____
percent _____

7)

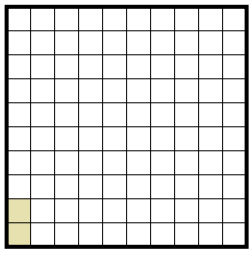

fraction _____
decimal _____
percent _____

8)

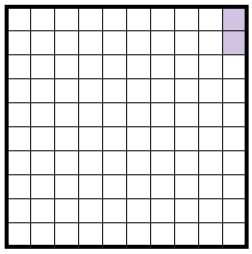

fraction _____
decimal _____
percent _____

9)

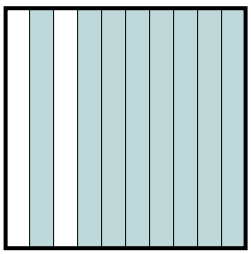

fraction _____
decimal _____
percent _____

10)

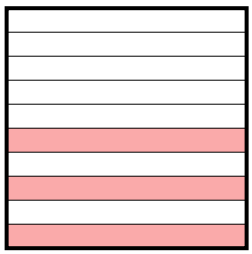

fraction _____
decimal _____
percent _____

11)

fraction _____
decimal _____
percent _____

Answers

Ex.	$^{2}/_{100}$	0.02	2%
1.			
2.			
3.			
4.			
5.			
6.			
7.			
8.			
9.			
10.			
11.			

Name: **Answer Key**

Determine the value written as a fraction , decimal & a percent.

Ex)



fraction $^{2}/_{100}$
decimal 0.02
percent 2%

1)

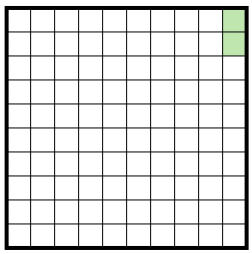

fraction $^{2}/_{100}$
decimal 0.02
percent 2%

2)

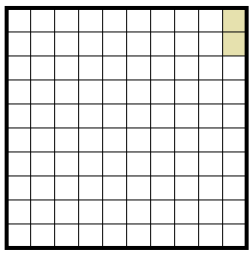

fraction $^{2}/_{100}$
decimal 0.02
percent 2%

3)



fraction $^{7}/_{10}$
decimal 0.7
percent 70%

4)

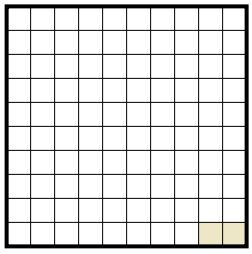

fraction $^{2}/_{100}$
decimal 0.02
percent 2%

5)

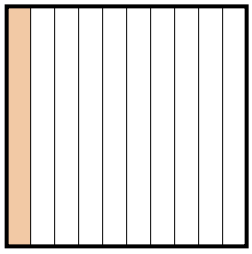

fraction $^{1}/_{10}$
decimal 0.1
percent 10%

6)

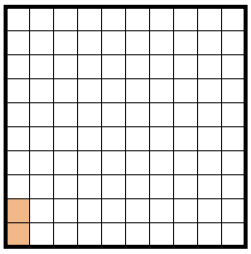

fraction $^{2}/_{100}$
decimal 0.02
percent 2%

7)

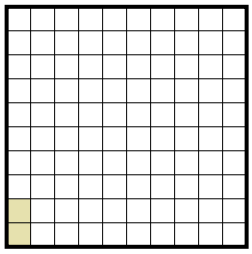

fraction $^{2}/_{100}$
decimal 0.02
percent 2%

8)

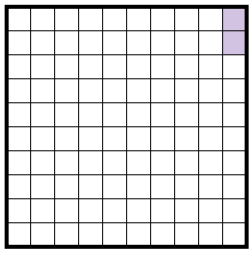

fraction $^{2}/_{100}$
decimal 0.02
percent 2%

9)

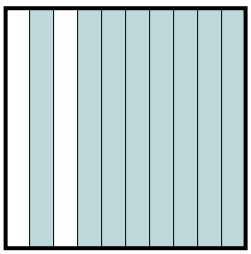

fraction $^{8}/_{10}$
decimal 0.8
percent 80%

10)

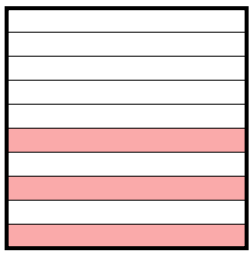

fraction $^{3}/_{10}$
decimal 0.3
percent 30%

11)

fraction $^{4}/_{10}$
decimal 0.4
percent 40%

Answers

Ex.	$^{2}/_{100}$	0.02	2%
1.	$^{2}/_{100}$	0.02	2%
2.	$^{2}/_{100}$	0.02	2%
3.	$^{7}/_{10}$	0.7	70%
4.	$^{2}/_{100}$	0.02	2%
5.	$^{1}/_{10}$	0.1	10%
6.	$^{2}/_{100}$	0.02	2%
7.	$^{2}/_{100}$	0.02	2%
8.	$^{2}/_{100}$	0.02	2%
9.	$^{8}/_{10}$	0.8	80%
10.	$^{3}/_{10}$	0.3	30%
11.	$^{4}/_{10}$	0.4	40%