Dividing with a Numberline

Name:d

Use the numberline to solve each problem.

1) 9÷3=

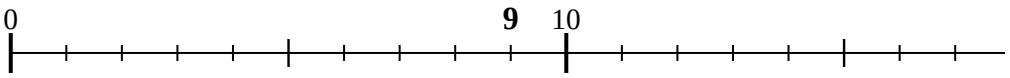

2) 20÷4=

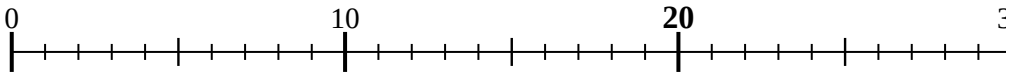

3) 50÷10=

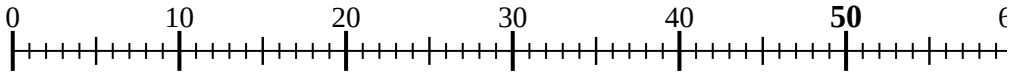

4) 30÷10=

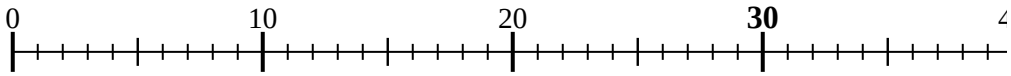

5) 20÷10=

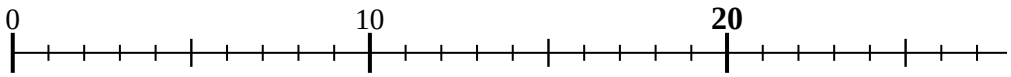

6) 21÷7=

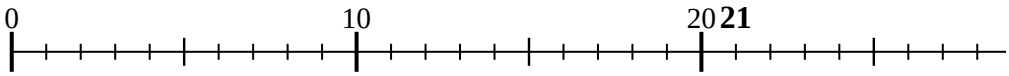

7) 27÷9=

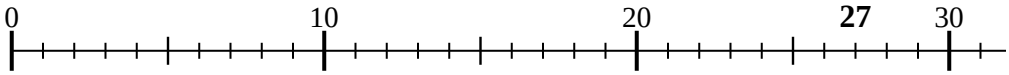

8) 8÷4=

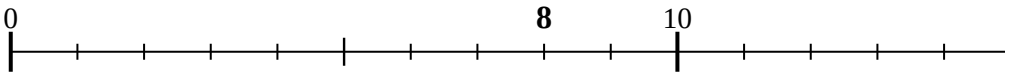

9) 40÷8=

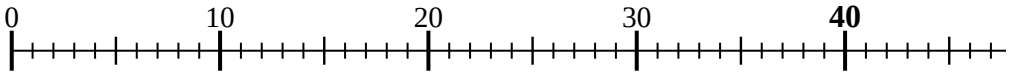

10) 32÷8=

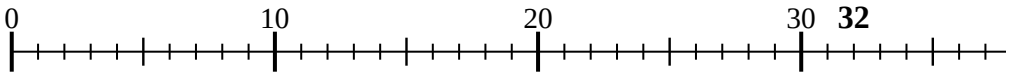

11) 14÷7=

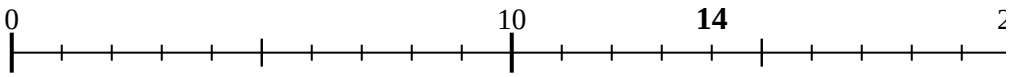

Answers

1. _____
2. _____
3. _____
4. _____
5. _____
6. _____
7. _____
8. _____
9. _____
10. _____
11. _____

1-10	91	82	73	64	55	45	36	27	18	9
11	0									

Dividing with a Numberline

Name: **Answer Key**

Use the numberline to solve each problem.

1) 9÷3=

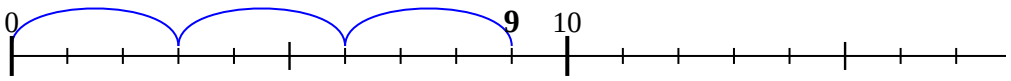

2) 20÷4=

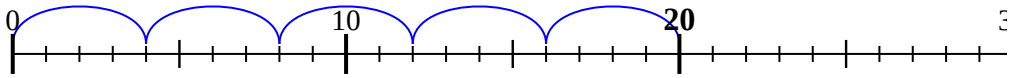

3) 50÷10=

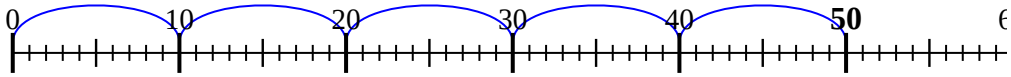

4) 30÷10=

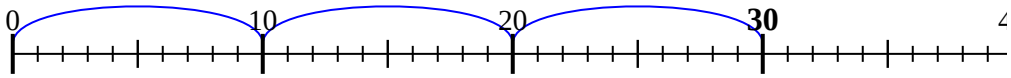

5) 20÷10=

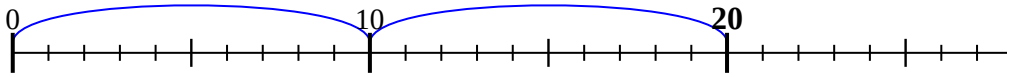

6) 21÷7=

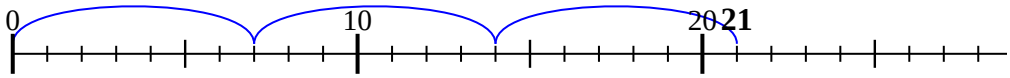

7) 27÷9=

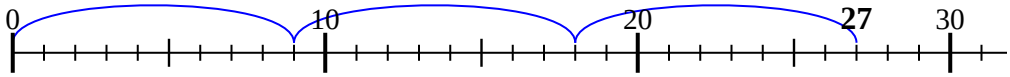

8) 8÷4=

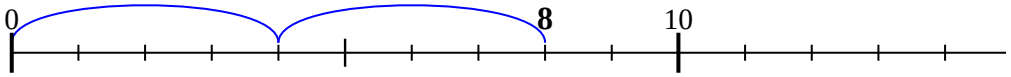

9) 40÷8=

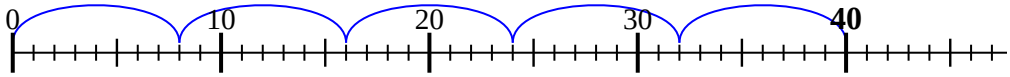

10) 32÷8=

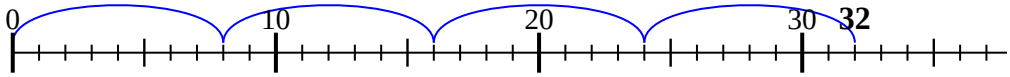

11) 14÷7=

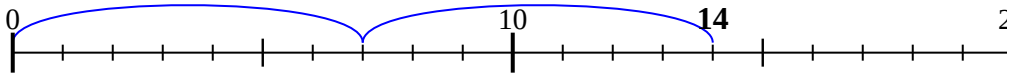

Answers

1. 3
2. 5
3. 5
4. 3
5. 2
6. 3
7. 3
8. 2
9. 5
10. 4
11. 2

1-10	91	82	73	64	55	45	36	27	18	9
11	0									