# Dividing with a Numberline

Name:

**Use the numberline to solve each problem.**

**1)** 15 ÷ 3 =

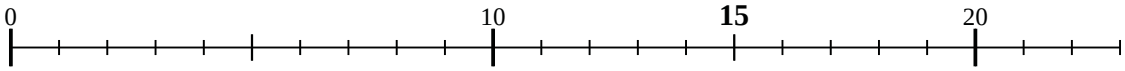


**2)** 24 ÷ 6 =

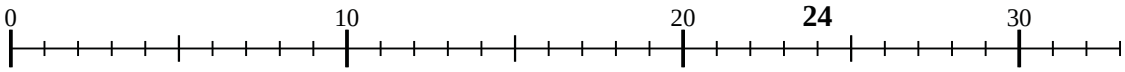


**3)** 21 ÷ 7 =

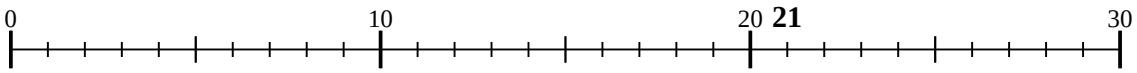


**4)** 20 ÷ 10 =

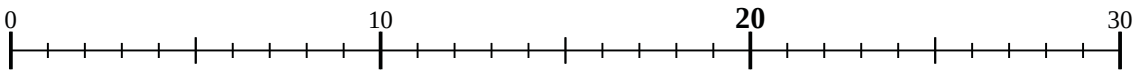


**5)** 25 ÷ 5 =

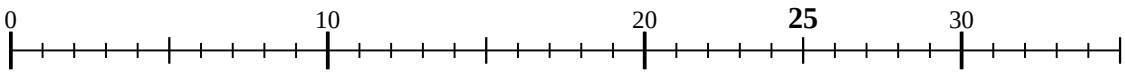


**6)** 18 ÷ 6 =

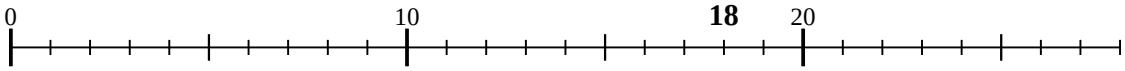


**7)** 40 ÷ 10 =

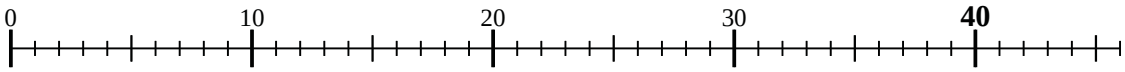


**8)** 12 ÷ 4 =

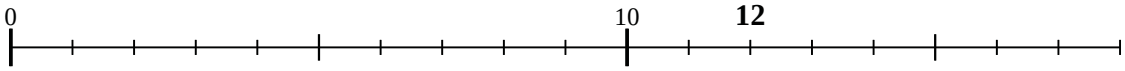


**9)** 8 ÷ 2 =

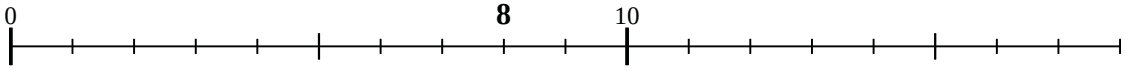


**10)** 40 ÷ 8 =

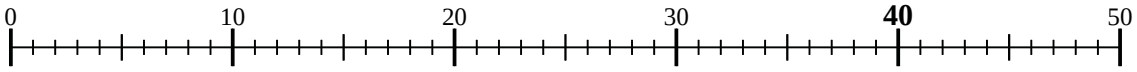


**11)** 8 ÷ 4 =

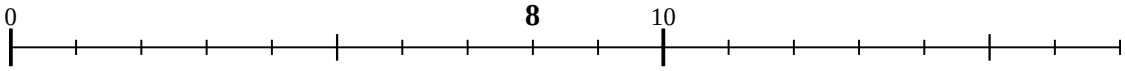


## Answers

1. _____
2. _____
3. _____
4. _____
5. _____
6. _____
7. _____
8. _____
9. _____
10. _____
11. _____



| | | | | | | | | | | |
|---|---|---|---|---|---|---|---|---|---|---|
| 1-10 | 91 | 82 | 73 | 64 | 55 | 45 | 36 | 27 | 18 | 9 |
| 11 | 0 | | | | | | | | | |

Dividing with a Numberline

Name: **Answer Key**

**Use the numberline to solve each problem.**

**1)** 15 ÷ 3 =

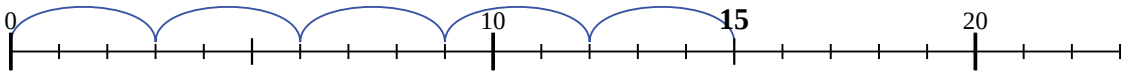


**2)** 24 ÷ 6 =

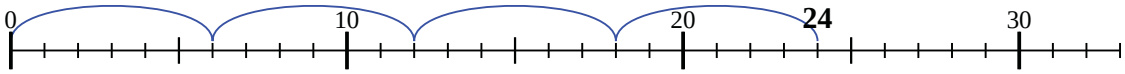


**3)** 21 ÷ 7 =

**4)** 20 ÷ 10 =

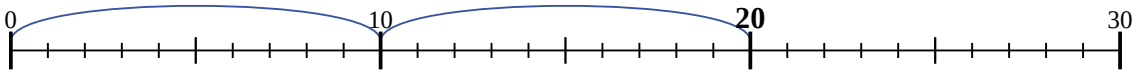


**5)** 25 ÷ 5 =

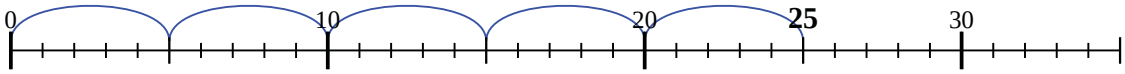


**6)** 18 ÷ 6 =

**7)** 40 ÷ 10 =

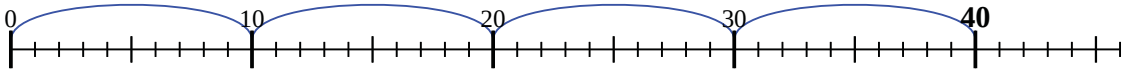


**8)** 12 ÷ 4 =

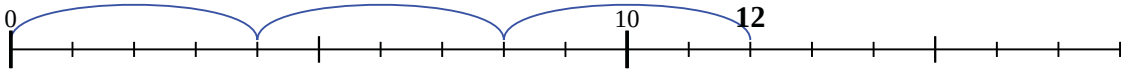


**9)** 8 ÷ 2 =

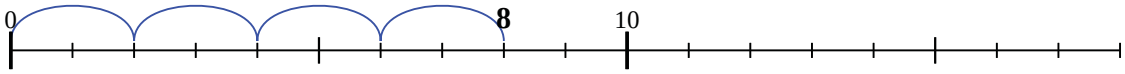


**10)** 40 ÷ 8 =

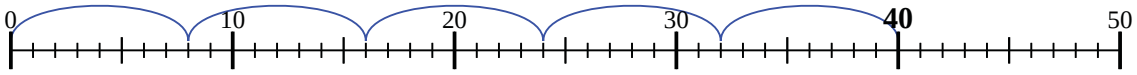


**11)** 8 ÷ 4 =

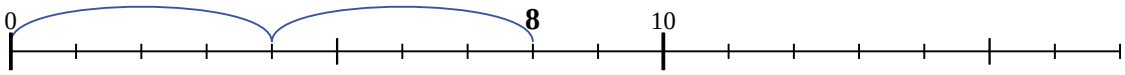


## Answers

1. 5
2. 4
3. 3
4. 2
5. 5
6. 3
7. 4
8. 3
9. 4
10. 5
11. 2



| | | | | | | | | | | |
|---|---|---|---|---|---|---|---|---|---|---|
| 1-10 | 91 | 82 | 73 | 64 | 55 | 45 | 36 | 27 | 18 | 9 |
| 11 | 0 | | | | | | | | | |