Dividing with a Numberline

Name:

Use the numberline to solve each problem.

1) 4 ÷ 2 =



2) 18 ÷ 6 =

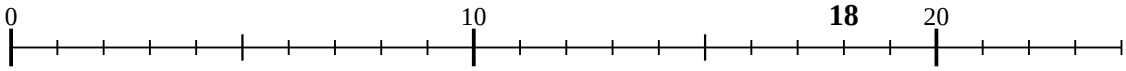

3) 6 ÷ 3 =



4) 8 ÷ 2 =

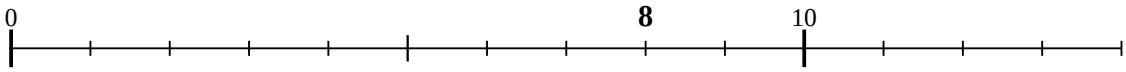

5) 16 ÷ 8 =

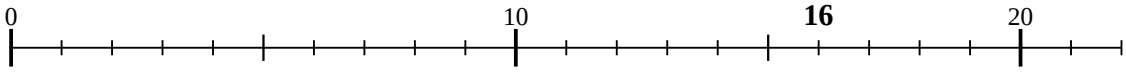

6) 12 ÷ 3 =

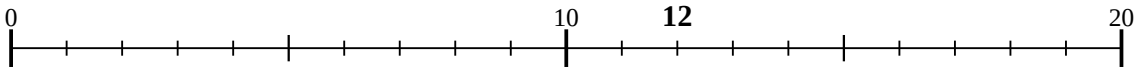

7) 18 ÷ 9 =

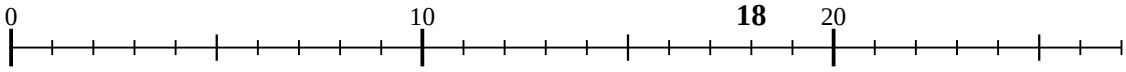

8) 50 ÷ 10 =

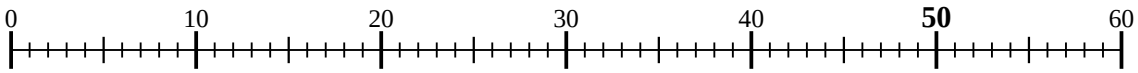

9) 28 ÷ 7 =

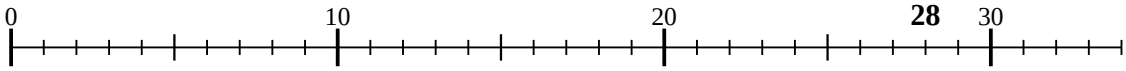

10) 10 ÷ 2 =

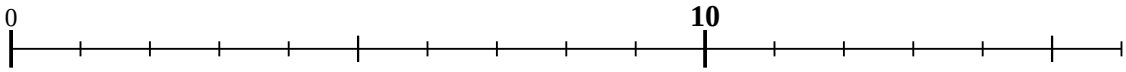

11) 32 ÷ 8 =

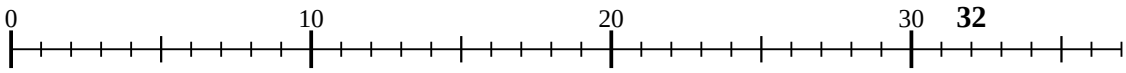

Answers

1. _____
2. _____
3. _____
4. _____
5. _____
6. _____
7. _____
8. _____
9. _____
10. _____
11. _____

1-10	91	82	73	64	55	45	36	27	18	9
11	0									

Dividing with a Numberline

Name: **Answer Key**

Use the numberline to solve each problem.

1) 4 ÷ 2 =



2) 18 ÷ 6 =

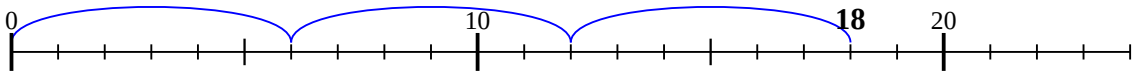

3) 6 ÷ 3 =

4) 8 ÷ 2 =

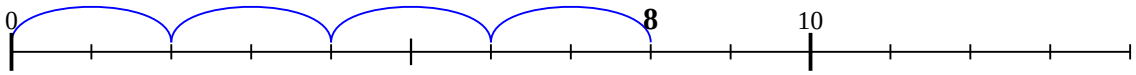

5) 16 ÷ 8 =

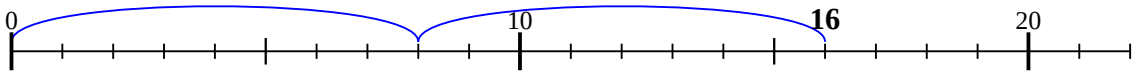

6) 12 ÷ 3 =

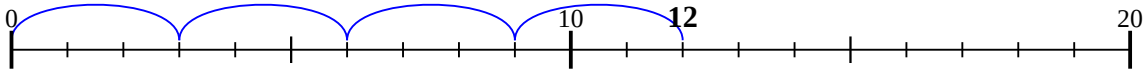

7) 18 ÷ 9 =

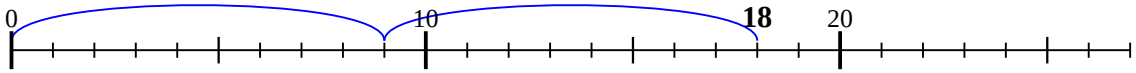

8) 50 ÷ 10 =

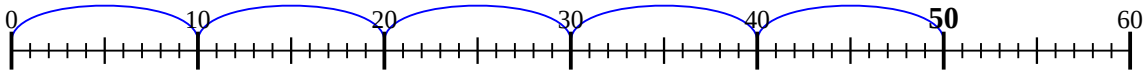

9) 28 ÷ 7 =

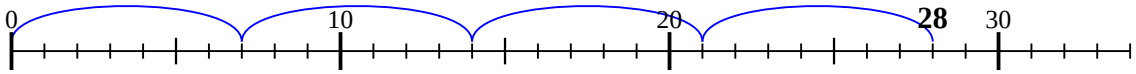

10) 10 ÷ 2 =

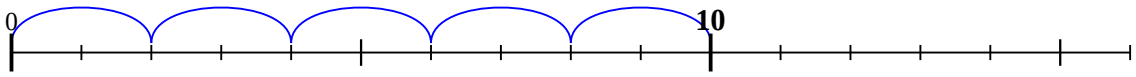

11) 32 ÷ 8 =

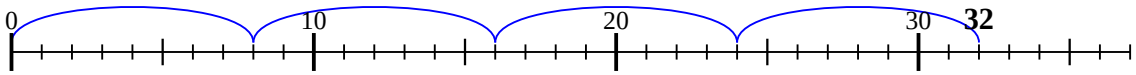

Answers

1. **2**
2. **3**
3. **2**
4. **4**
5. **2**
6. **4**
7. **2**
8. **5**
9. **4**
10. **5**
11. **4**

1-10	91	82	73	64	55	45	36	27	18	9
11	0									