Function Machines (Add & Subtract) Name:

**Determine the rule each function machine is using.**

**Ex)**

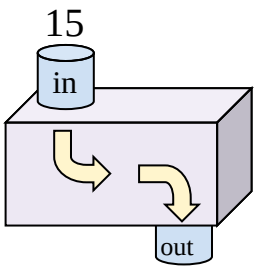


Add 11

**1)**

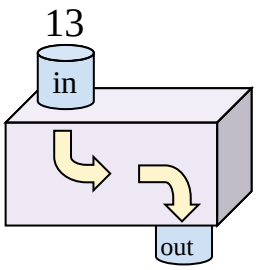


**2)**

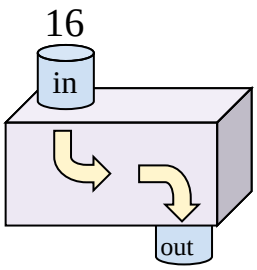


**3)**

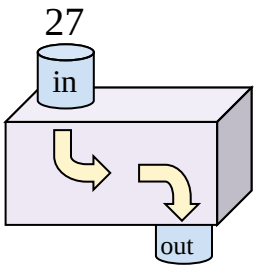


**4)**

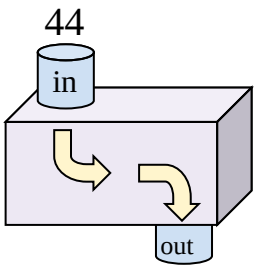


**5)**

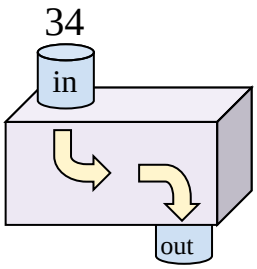


**6)**

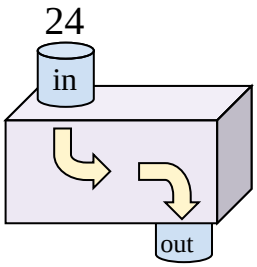


**7)**

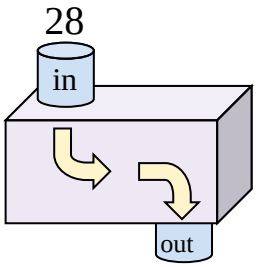


**8)**

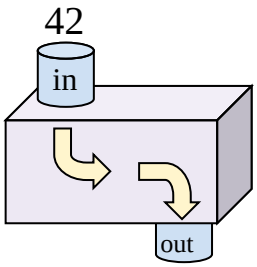


**9)**

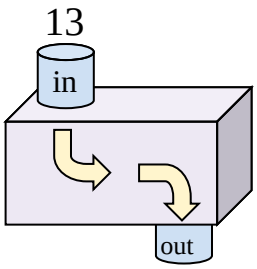


**10)**

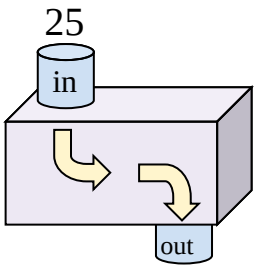


**11)**

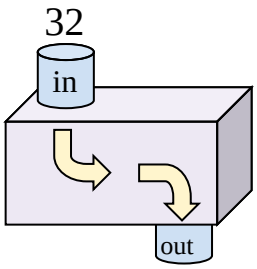


## Answers

Ex. Add 11

1. _____
2. _____
3. _____
4. _____
5. _____
6. _____
7. _____
8. _____
9. _____
10. _____
11. _____

Function Machines (Add & Subtract) Name: **Answer Key**

**Determine the rule each function machine is using.**

**Ex)**

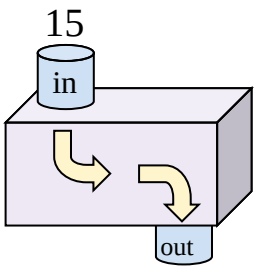


Add 11

**1)**

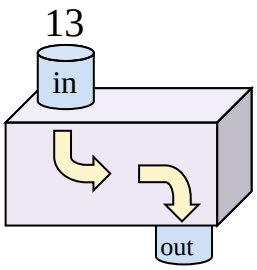


Add 17

**2)**

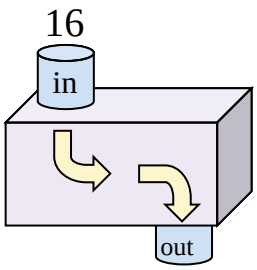


Add 17

**3)**

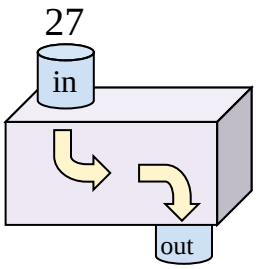


Subtract 11

**4)**

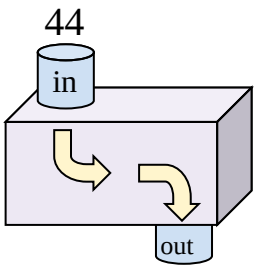


Subtract 23

**5)**

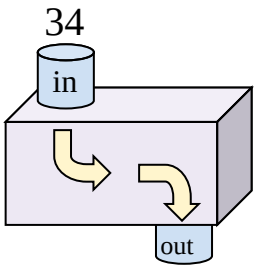


Subtract 5

**6)**

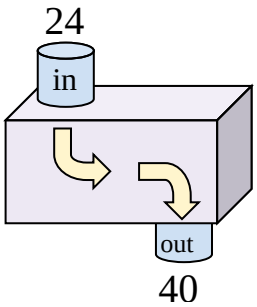


Add 16

**7)**

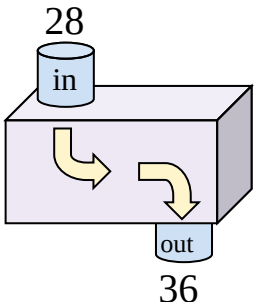


Add 8

**8)**

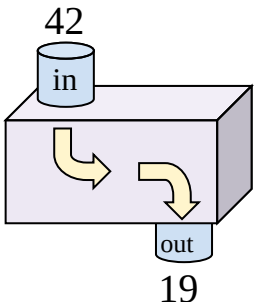


Subtract 23

**9)**

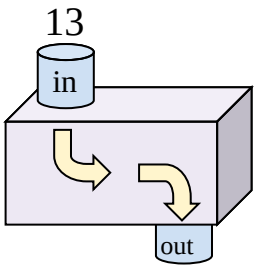


Subtract 6

**10)**

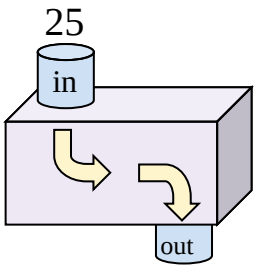


Add 16

**11)**

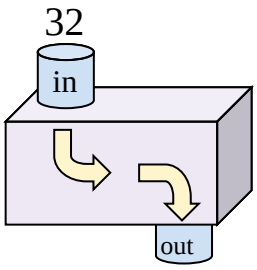


Subtract 25

## Answers

| | |
|---|---|
| Ex. | Add 11 |
| 1. | Add 17 |
| 2. | Add 17 |
| 3. | Subtract 11 |
| 4. | Subtract 23 |
| 5. | Subtract 5 |
| 6. | Add 16 |
| 7. | Add 8 |
| 8. | Subtract 23 |
| 9. | Subtract 6 |
| 10. | Add 16 |
| 11. | Subtract 25 |