Function Machines (Add & Subtract) Name:

Determine the rule each function machine is using.

Ex)

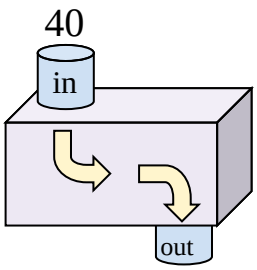

Subtract 28

1)

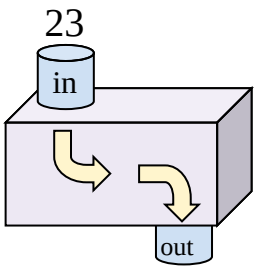

2)

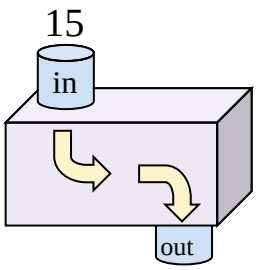

3)

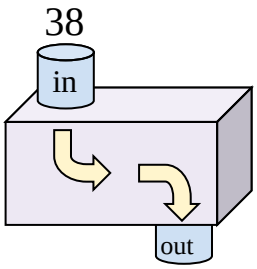

4)

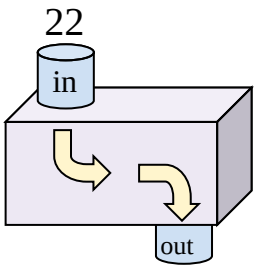

5)

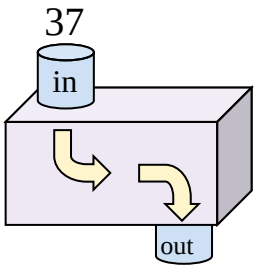

6)

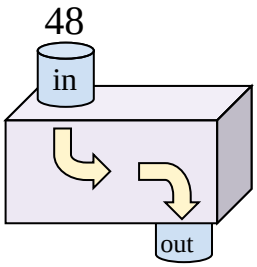

7)

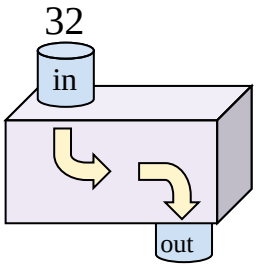

8)

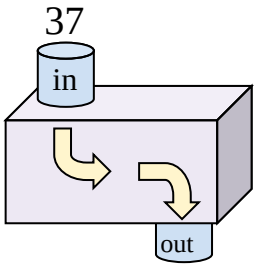

9)

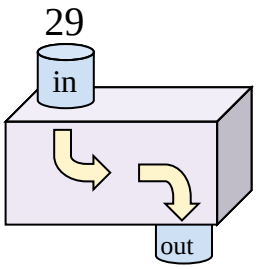

10)

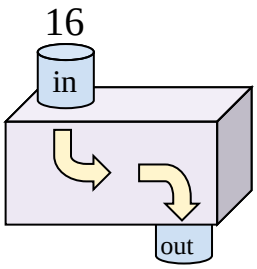

11)

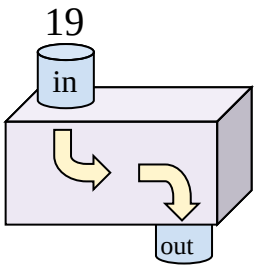

Answers

Ex. Subtract 28

1. _____
2. _____
3. _____
4. _____
5. _____
6. _____
7. _____
8. _____
9. _____
10. _____
11. _____

Function Machines (Add & Subtract) Name: **Answer Key**

Determine the rule each function machine is using.

Ex)

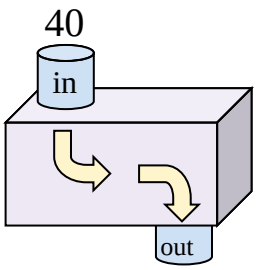

Subtract 28

1)

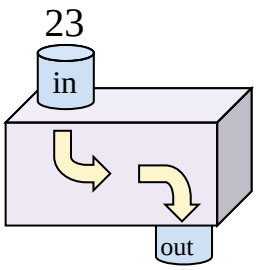

Add 22

2)

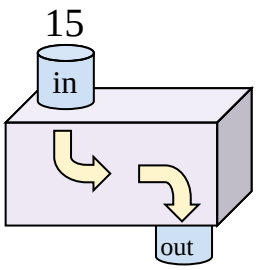

Add 13

3)

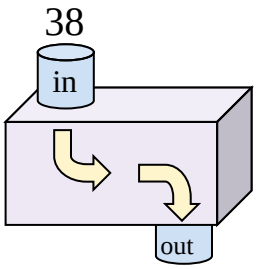

Subtract 8

4)

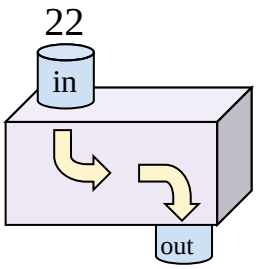

Subtract 9

5)

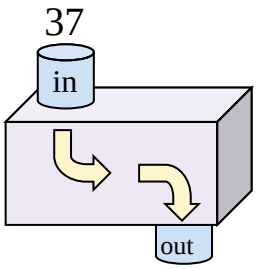

Subtract 13

6)

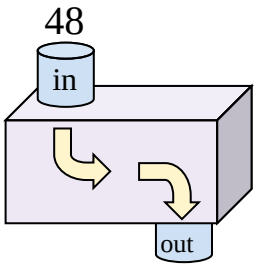

Subtract 37

7)

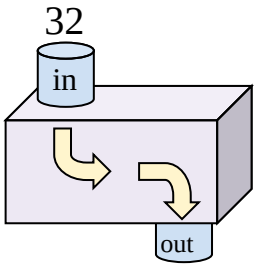

Subtract 7

8)

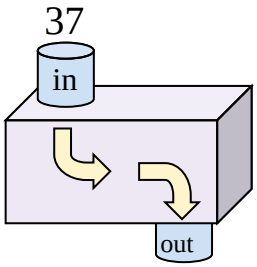

Subtract 18

9)

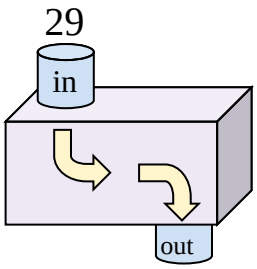

Add 19

10)

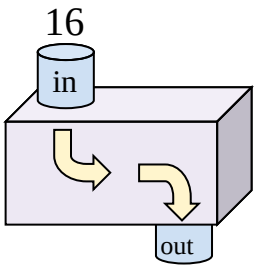

Add 26

11)

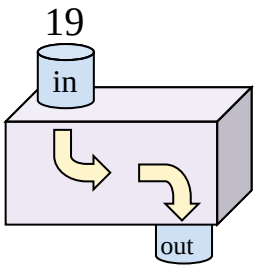

Add 26

Answers

Ex.	Subtract 28
1.	Add 22
2.	Add 13
3.	Subtract 8
4.	Subtract 9
5.	Subtract 13
6.	Subtract 37
7.	Subtract 7
8.	Subtract 18
9.	Add 19
10.	Add 26
11.	Add 26