Rewriting Multiplication Problems (visual)

Name:

Write each array as a multiplication problem and solve.

Ex)

1)

2)

3)



4)



5)



6)

7)

8)



9)

10)



11)



Answers

Ex. 3 × 5 = 15

1. _____
2. _____
3. _____
4. _____
5. _____
6. _____
7. _____
8. _____
9. _____
10. _____
11. _____

Rewriting Multiplication Problems (visual) Name: **Answer Key**

Write each array as a multiplication problem and solve.

Ex)

1)

2)

3)



4)



5)



6)

7)

8)



9)

10)



11)



Answers

Ex. 3 × 5 = 15

1. 10 × 2 = 20

2. 4 × 8 = 32

3. 8 × 6 = 48

4. 10 × 10 = 100

5. 7 × 3 = 21

6. 4 × 7 = 28

7. 9 × 3 = 27

8. 10 × 9 = 90

9. 2 × 2 = 4

10. 7 × 10 = 70

11. 3 × 6 = 18