Visual Division

Name:

Use the shapes provided to answer the questions.

Ex) How many groups of 6 can you make with the 18 shapes below?

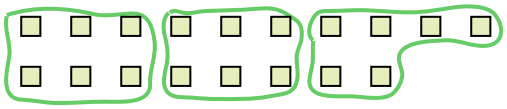

1) How many groups of 3 can you make with the 30 shapes below?



2) How many groups of 4 can you make with the 28 shapes below?



3) How many groups of 2 can you make with the 40 shapes below?



4) How many groups of 4 can you make with the 32 shapes below?

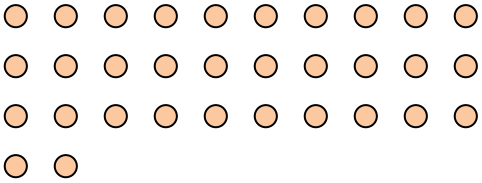

5) How many groups of 9 can you make with the 27 shapes below?

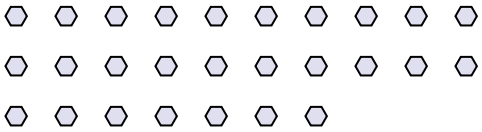

6) How many groups of 6 can you make with the 36 shapes below?

7) How many groups of 3 can you make with the 36 shapes below?



8) How many groups of 6 can you make with the 36 shapes below?



9) How many groups of 4 can you make with the 36 shapes below?

10) How many groups of 2 can you make with the 38 shapes below?



11) How many groups of 7 can you make with the 14 shapes below?

Answers

Ex. 3

1. _____
2. _____
3. _____
4. _____
5. _____
6. _____
7. _____
8. _____
9. _____
10. _____
11. _____

1-10	91	82	73	64	55	45	36	27	18	9
11	0									

Visual Division

Name: **Answer Key**

Use the shapes provided to answer the questions.

Ex) How many groups of 6 can you make with the 18 shapes below?

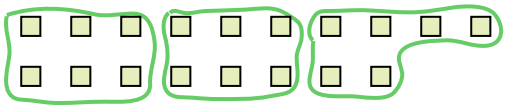

1) How many groups of 3 can you make with the 30 shapes below?



2) How many groups of 4 can you make with the 28 shapes below?



3) How many groups of 2 can you make with the 40 shapes below?



4) How many groups of 4 can you make with the 32 shapes below?

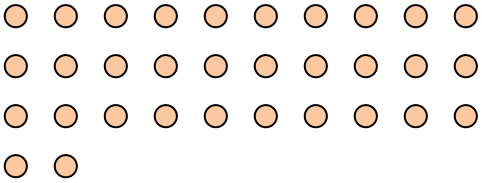

5) How many groups of 9 can you make with the 27 shapes below?

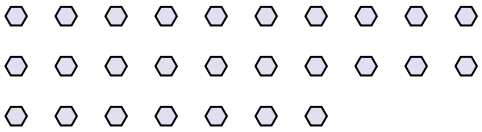

6) How many groups of 6 can you make with the 36 shapes below?

7) How many groups of 3 can you make with the 36 shapes below?



8) How many groups of 6 can you make with the 36 shapes below?



9) How many groups of 4 can you make with the 36 shapes below?

10) How many groups of 2 can you make with the 38 shapes below?



11) How many groups of 7 can you make with the 14 shapes below?

Answers

Ex.	3
1.	10
2.	7
3.	20
4.	8
5.	3
6.	6
7.	12
8.	6
9.	9
10.	19
11.	2

1-10	91	82	73	64	55	45	36	27	18	9
11	0									