Completing and Matching Volume Equations

Name:

Match each problem with the equation that could represent it. Answer with the missing term and letter.

Ex) 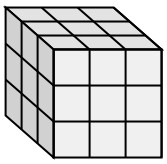

1) 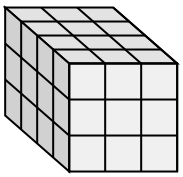

2) 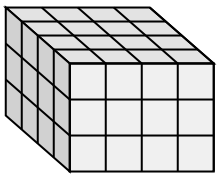

3) 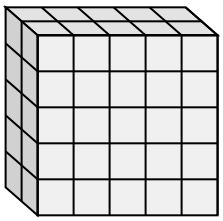

4) 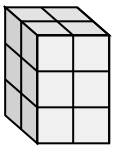

5) 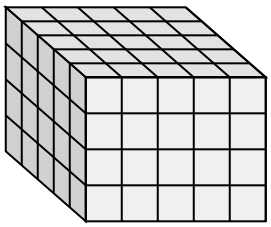

6) 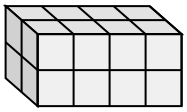

7) 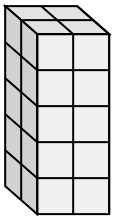

8) 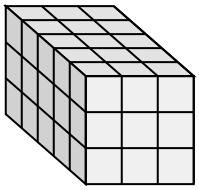

9) 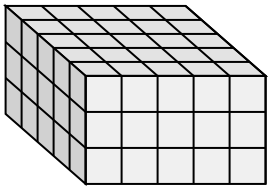

10) 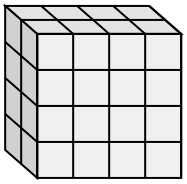

11) 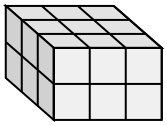

A. 5 × 5 × ___ = 75

B. 2 × 4 × ___ = 16

C. ___ × 3 × 3 = 36

D. 5 × 5 × 4 = ___

E. ___ × 5 × 5 = 50

F. ___ × 2 × 5 = 20

G. ___ × 3 × 3 = 27

H. 5 × 3 × 3 = ___

I. 3 × ___ × 2 = 18

J. 2 × 2 × ___ = 12

K. ___ × 4 × 4 = 32

L. 4 × ___ × 3 = 48

Answers

Ex. G , 3

1. _____
2. _____
3. _____
4. _____
5. _____
6. _____
7. _____
8. _____
9. _____
10. _____
11. _____

Completing and Matching Volume Equations Name: **Answer Key**

Match each problem with the equation that could represent it. Answer with the missing term and letter.

Ex) 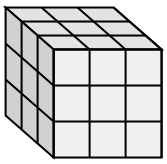

1) 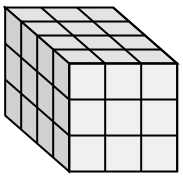

2) 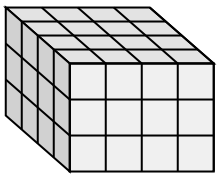

3) 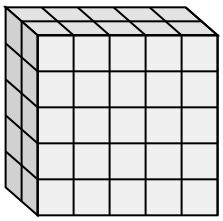

4) 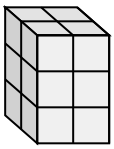

5) 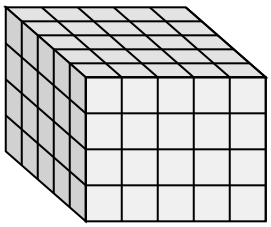

6) 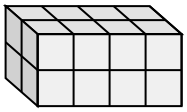

7) 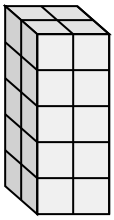

8) 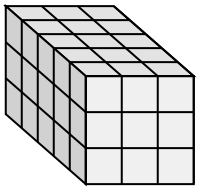

9) 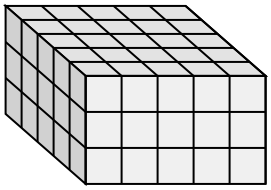

10) 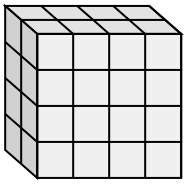

11) 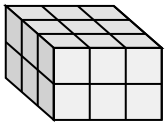

A. 5 × 5 × ___ = 75

B. 2 × 4 × ___ = 16

C. ___ × 3 × 3 = 36

D. 5 × 5 × 4 = ___

E. ___ × 5 × 5 = 50

F. ___ × 2 × 5 = 20

G. ___ × 3 × 3 = 27

H. 5 × 3 × 3 = ___

I. 3 × ___ × 2 = 18

J. 2 × 2 × ___ = 12

K. ___ × 4 × 4 = 32

L. 4 × ___ × 3 = 48

Answers

Ex.	G , 3
1.	C , 4
2.	L , 4
3.	E , 2
4.	J , 3
5.	D , 100
6.	B , 2
7.	F , 2
8.	H , 45
9.	A , 3
10.	K , 2
11.	I , 3

1-10	91	82	73	64	55	45	36	27	18	9
11	0									